Dices
ದಾಳದಳು

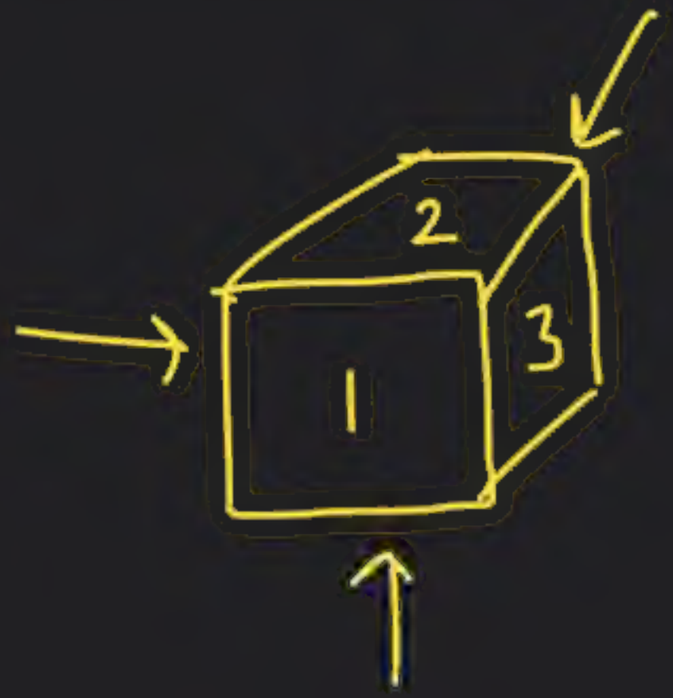

6 [illegible]

1, 2, 3, 4, 5, 6

[illegible] ?

a) 2 b) 3 c) 2 6 in 3 d) 6

* 2 ಕೆಳ

ಸಮಾನ

1 ಕ 6 ಭಾಗದ ಮೊತ್ತ

a) 4 b) 5 c) 6 d) ~~ಸಮಾನ~~ ಮೊತ್ತ

* 2 ת.ר

[illegible]

1 ס [illegible] [illegible]?

a) 4 b) 5 c) 2 d) 6



ದಾಳಗಳು

❖ಒಂದು ದಾಳದಲ್ಲಿ 6 ಮುಖಗಳು ಇರುತ್ತವೆ.

IGacademy Download App in PlayStore | SUBSCRIBE IshwarGiri ಪಾಠಶಾಲೆ | 8660070677

❖ ಒಂದು ಸಂಖ್ಯೆಯ ವಿರುದ್ಧ ಮುಖದಲ್ಲಿರುವ ಸಂಖ್ಯೆಯನ್ನು ಅಭಿಮುಖ ಸಂಖ್ಯೆ ಎಂದು ಕರೆಯುತ್ತೇವೆ.
(ಸಂಖ್ಯೆ/ಚಿನ್ಹೆ/ಬಣ್ಣ)

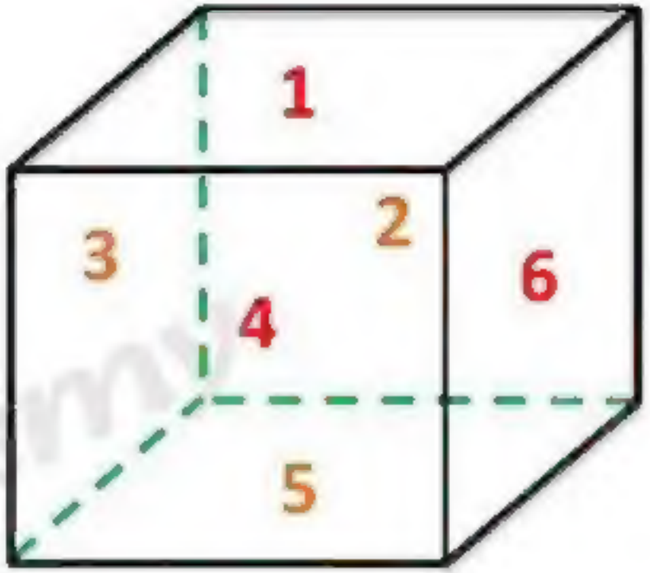

1 — 5

3 — 6

4 — 2

● ಕಾಣುವ ಮುಖಗಳು

● ಕಾಣದ ಮುಖಗಳು

IGacademy Download App in PlayStore | SUBSCRIBE IshwarGiri ಪಾಠಶಾಲೆ | 8660070677

- ನಮಗೆ ಕಾಣುವ ಮೂರು ಮುಖಗಳ ಅಭಿಮುಖಗಳು ಎಂದಿಗೂ ಜೊತೆಗೆ ಕಾಣಿಸುವುದಿಲ್ಲ.

IGacademy Download App in PlayStore | SUBSCRIBE IshwarGiri ಪಾಠಶಾಲೆ | 8660070677

❖ ಅಭಿಮುಖ ಸಂಖ್ಯೆಗಳನ್ನು ಕಂಡುಹಿಡಿಯಲು ಕನಿಷ್ಠ ಎರಡು ದಾಳಗಳು ಇರಬೇಕು.

IGacademy Download App in PlayStore | SUBSCRIBE IshwarGiri ಪಾಠಶಾಲೆ | 8660070677

❖ ಅಭಿಮುಖ ಸಂಖ್ಯೆಯನ್ನು ಕಂಡುಹಿಡಿಯಲು ಎರಡು ದಾಳಗಳಲ್ಲಿ ಕನಿಷ್ಠ ಒಂದು ಸಂಖ್ಯೆ ಸಾಮಾನ್ಯವಾಗಿರಬೇಕು.





IGacademy Download App in PlayStore | SUBSCRIBE IshwarGiri ಪಾಠಶಾಲೆ | 8660070677

Type 1: ದಾಳದಲ್ಲಿ ಒಂದು ಮುಖ ಸಾಮಾನ್ಯವಾಗಿದ್ದಾಗ ಕೇಳುವ ಪ್ರಶ್ನೆಗಳು:

Type 2: ದಾಳದಲ್ಲಿ ಎರಡು ಮುಖ ಸಾಮಾನ್ಯವಾಗಿದ್ದಾಗ ಕೇಳುವ ಪ್ರಶ್ನೆಗಳು:

Type 3: ತೆರದ ದಾಳದ ಮೇಲೆ ಪ್ರಶ್ನೆಗಳು

IGacademy Download App in PlayStore | SUBSCRIBE IshwarGirl ಪಾಠಶಾಲೆ | 8660070677

Тип 1

2 → X 1

3 → 4

5 → 6

Q

2 ~

3 ~

4 ~

5 ~

6 ~

3 ⟶ ~~X~~ 4

5 ⟶ 1

6 ⟶ 2

❖ **Type 1:** ಒಂದೇ ದಾಳದ ಎರಡು ಸ್ಥಿತಿಗಳನ್ನು ಕೊಟ್ಟಾಗ ಅವುಗಳಲ್ಲಿ ಒಂದು ಮುಖ ಸಾಮಾನ್ಯವಾಗಿದ್ದರೆ, ಅಭಿಮುಖಗಳನ್ನು ಕಂಡುಹಿಡಿಯಲು ಆ ಎರಡು ದಾಳಗಳನ್ನು ಸಾಮಾನ್ಯ ಮುಖದಿಂದ ಪ್ರದಕ್ಷಿಣಾಕಾರವಾಗಿ ತಿರುಗಿಸಬೇಕು.

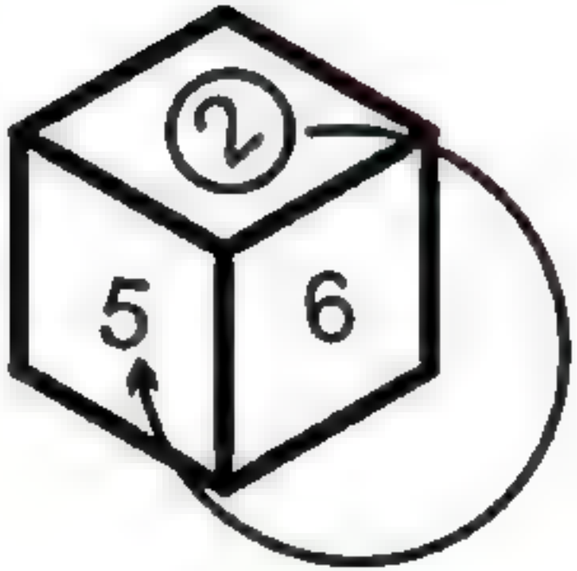



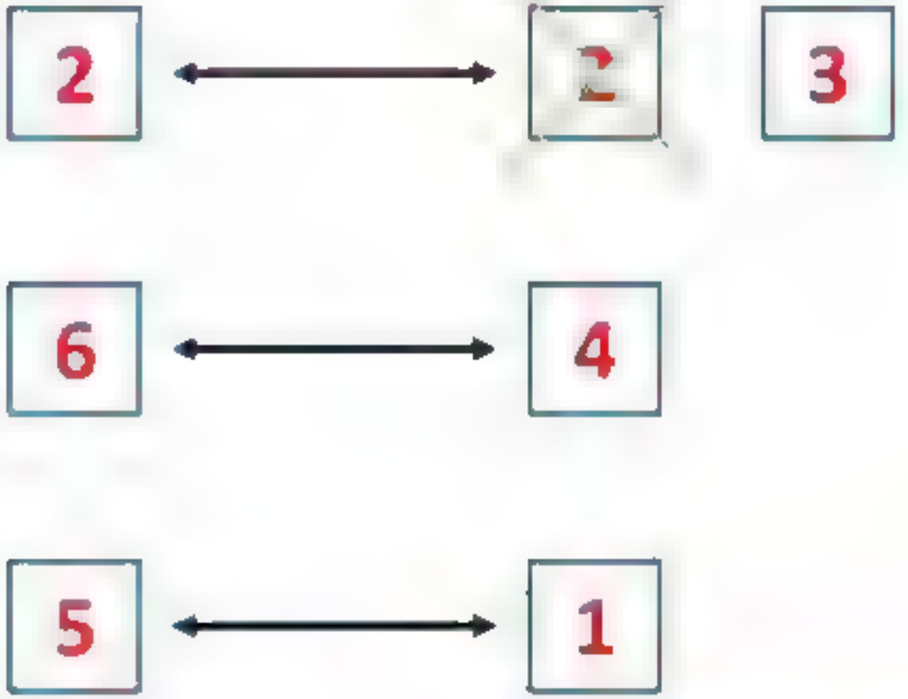

IGacademy Download App in PlayStore | SUBSCRIBE IshwarGiri ಪಾಠಶಾಲೆ | 8660070677

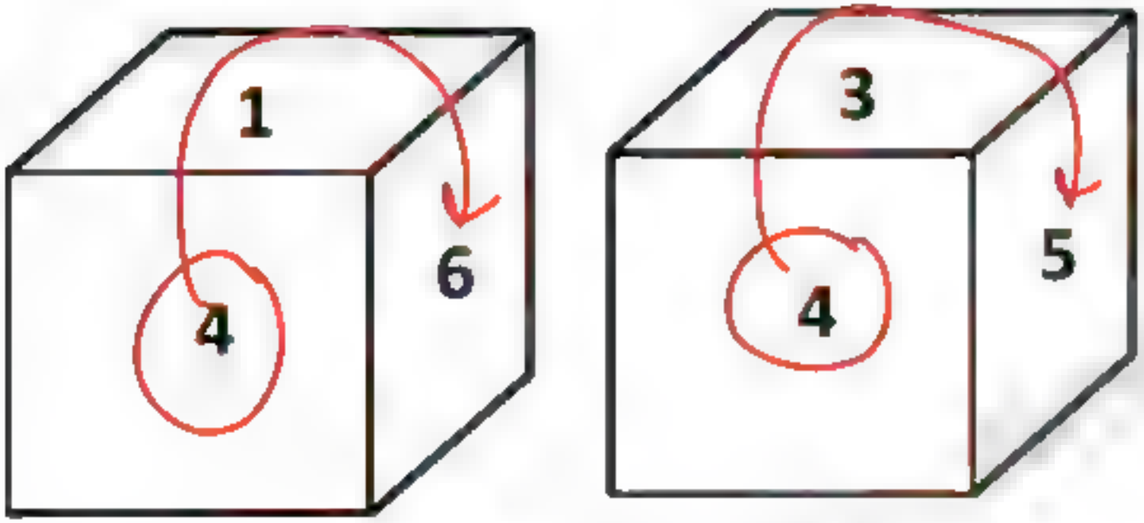

4 ⟷ (4)2

1 ⟷ 3

6 ⟷ 5

IGacademy Download App in PlayStore | SUBSCRIBE IshwarGiri ಪಾಠಶಾಲೆ | 8660070677

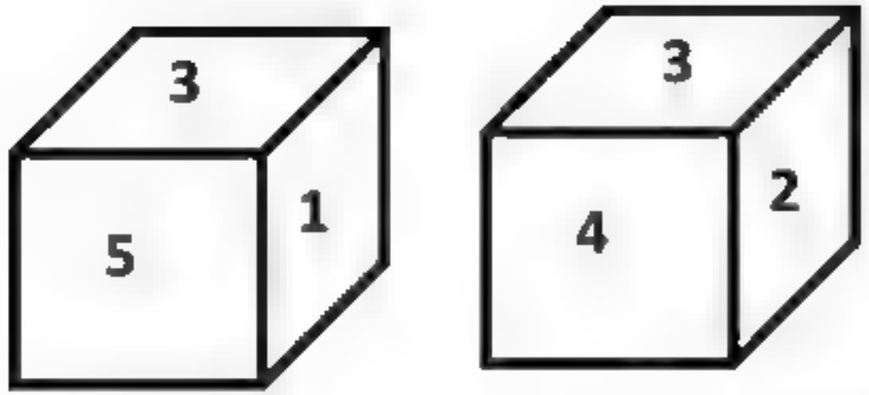

3 ⟷ (3)6

1 ⟷ 2

5 ⟷ 4

IGacademy Download App in PlayStore SUBSCRIBE IshwarGirl ಪಾಠಶಾಲೆ 8660070677

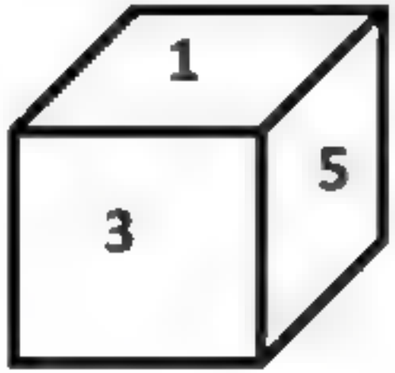

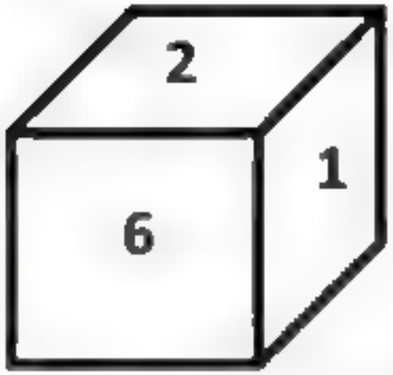

1 ⟷ (1)4

5 ⟷ 6

3 ⟷ 2

IGacademy Download App in PlayStore | SUBSCRIBE IshwarGiri ಪಾಠಶಾಲೆ | 8660070677

IGacademy Download App in PlayStore SUBSCRIBE IshwarGiri ಪಾಠಶಾಲೆ 8660070677

Q. Notice the following dices. Based on these, find the number opposite of number 2

Q. ಈ ಕೆಳಗಿನ ದಾಳಗಳನ್ನು ಗಮನಿಸಿ. ಇವುಗಳ ಆಧಾರದ ಮೇಲೆ ಸಂಖ್ಯೆ 2 ಕ್ಕೆ ವಿರುದ್ಧವಾದ ಸಂಖ್ಯೆಯನ್ನು ಕಂಡುಹಿಡಿಯಿರಿ

a) 4 **b) 3** **c) 5** **d) 6**

3 3

6 5

2 → 4

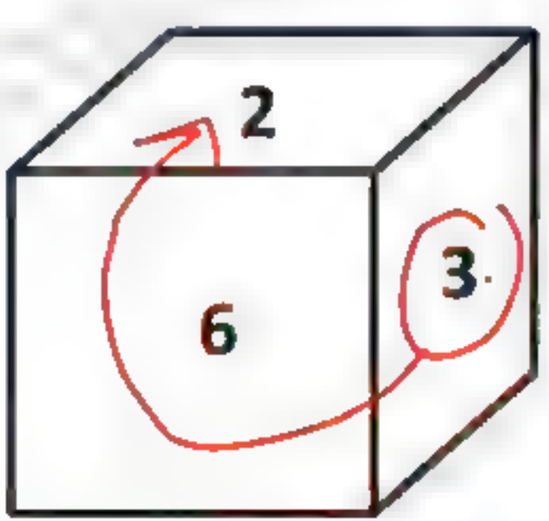

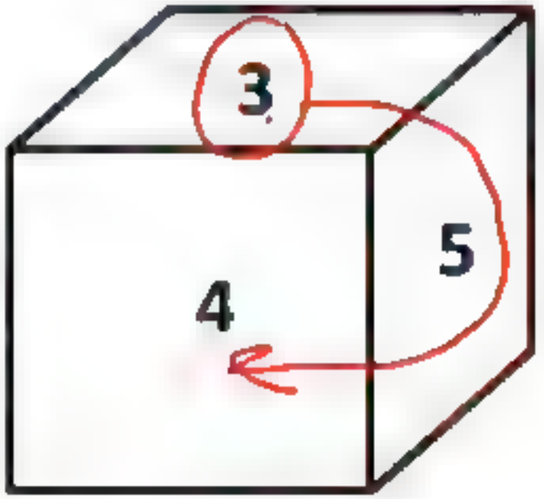

IGacademy Download App in PlayStore | SUBSCRIBE IshwarGirl ಪಾಠಶಾಲೆ | 8660070677

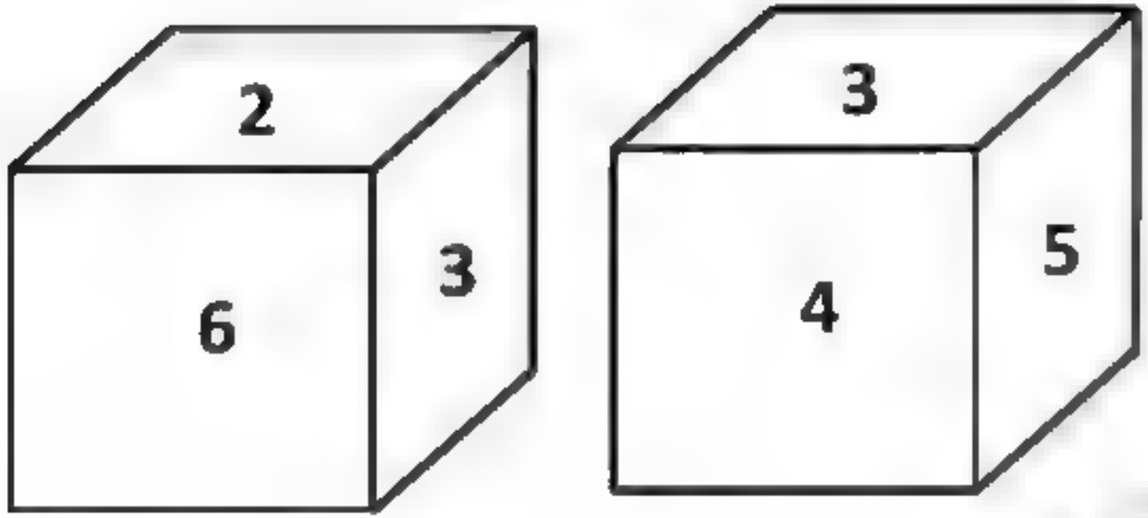

IGacademy Download App in PlayStore SUBSCRIBE IshwarGirl ಪಾಠಶಾಲೆ 8660070677

Q. Which number will be opposite to the 5, in given dice?

ದಾಳದ ಎರಡು ಸ್ಥಿತಿಗಳನ್ನು ನೀಡಲಾಗಿದೆ. ಕೊಟ್ಟಿರುವ ದಾಳಗಳಲ್ಲಿ ಯಾವ ಸಂಖ್ಯೆ 5 ಕ್ಕೆ ವಿರುದ್ಧವಾಗಿರುತ್ತದೆ?

a)2 b)4 c)6 d)1

1 1

6 3

4 — 5

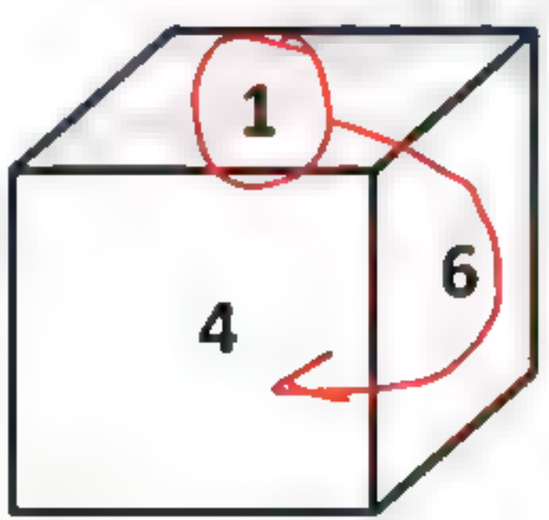

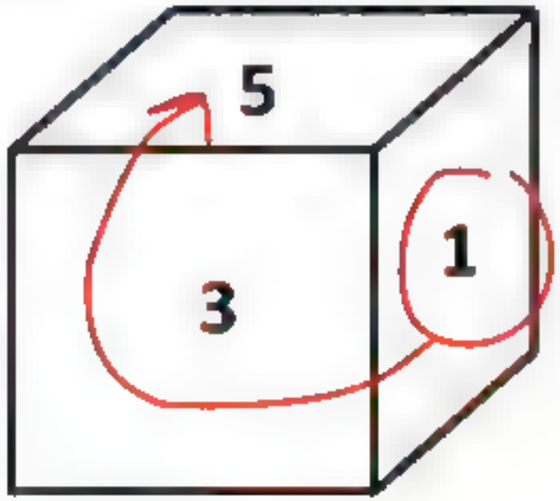

IGacademy Download App in PlayStore | SUBSCRIBE IshwarGirl ಪಾಠಶಾಲೆ | 8660070677

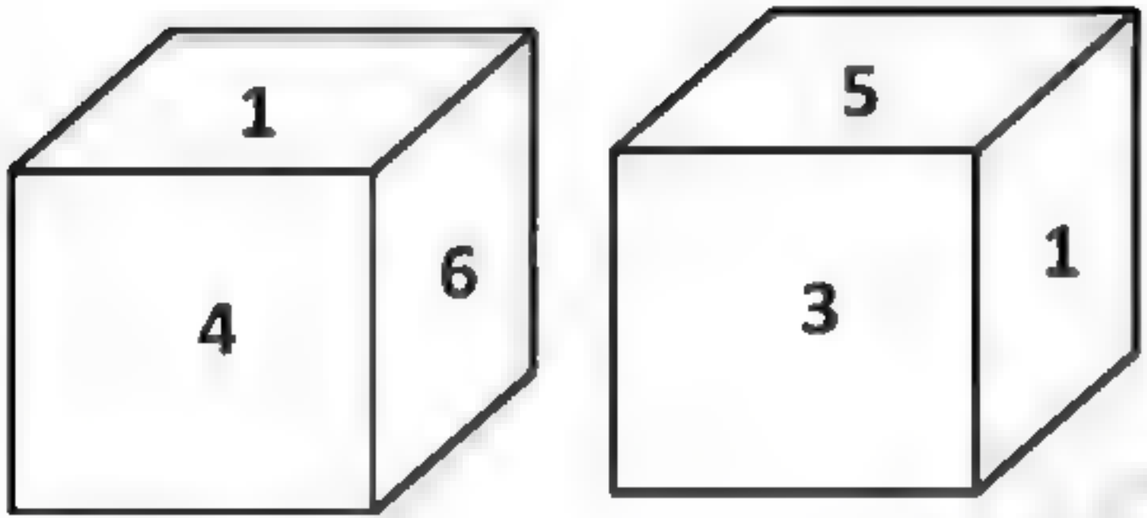

IGacademy Download App in PlayStore | SUBSCRIBE IshwarGiri ಪಾಠಶಾಲೆ | 8660070677

Q. Notice the following dices. Based on these, find the number opposite of number 6

Q. ಈ ಕೆಳಗಿನ ದಾಳಗಳನ್ನು ಗಮನಿಸಿ. ಇವುಗಳ ಆಧಾರದ ಮೇಲೆ ಸಂಖ್ಯೆ 6 ಕ್ಕೆ ವಿರುದ್ಧವಾದ ಸಂಖ್ಯೆಯನ್ನು ಕಂಡುಹಿಡಿಯಿರಿ

a) 4 **b) 2** **c) 5** **d) 6**



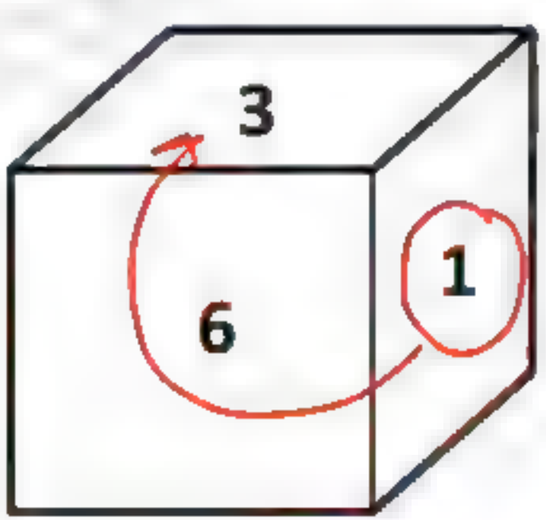

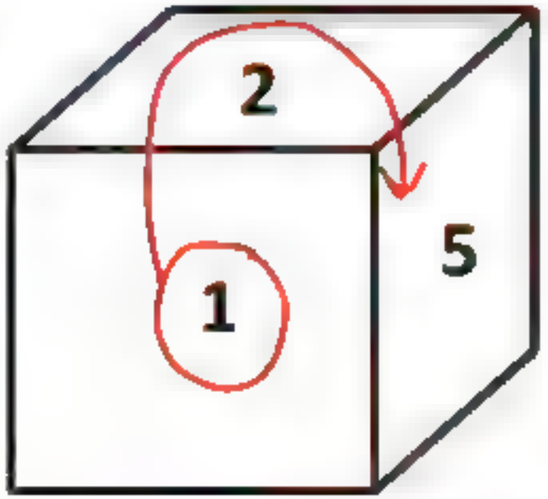

IGacademy Download App in PlayStore | SUBSCRIBE IshwarGirl ಪಾಠಶಾಲೆ | 8660070677

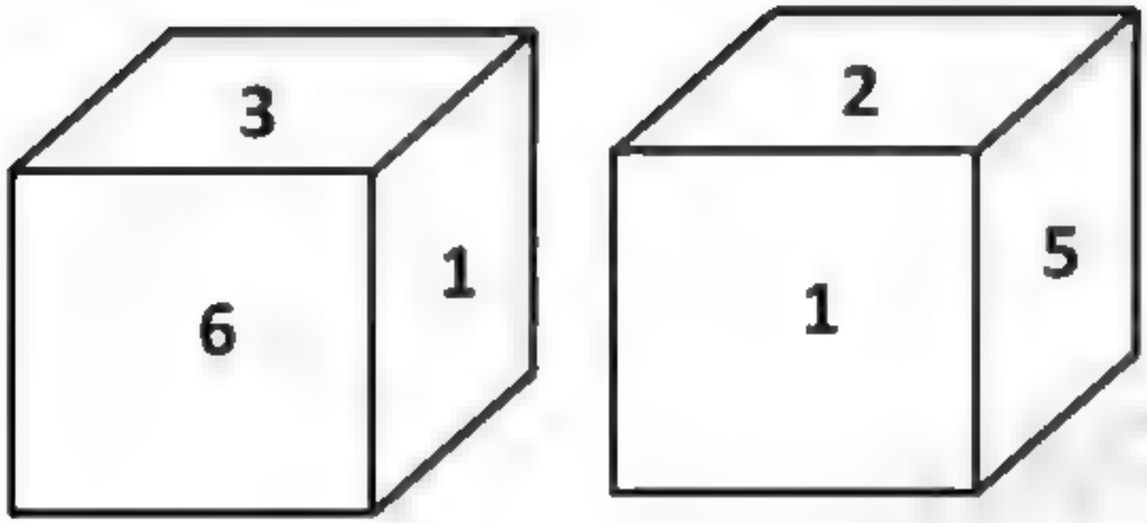

IGacademy Download App in PlayStore SUBSCRIBE IshwarGirl ಪಾಠಶಾಲೆ 8660070677

Q. Which number will be opposite to the 2, in given dice?

ದಾಳದ ಎರಡು ಸ್ಥಿತಿಗಳನ್ನು ನೀಡಲಾಗಿದೆ. ಕೊಟ್ಟಿರುವ ದಾಳಗಳಲ್ಲಿ ಯಾವ ಸಂಖ್ಯೆ 2 ಕ್ಕೆ ವಿರುದ್ಧವಾಗಿರುತ್ತದೆ?

a)1 ✓ b)3 c)6 d)5

2 — ~~2~~ 1

3 — 6

5 — 4

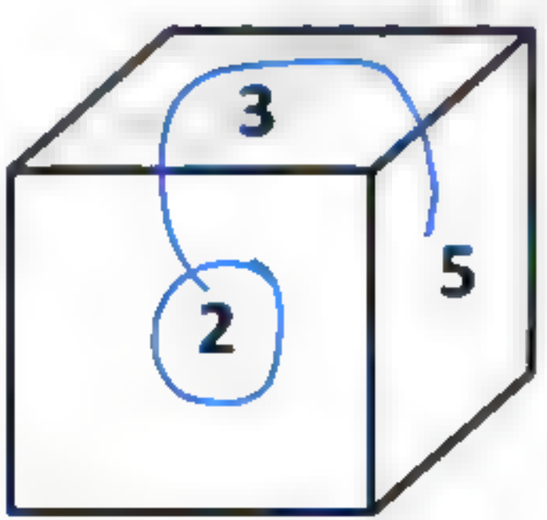

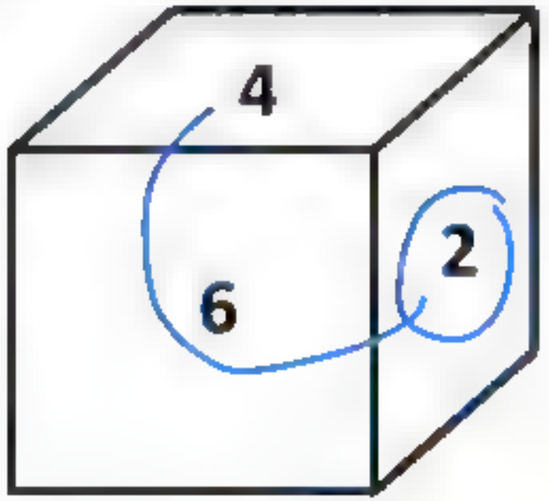

IGacademy Download App in PlayStore | SUBSCRIBE IshwarGiri ಪಾಠಶಾಲೆ | 8660070677

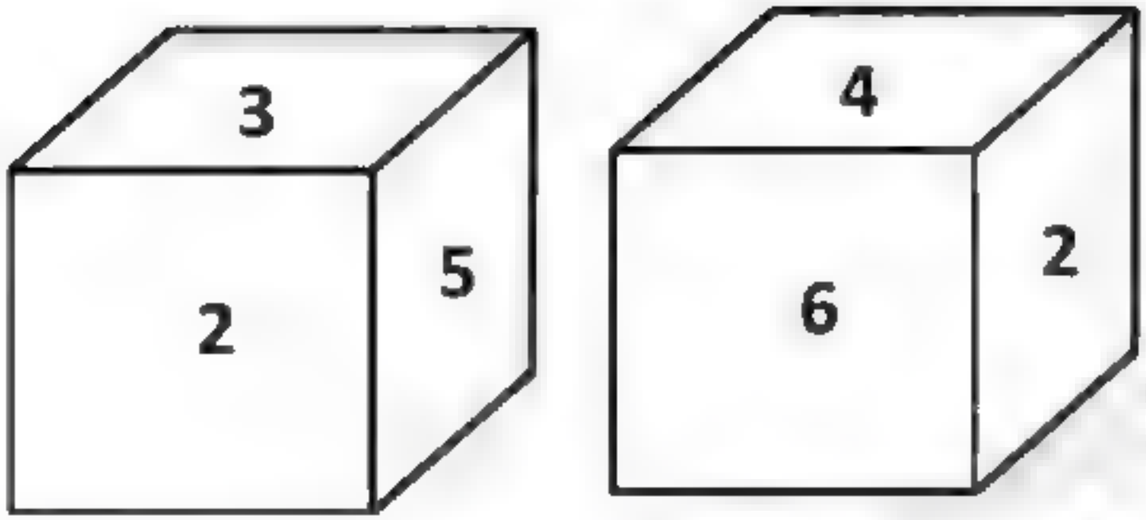

IGacademy Download App in PlayStore SUBSCRIBE IshwarGiri ಪಾಠಶಾಲೆ 8660070677

PSI – 2018

Q. Two positions of a dice are shown below. Which number will appear on the face opposite to the face with the number 5?

' ಡೈಸ್ ' ನ ಎರಡು ಸ್ಥಾನಗಳನ್ನು ಕೆಳಗೆ ತೋರಿಸಲಾಗಿದೆ . 5 ಸಂಖ್ಯೆ ಇರುವ ' ಡೈಸ್ ' ನ ಮುಖದ ವಿರುದ್ಧವಾಗಿರುವ ಮುಖದಲ್ಲಿ ಯಾವ ಸಂಖ್ಯೆ ಇರುತ್ತದೆ ?

a) 2/6 b) 2

c)6 d) 4

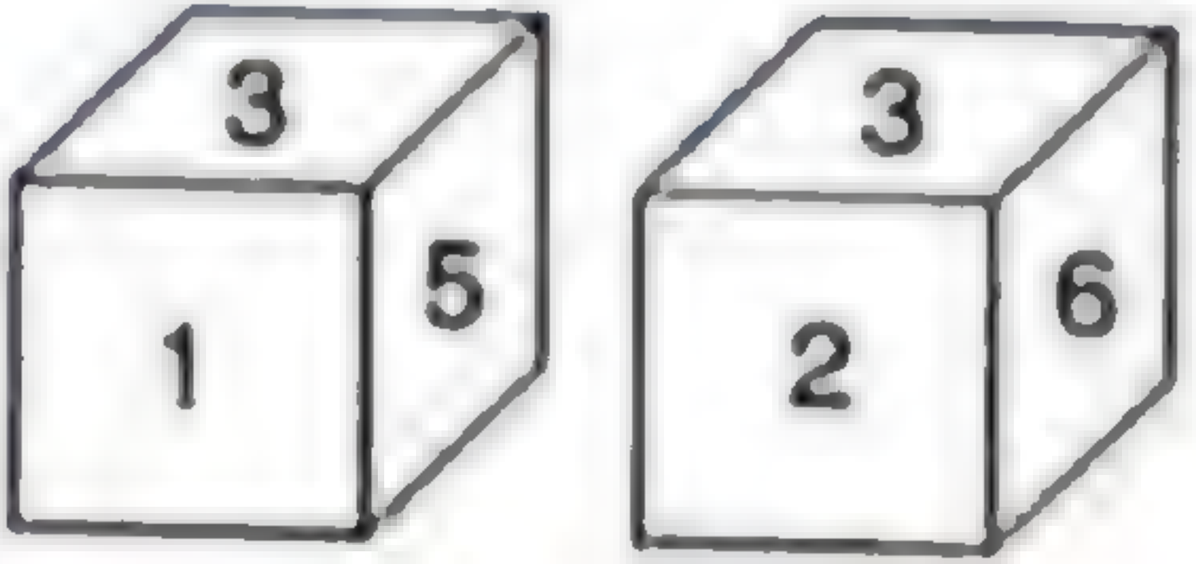

IGacademy Download App in PlayStore SUBSCRIBE IshwarGirl ಪಾಠಶಾಲೆ 8660070677



5 — 6

iGacademy Download App in PlayStore | SUBSCRIBE IshwarGiri ಪಾಠಶಾಲೆ | 8660070677

Q. Find the opposite of face having 2 dots.

2 ಚುಕ್ಕೆ ಹೊಂದಿರುವ ಮುಖದ ಅಭಿಮುಖದಲ್ಲಿ ಎಷ್ಟು ಚುಕ್ಕಿಗಳಿವೆ.

a)3 b)6 c)4 d)5

2 — 4

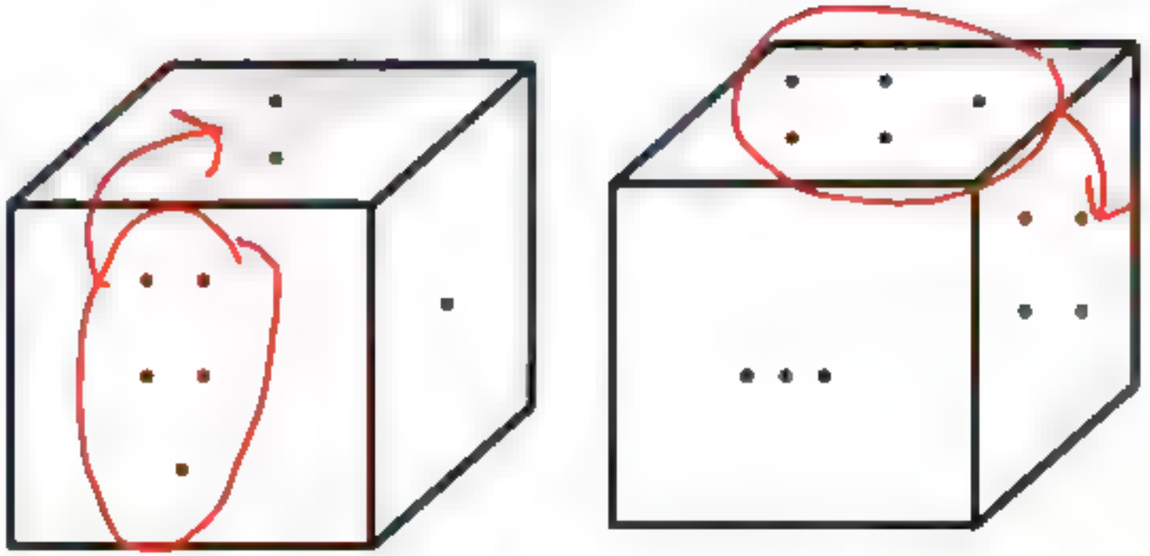

IGacademy Download App in PlayStore SUBSCRIBE IshwarGirl ಪಾಠಶಾಲೆ 8660070677

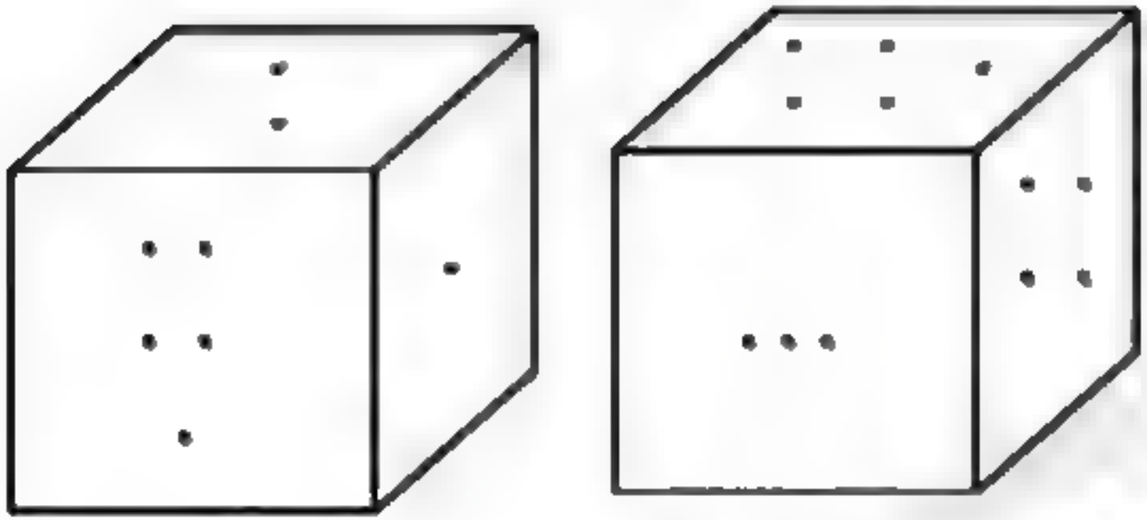

iGacademy Download App in PlayStore SUBSCRIBE IshwarGirl ಪಾಠಶಾಲೆ 8660070677

Q. Find the opposite of face having 3 dots.

3 ಚುಕ್ಕೆಗಳನ್ನು ಹೊಂದಿರುವ ಮುಖದ ಅಭಿಮುಖದಲ್ಲಿ ಎಷ್ಟು ಚುಕ್ಕಿಗಳಿವೆ.

a)1 b)2 c)4 d)6

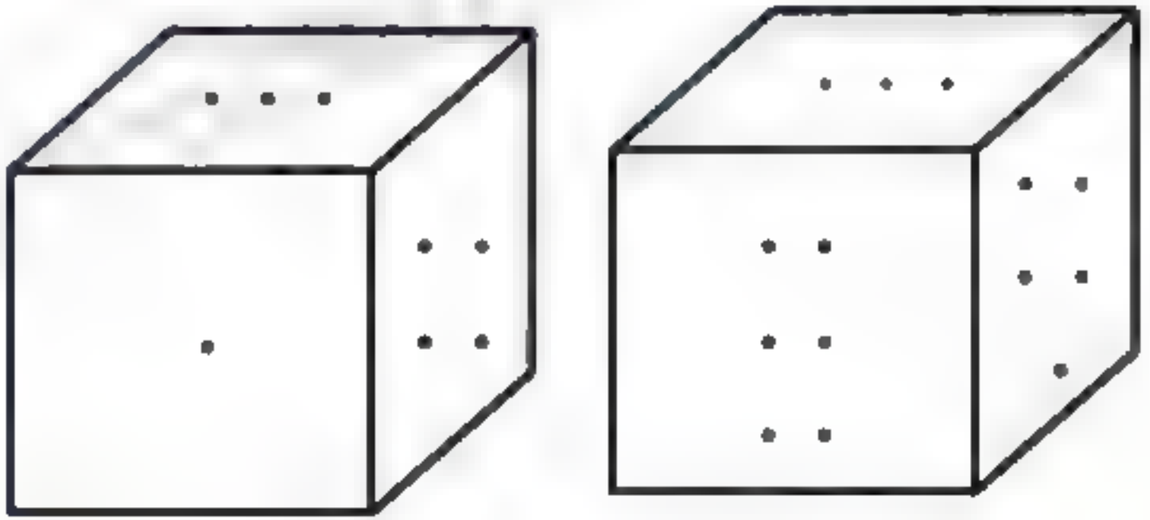

iGacademy Download App in PlayStore SUBSCRIBE IshwarGirl ಪಾಠಶಾಲೆ 8660070677

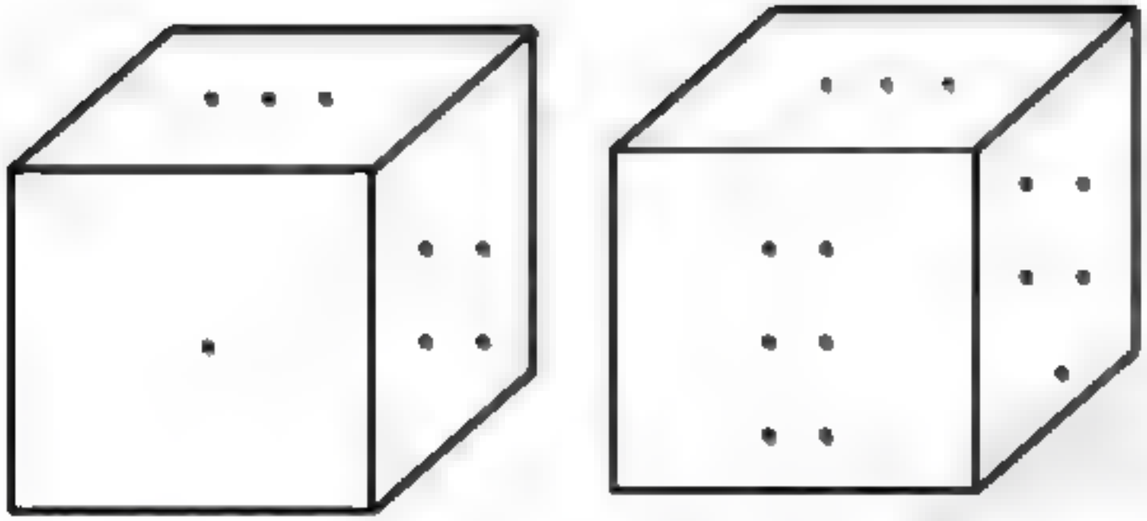

IGacademy Download App in PlayStore SUBSCRIBE IshwarGiri ಪಾಠಶಾಲೆ 8660070677

Q. Find the opposite sign of ' @ '.
' @ ' ನ ಅಭಿಮುಖ ಚಿಹ್ನೆಯನ್ನು ಹುಡುಕಿ.

a)# **b)+** **c) *** **d)%**

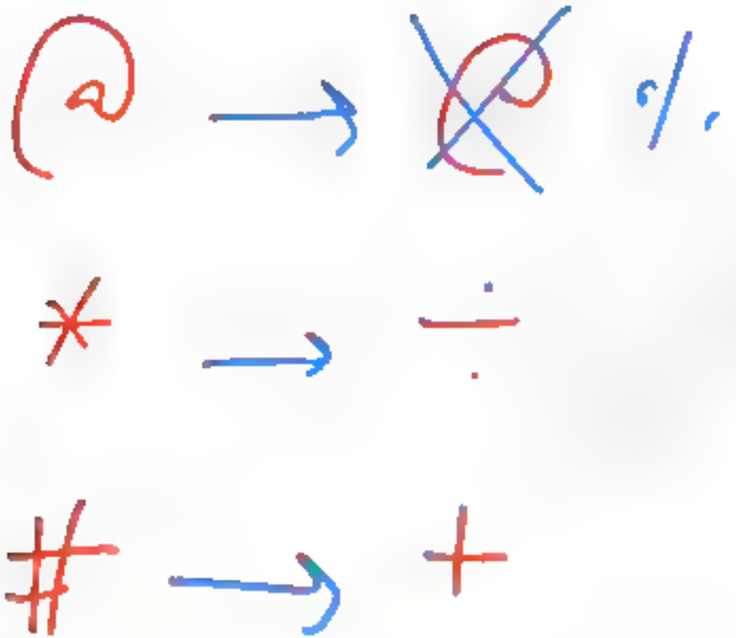

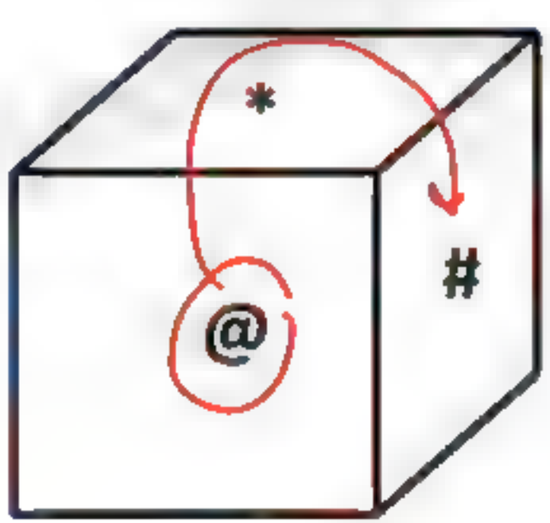

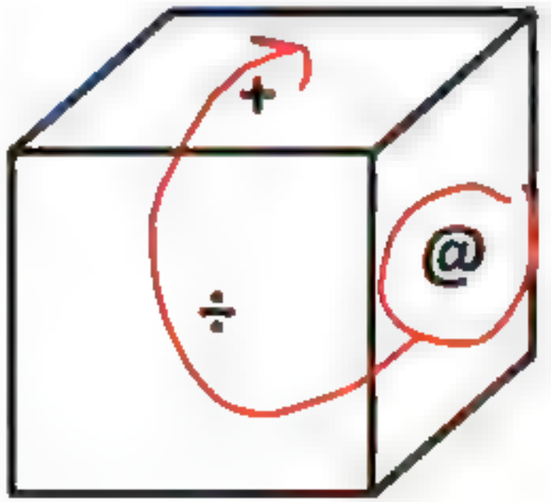

IGacademy Download App in PlayStore | SUBSCRIBE IshwarGiri ಪಾಠಶಾಲೆ | 8660070677

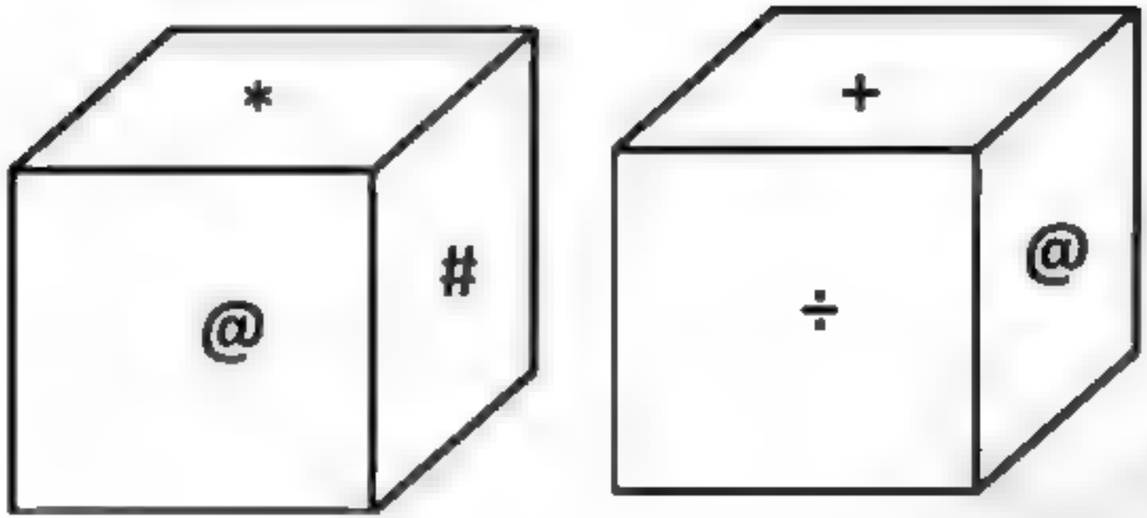

IGacademy Download App in PlayStore | SUBSCRIBE IshwarGirl ಪಾಠಶಾಲೆ | 8660070677

Q. Find opposite colour of RED.
ಕೆಂಪು ಬಣ್ಣದ ಅಭಿಮುಖ ಬಣ್ಣವನ್ನು ಗುರುತಿಸಿ.

a)Orange b) Yellow c) Blue d) Pink

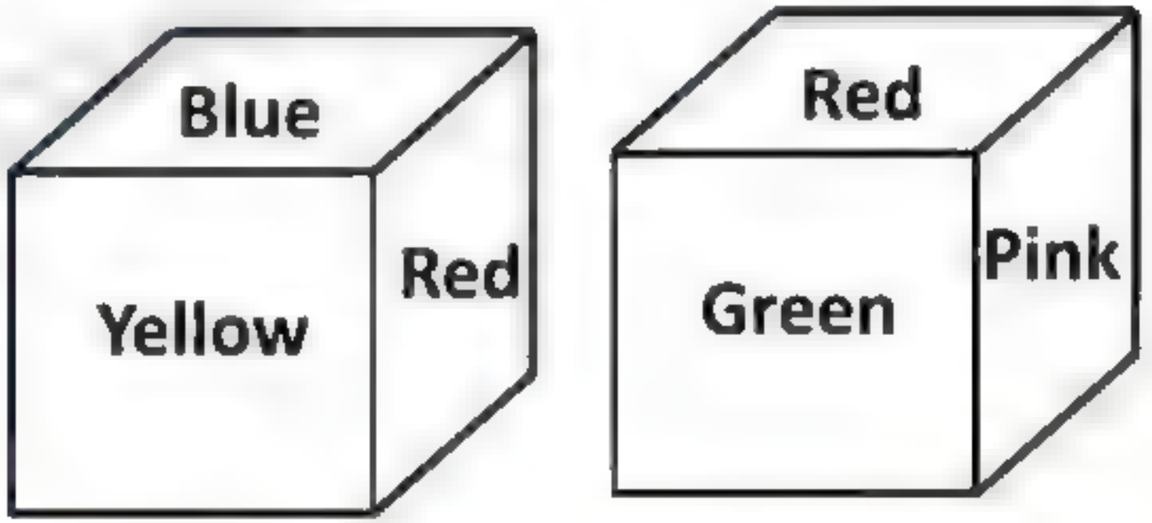

IGacademy Download App in PlayStore | SUBSCRIBE IshwarGirl ಪಾಠಶಾಲೆ | 8660070677

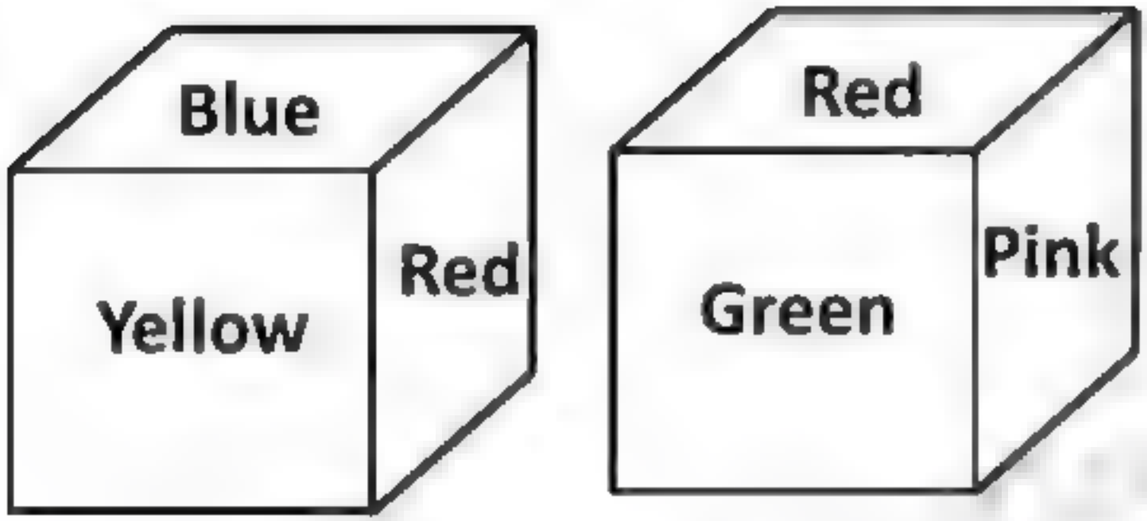

IGacademy Download App in PlayStore SUBSCRIBE IshwarGiri ಪಾಠಶಾಲೆ 8660070677

Q. Which symbol will be opposite to &?

ದಾಳದ ಎರಡು ಸ್ಥಿತಿಗಳನ್ನು ನೀಡಲಾಗಿದೆ. ಕೊಟ್ಟಿರುವ ದಾಳಗಳಲ್ಲಿ ಯಾವ ಚಿಹ್ನೆ & ಕ್ಕೆ ವಿರುದ್ಧವಾಗಿರುತ್ತದೆ?

a)$ b)% c)# d)@

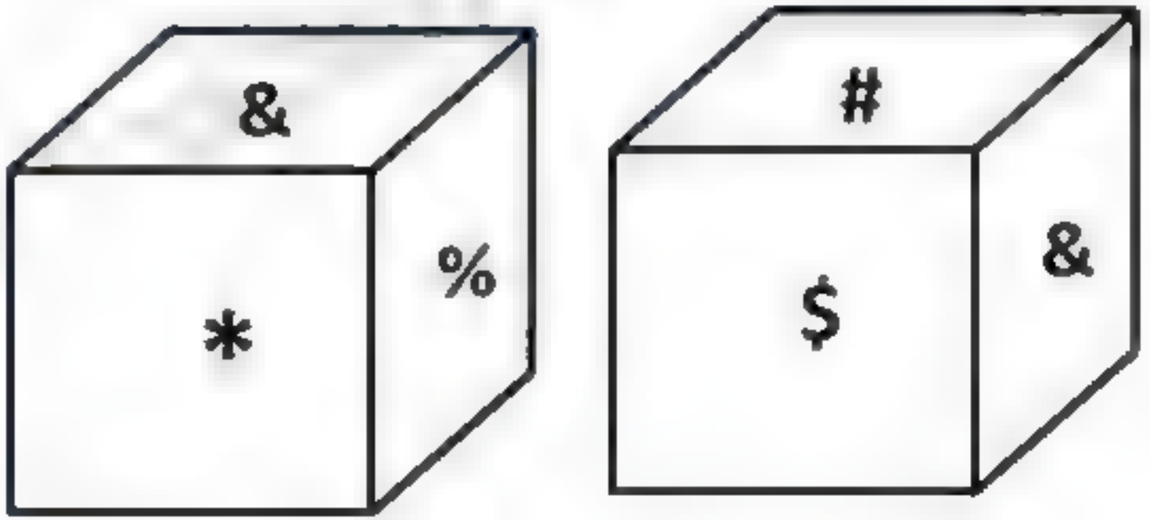

iGacademy Download App in PlayStore SUBSCRIBE IshwarGiri ಪಾಠಶಾಲೆ 8660070677

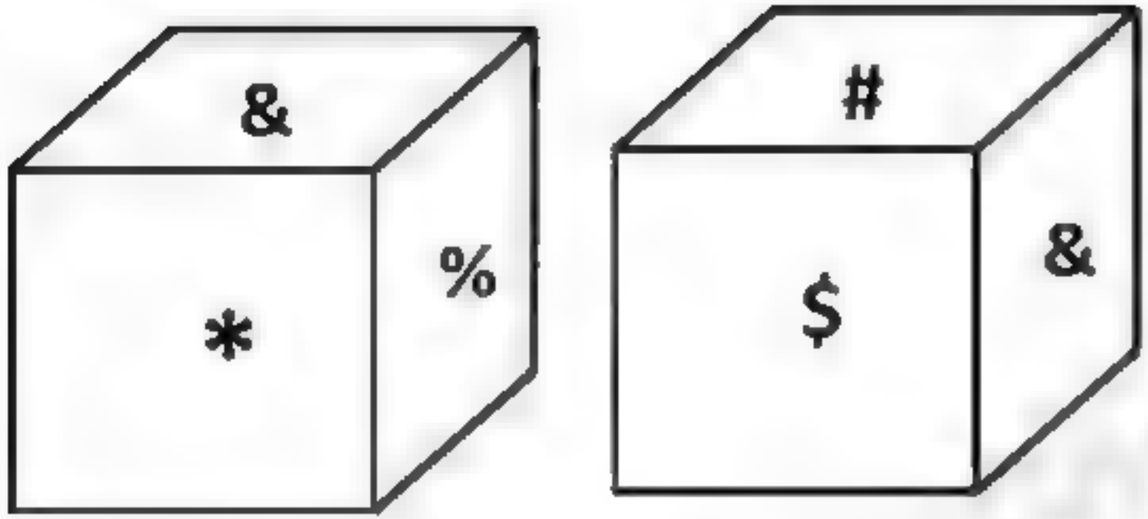

IGacademy Download App in PlayStore SUBSCRIBE IshwarGiri ಪಾಠಶಾಲೆ 8660070677

KSISF - PSI - 2020

Q. A dice with six faces is marked with six numbers 1, 2, 3, 4, 5 and 6 respectively, This dice is rolled three times and three positions are shown as Find the number opposite to 1.

ಆರು ಮುಖಗಳನ್ನು ಹೊಂದಿರುವ ದಾಳ ಕ್ರಮವಾಗಿ ಆರು ಸಂಖ್ಯೆಗಳನ್ನು 1, 2, 3, 4, 5 ಮತ್ತು 6 ಎಂದು ಗುರುತಿಸಲಾಗಿದೆ. ಈ ದಾಳವನ್ನು ಮೂರು ಬಾರಿ ಉರುಳಿಸಲಾಗುತ್ತದೆ ಮತ್ತು ಅದರ ಮೂರು ಸ್ಥಾನಗಳನ್ನು ಹೀಗೆ ತೋರಿಸಲಾಗಿದೆ.

1 ಕ್ಕೆ ವಿರುದ್ಧವಾದ ಸಂಖ್ಯೆಯನ್ನು ಹುಡುಕಿ.

(a) 2 (b) 6

(c) 5 (d) 4

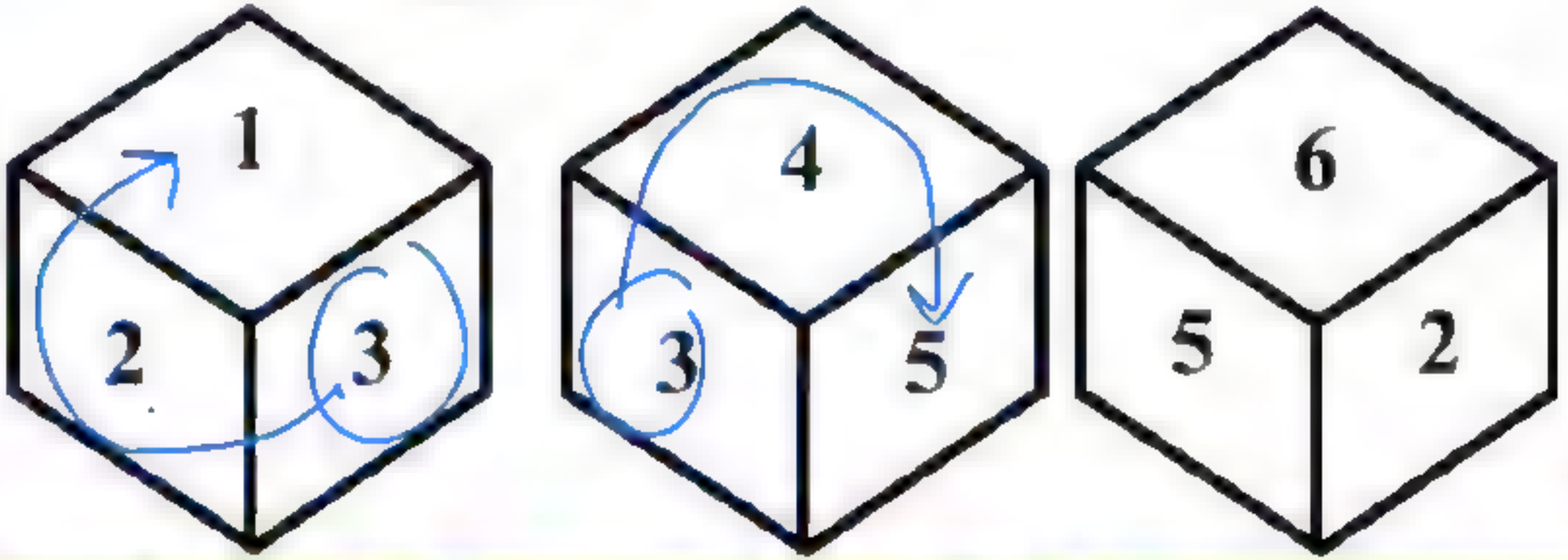

IGacademy Download App in PlayStore | SUBSCRIBE IshwarGirl ಪಾಠಶಾಲೆ | 8660070677

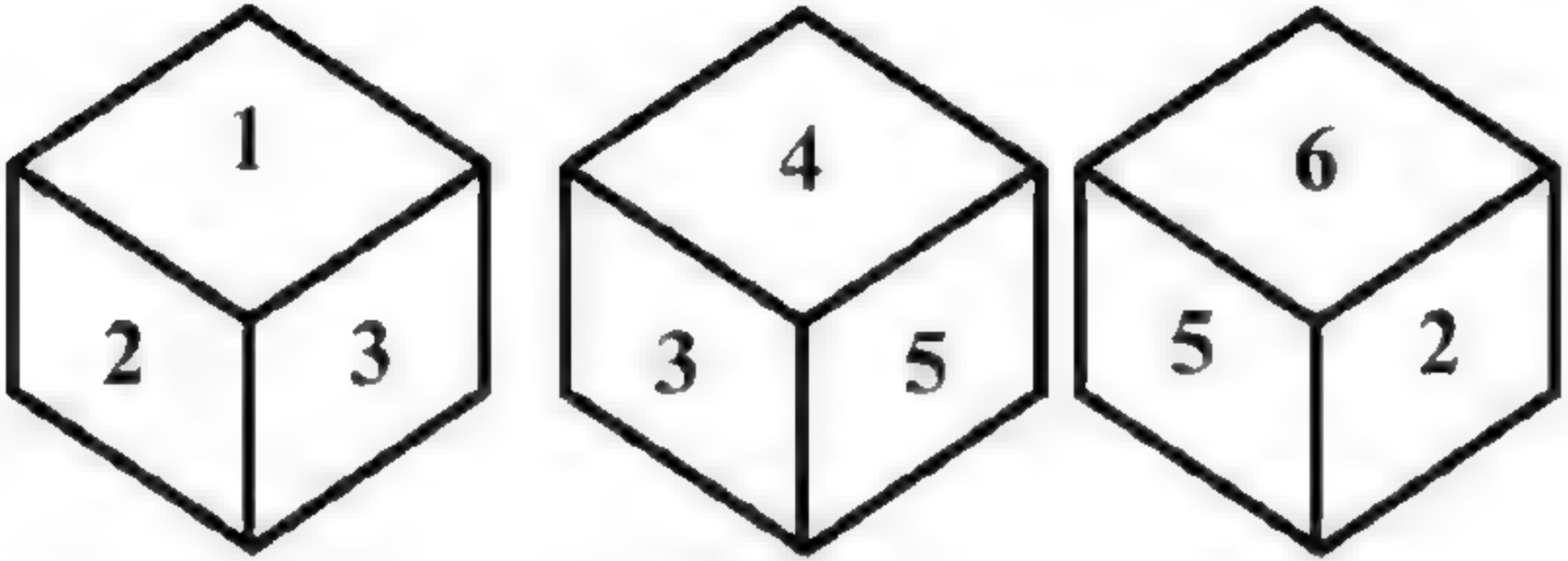

IGacademy Download App in PlayStore SUBSCRIBE IshwarGiri ಪಾಠಶಾಲೆ 8660070677

IAS – 2012

Q. In the following image there are three forms of the dice. Which letter comes in the opposite face of the letter A?

Q . ಈ ಕೆಳಗಿನ ಚಿತ್ರದಲ್ಲಿ ದಾಳದ ಮೂರು ರೂಪಗಳಿವೆ A ಅಕ್ಷರದ ಅಭಿಮುಖದಲ್ಲಿ ಯಾವ ಅಕ್ಷರ ಬರುತ್ತದೆ?

a) H b) P c) B d) M

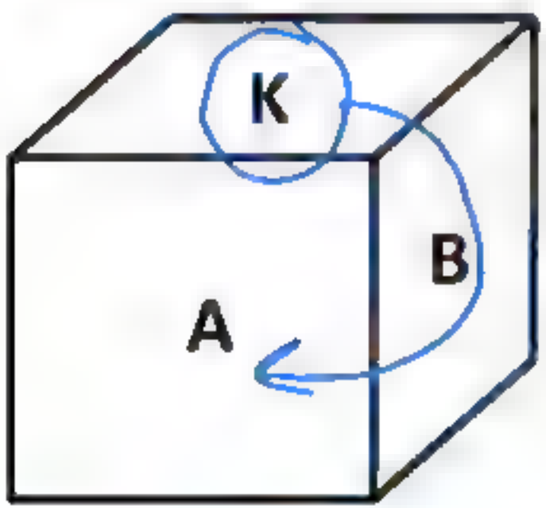

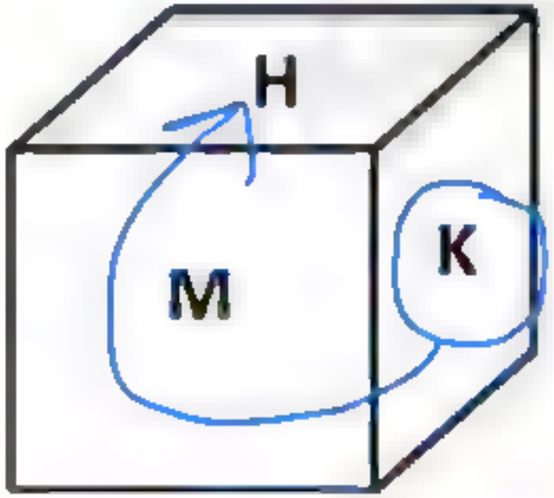

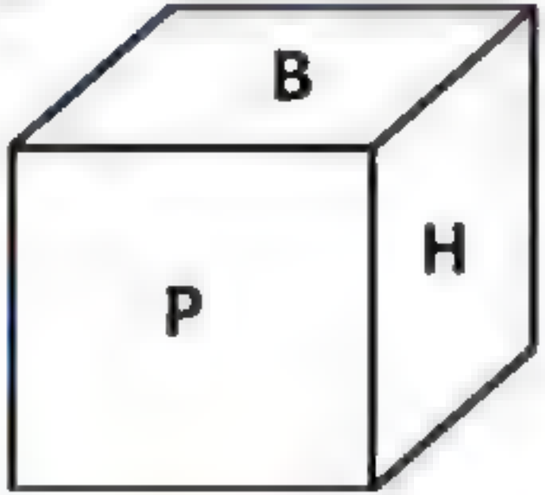

K K
B M
A → H

IGacademy Download App in PlayStore | SUBSCRIBE IshwarGirl ಪಾಠಶಾಲೆ | 8660070677

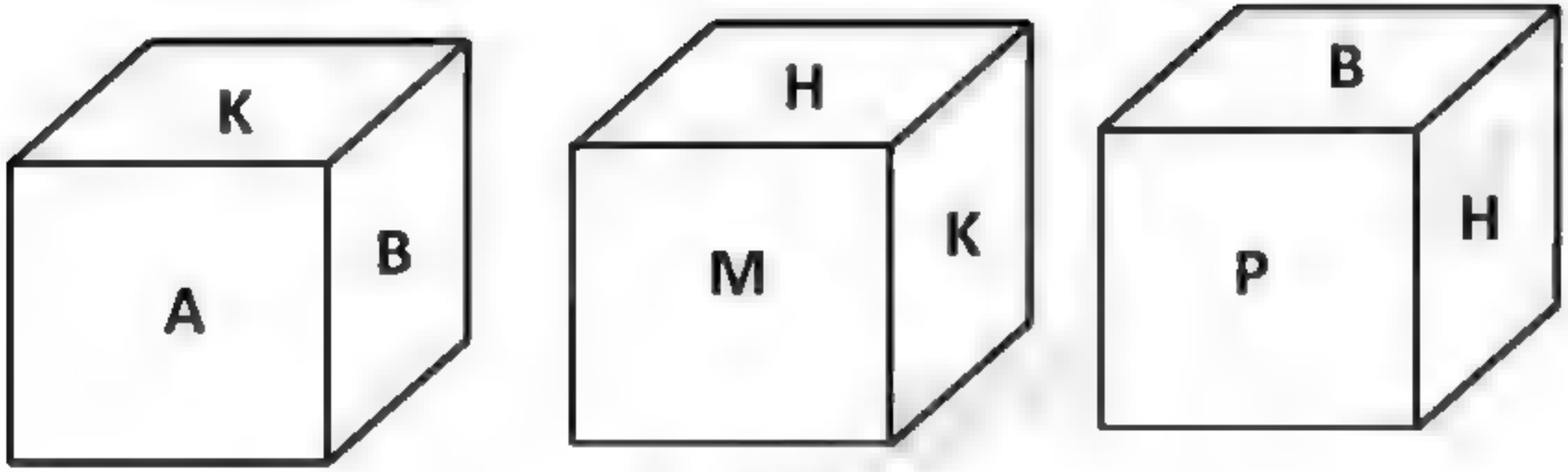

IGacademy Download App in PlayStore SUBSCRIBE IshwarGiri ಪಾಠಶಾಲೆ 8660070677

Q. Find the opposite of face having 5 dots.

5 ಚುಕ್ಕೆಗಳನ್ನು ಹೊಂದಿರುವ ಮುಖದ ಅಭಿಮುಖವನ್ನು ಹುಡುಕಿ.

a)1 **b)2** **c)4** **d)6**

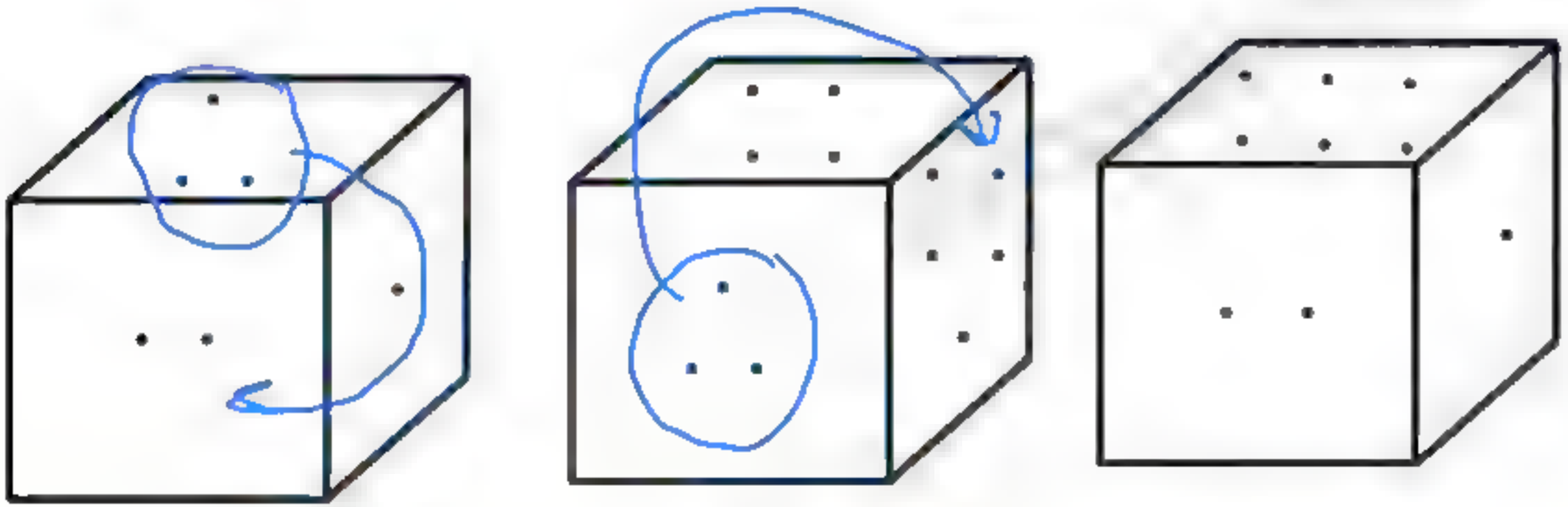

2 — 5

IGacademy Download App in PlayStore | SUBSCRIBE IshwarGiri ಪಾಠಶಾಲೆ | 8660070677

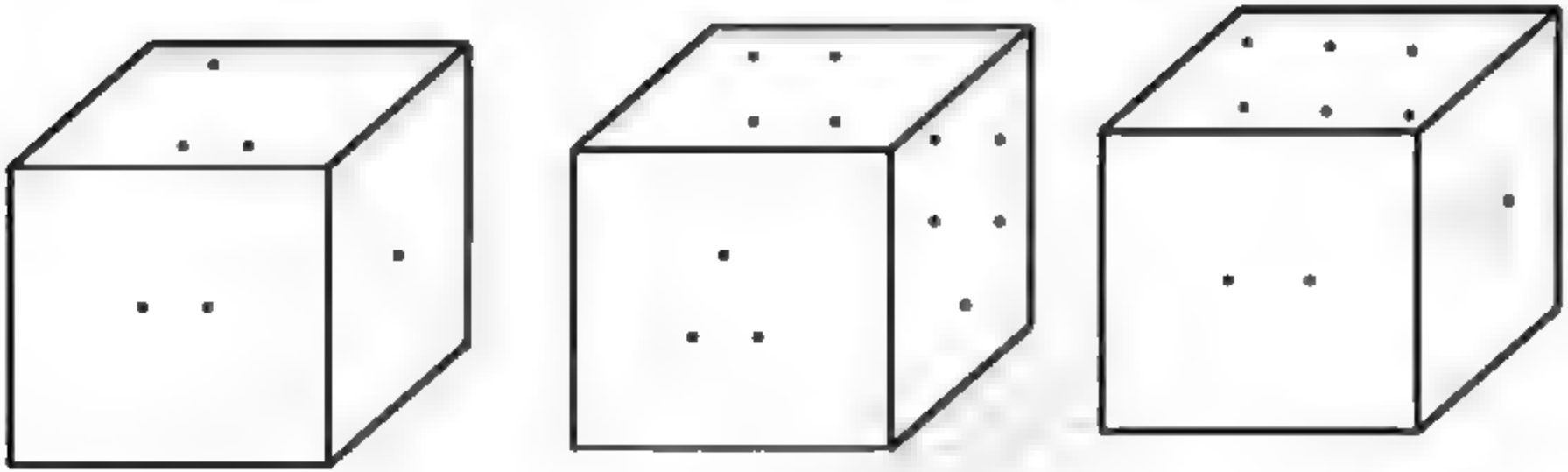

IGacademy Download App in PlayStore | SUBSCRIBE IshwarGirl ಪಾಠಶಾಲೆ | 8660070677

Q. A dice with six faces is marked with dots 1, 2, 3, 4, 5 and 6 respectively. This dice is rolled three times and three positions are shown as:

Find the number opposite to 5.

ಆರು ಮುಖಗಳನ್ನು ಹೊಂದಿರುವ ದಾಳವನ್ನು ಕ್ರಮವಾಗಿ 1, 2, 3, 4, 5 ಮತ್ತು 6 ಚುಕ್ಕೆಗಳೊಂದಿಗೆ ಗುರುತಿಸಲಾಗಿದೆ. ಈ ದಾಳವನ್ನು ಮೂರು ಬಾರಿ ಉರುಳಿಸಲಾಗುತ್ತದೆ ಮತ್ತು ದಾಳದ ಮೂರು ಸ್ಥಿತಿಗಳನ್ನು ನೀಡಲಾಗಿದೆ: 5 ಚುಕ್ಕೆಗಳನ್ನು ಹೊಂದಿರುವ ಮುಖದ ಅಭಿಮುಖವನ್ನು ಹುಡುಕಿ

a)1 b)2

c)4 d)3

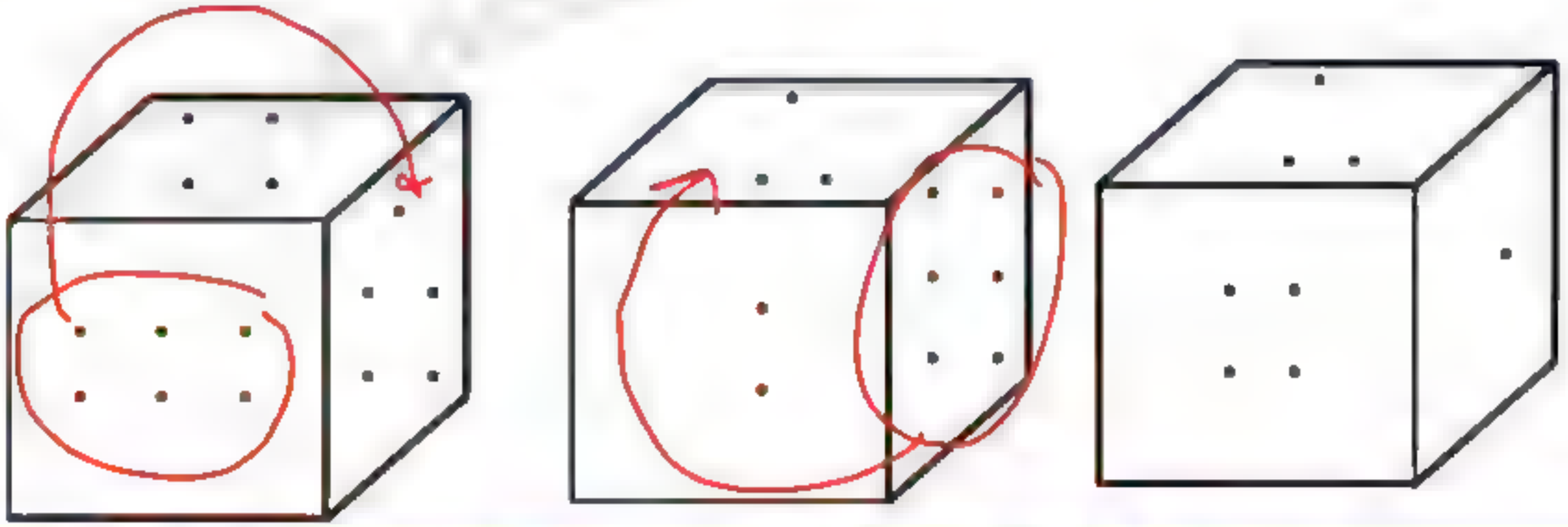

iGacademy Download App in PlayStore | SUBSCRIBE IshwarGirl ಪಾಠಶಾಲೆ | 8660070677

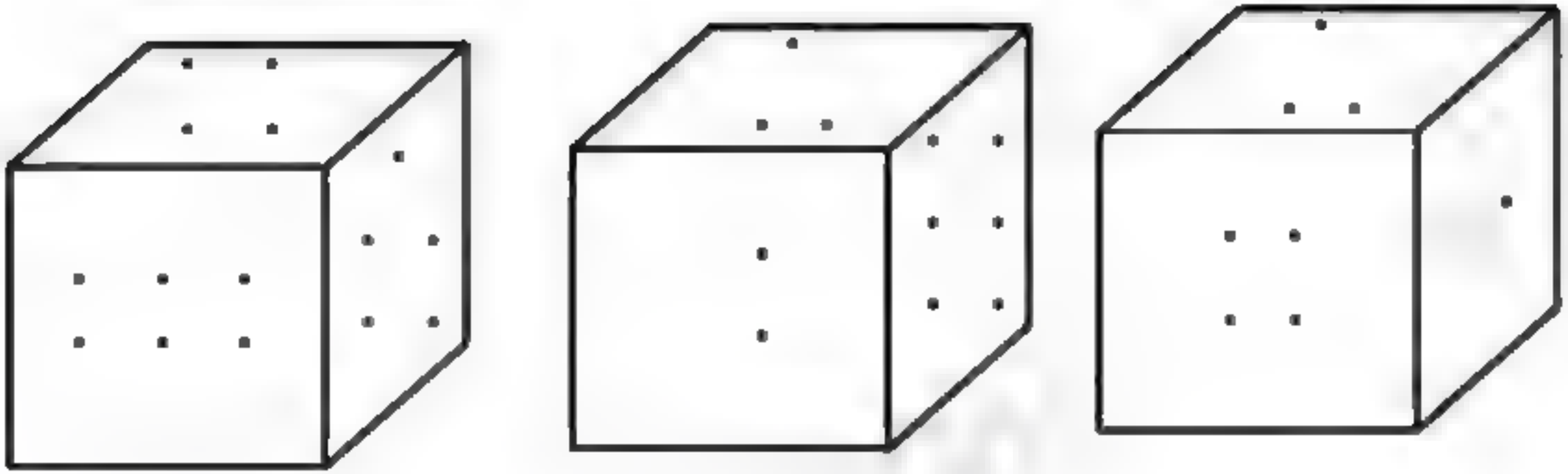

IGacademy Download App in PlayStore SUBSCRIBE IshwarGiri ಪಾಠಶಾಲೆ 8660070677

Q. Find opposite face of symbol ' I '

' I ' ರ ಅಭಿಮುಖ ಚಿಹ್ನೆಯನ್ನು ಕಂಡುಹಿಡಿಯಿರಿ.

a)II **b)III** **c)V** **d)IV**

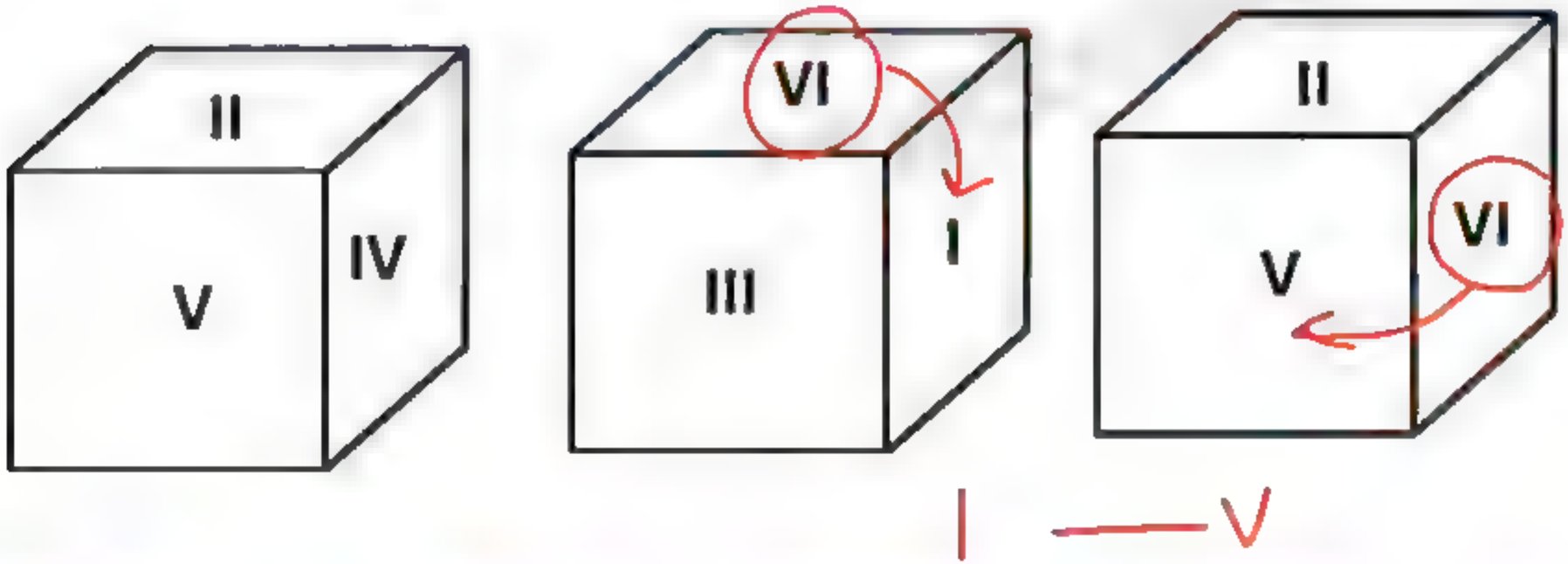

I — V

IGacademy Download App in PlayStore | SUBSCRIBE IshwarGirl ಪಾಠಶಾಲೆ | 8660070677

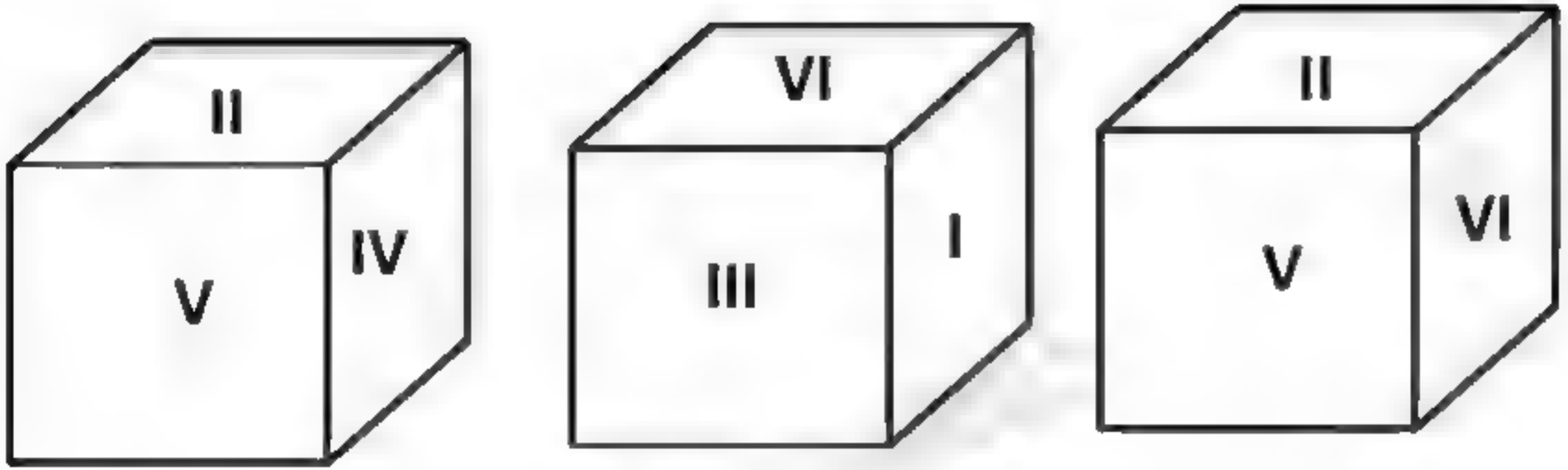

IGacademy Download App in PlayStore SUBSCRIBE IshwarGiri ಪಾಠಶಾಲೆ 8660070677

Q. A dice with six faces is marked with six numbers 1, 2, 3, 4, 5 and 6 respectively. This dice is rolled three times and three positions are shown as: Find the number opposite to 3.

ಆರು ಮುಖಗಳನ್ನು ಹೊಂದಿರುವ ದಾಳವನ್ನು ಕ್ರಮವಾಗಿ 1, 2, 3, 4, 5 ಮತ್ತು 6 ಸಂಖ್ಯೆಗಳೊಂದಿಗೆ ಗುರುತಿಸಲಾಗಿದೆ. ಈ ದಾಳವನ್ನು ಮೂರು ಬಾರಿ ಉರುಳಿಸಲಾಗುತ್ತದೆ ಮತ್ತು ದಾಳದ ಮೂರು ಸ್ಥಿತಿಗಳನ್ನು ನೀಡಲಾಗಿದೆ: 3 ಕ್ಕೆ ವಿರುದ್ಧವಾದ ಸಂಖ್ಯೆಯನ್ನು ಹುಡುಕಿ.

a)4

b)3

c)6

d)1

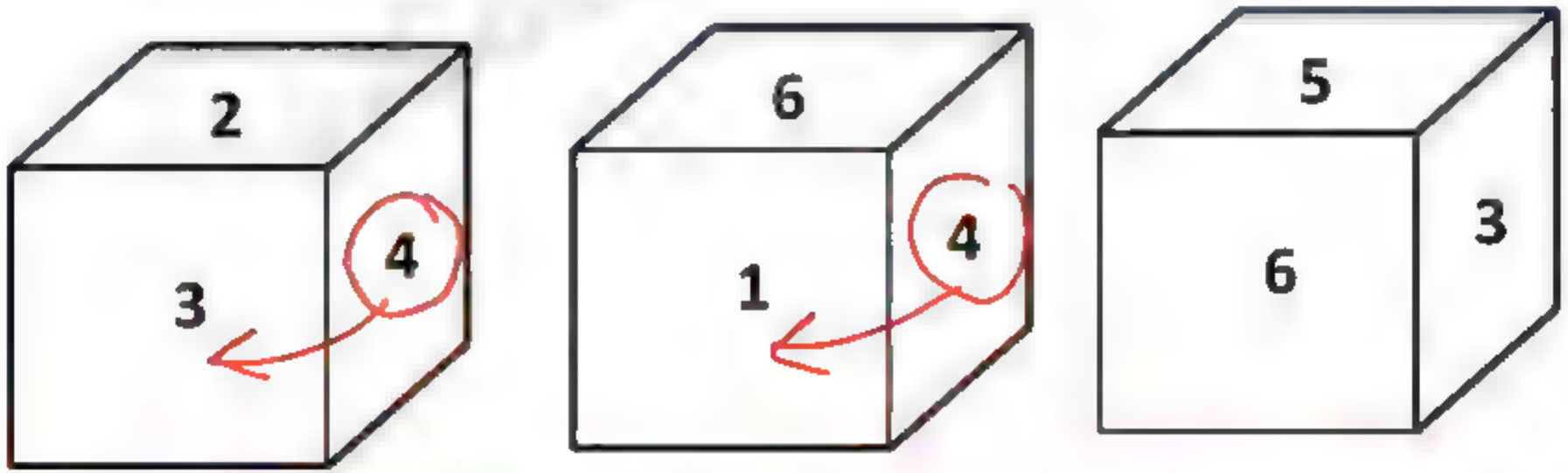

IGacademy Download App in PlayStore | SUBSCRIBE IshwarGirl ಪಾಠಶಾಲೆ | 8660070677

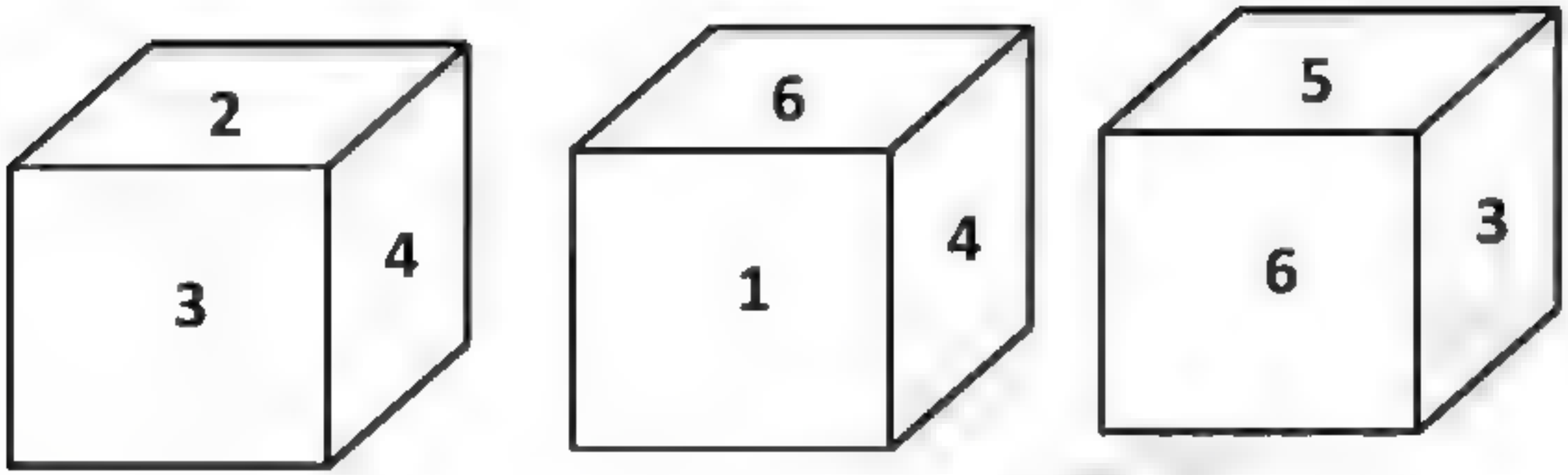

IGacademy Download App in PlayStore SUBSCRIBE IshwarGirl ಪಾಠಶಾಲೆ 8660070677

Q. Find opposite face of symbol ' I '

' I ' ರ ಅಭಿಮುಖ ಚಿಹ್ನೆಯನ್ನು ಕಂಡುಹಿಡಿಯಿರಿ.

a)III **b)3** **c) 2** **d)I**

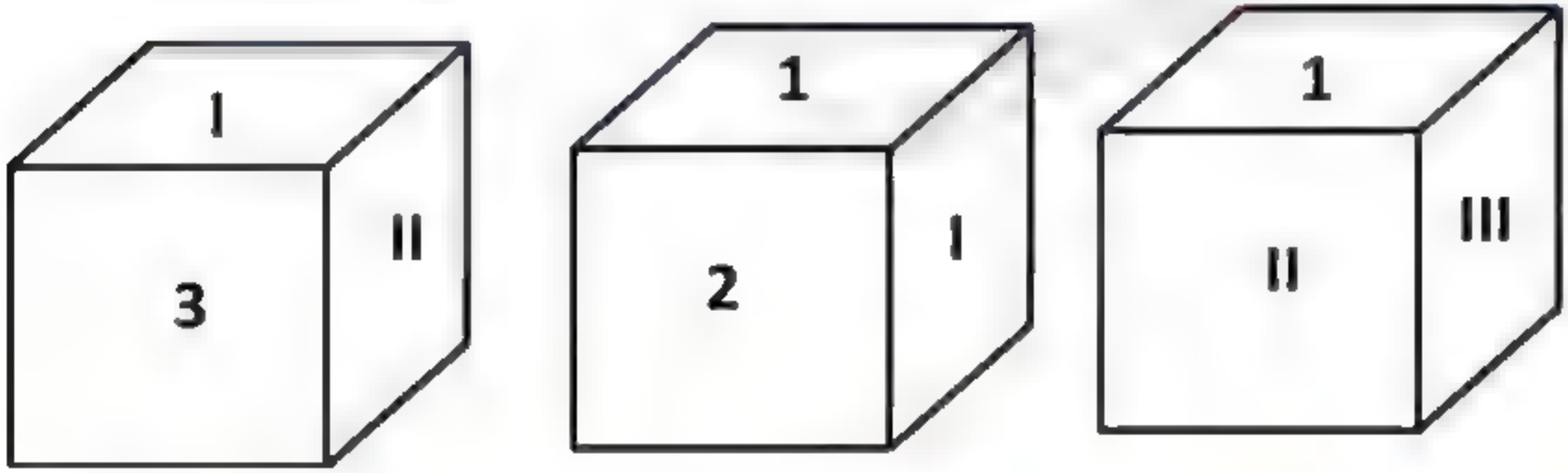

IGacademy Download App in PlayStore SUBSCRIBE IshwarGiri ಪಾಠಶಾಲೆ 8660070677

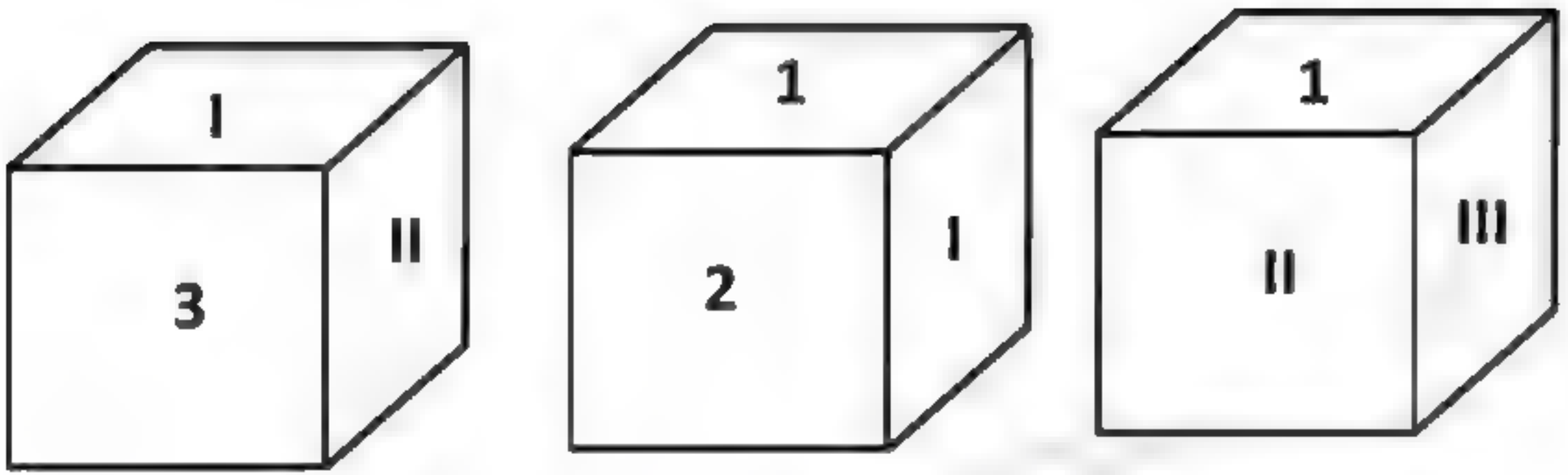

IGacademy Download App in PlayStore SUBSCRIBE IshwarGiri ಪಾಠಶಾಲೆ 8660070677

Q. Find opposite face of symbol ' # '

' # ' ರ ಅಭಿಮುಖ ಚಿಹ್ನೆಯನ್ನು ಕಂಡುಹಿಡಿಯಿರಿ.

a)+ b) - c)! d)%

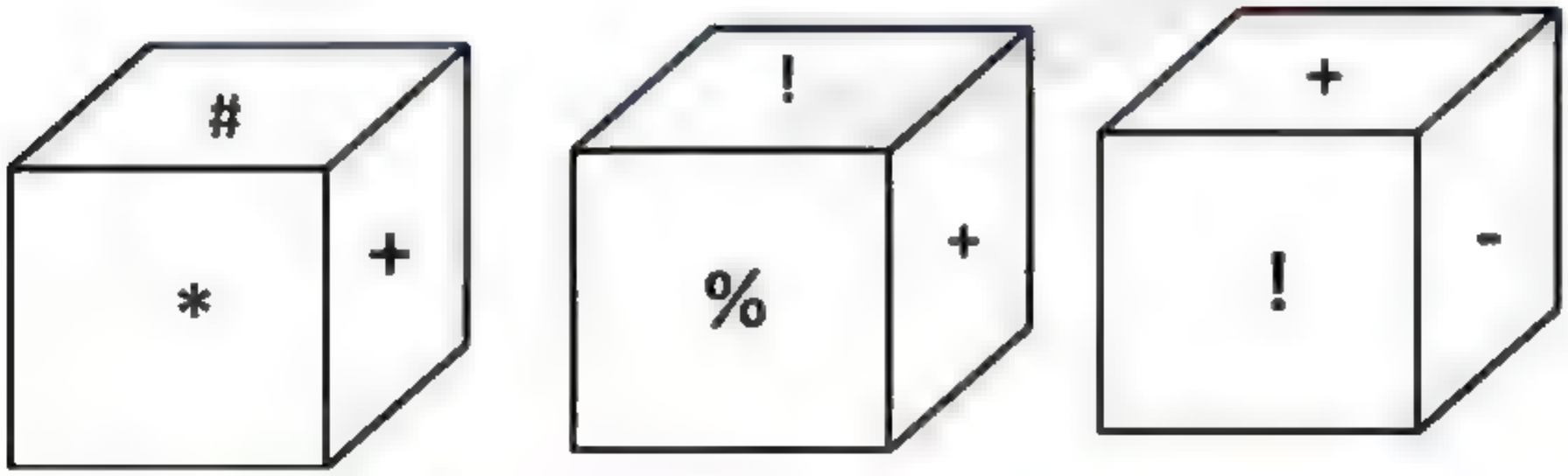

iGacademy Download App in PlayStore | SUBSCRIBE IshwarGiri ಪಾಠಶಾಲೆ | 8660070677

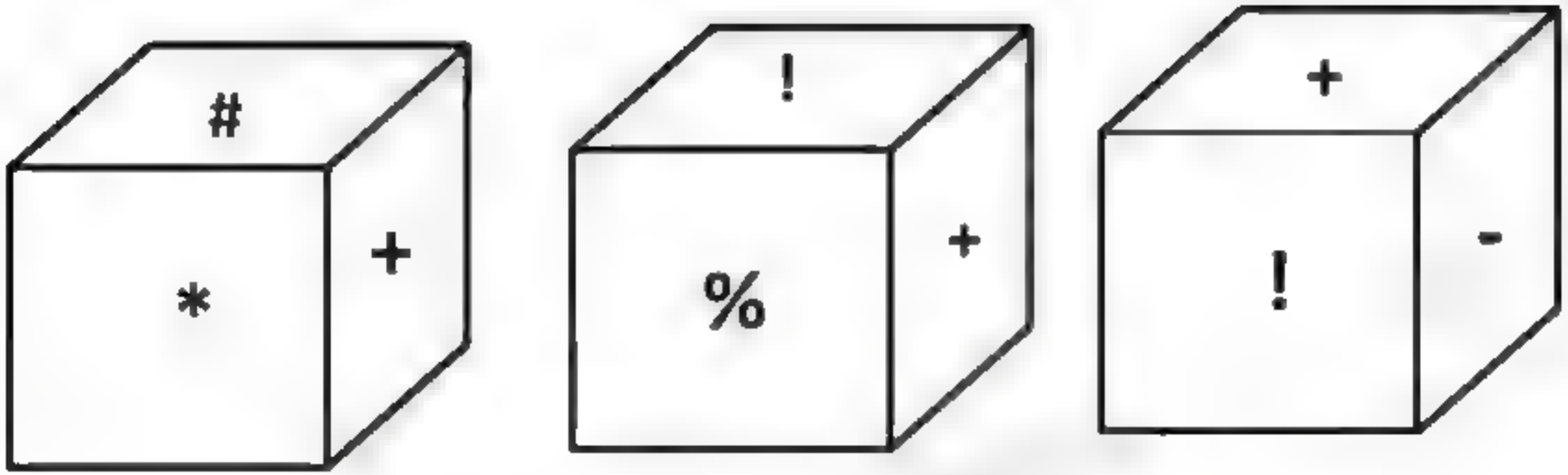

IGacademy Download App in PlayStore SUBSCRIBE IshwarGiri ಪಾಠಶಾಲೆ 8660070677

Q. A dice with six faces is marked with dots 1, 2, 3, 4, 5 and 6 respectively. This dice is rolled three times and three positions are shown as:
Find the number opposite to 6.

ಆರು ಮುಖಗಳನ್ನು ಹೊಂದಿರುವ ದಾಳವನ್ನು ಕ್ರಮವಾಗಿ 1, 2, 3, 4, 5 ಮತ್ತು 6 ಚುಕ್ಕೆಗಳೊಂದಿಗೆ ಗುರುತಿಸಲಾಗಿದೆ. ಈ ದಾಳವನ್ನು ಮೂರು ಬಾರಿ ಉರುಳಿಸಲಾಗುತ್ತದೆ ಮತ್ತು ದಾಳದ ಮೂರು ಸ್ಥಿತಿಗಳನ್ನು ನೀಡಲಾಗಿದೆ: 6 ಚುಕ್ಕೆಗಳನ್ನು ಹೊಂದಿರುವ ಮುಖದ ಅಭಿಮುಖವನ್ನು ಹುಡುಕಿ

a)1
b)3
c)4
d)5

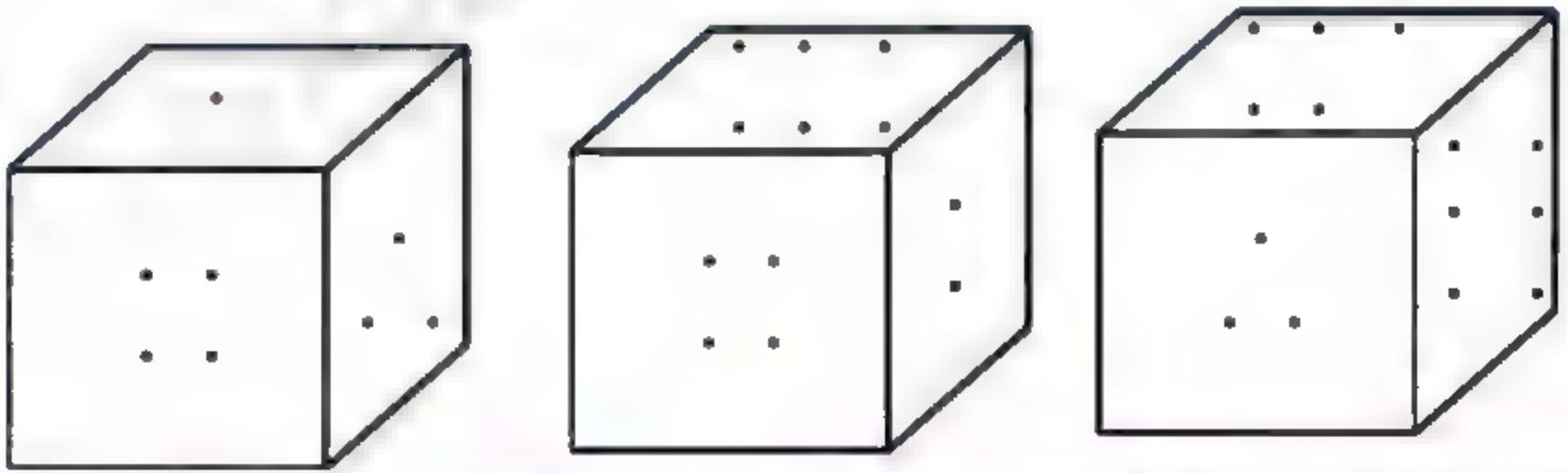

IGacademy Download App in PlayStore | SUBSCRIBE IshwarGiri ಪಾಠಶಾಲೆ | 8660070677

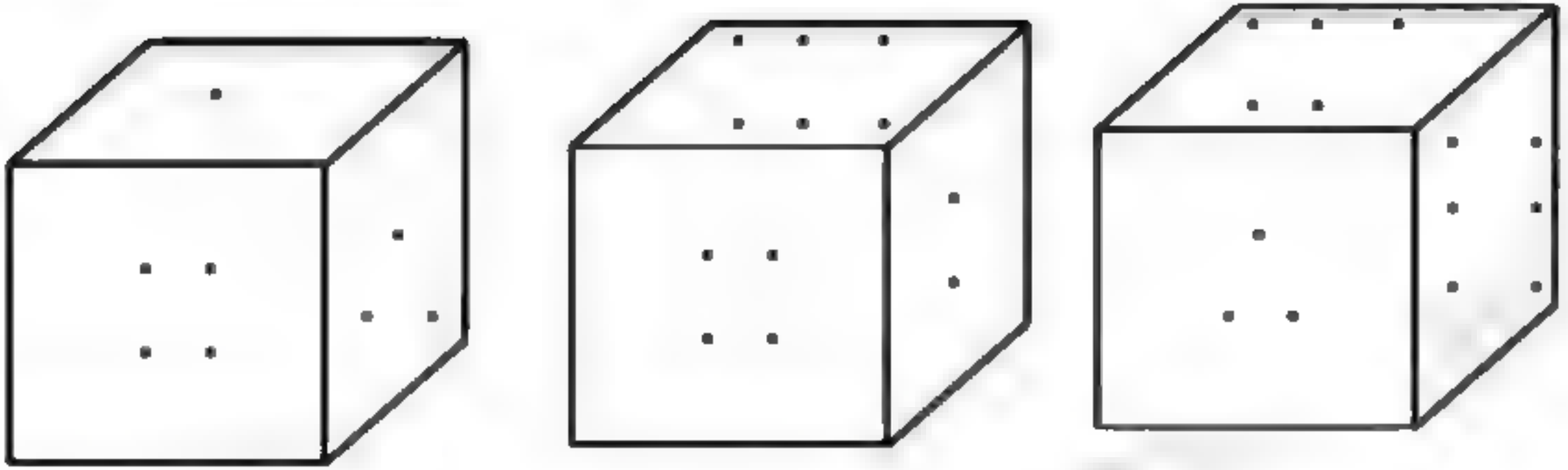

IGacademy Download App in PlayStore SUBSCRIBE IshwarGiri ಪಾಠಶಾಲೆ 8660070677

Q. Find the opposite colour of purple?
Purple ಬಣ್ಣದ ಅಭಿಮುಖ ಬಣ್ಣವನ್ನು ಗುರುತಿಸಿ.

a)Yellow **b)Green** **c)Orange** **d) Blue**

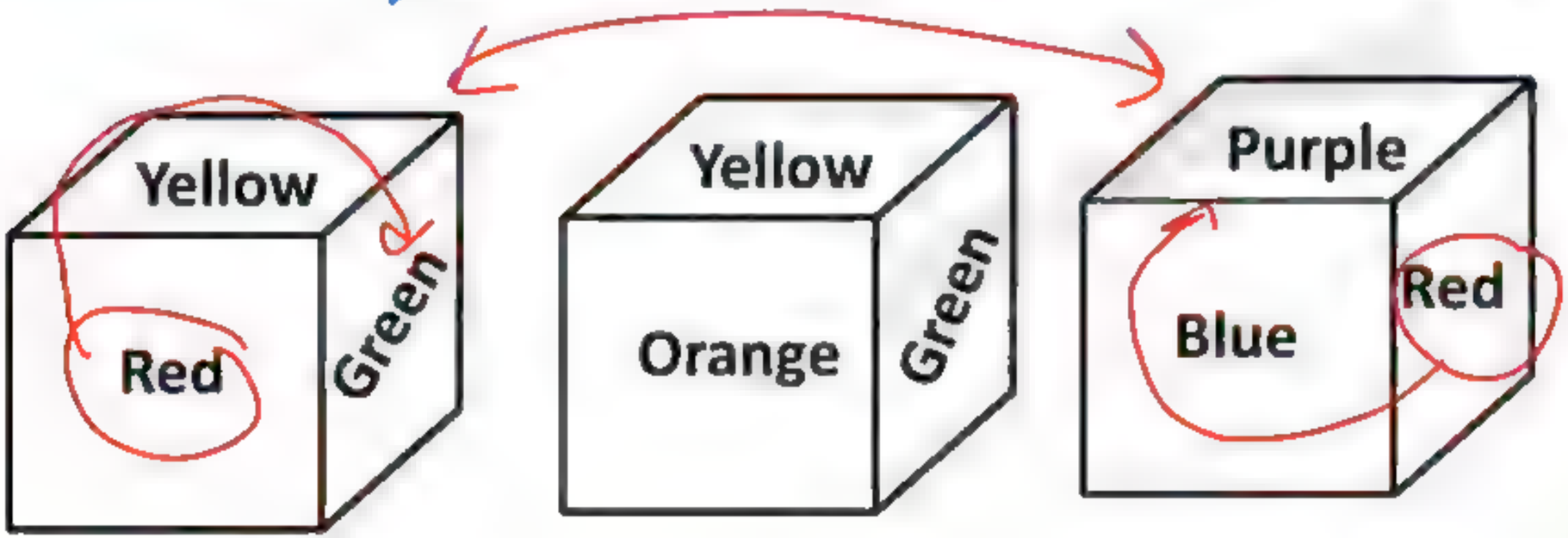

Red Red
Yellow Blue

Green – purple

IGacademy Download App in PlayStore | SUBSCRIBE IshwarGirl ಪಾಠಶಾಲೆ | 8660070677

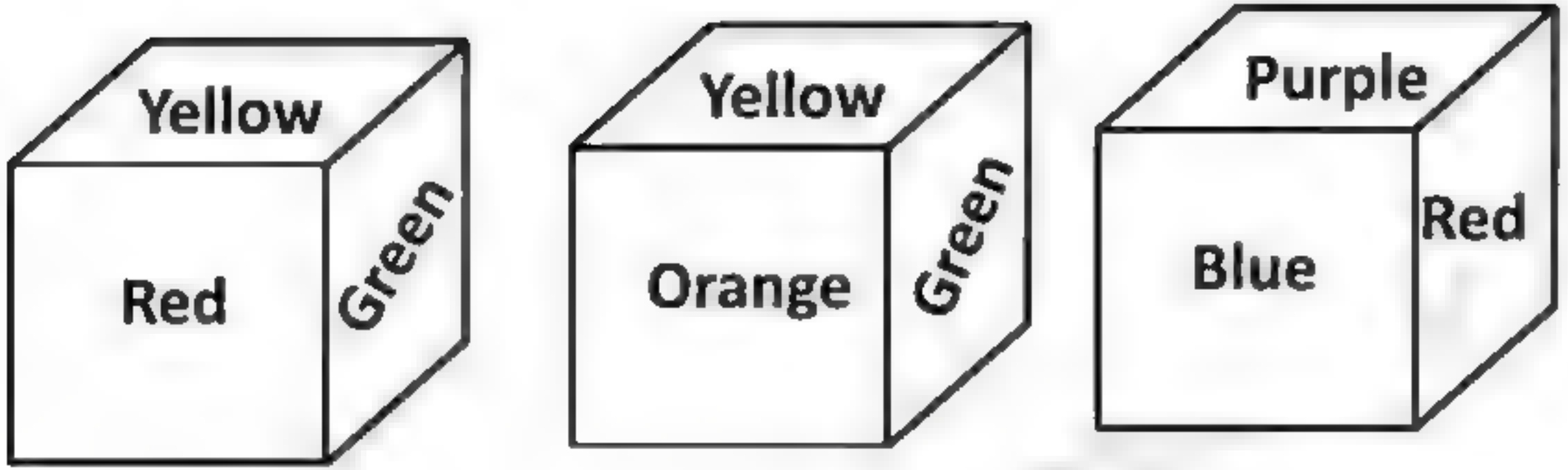

iGacademy Download App in PlayStore SUBSCRIBE IshwarGirl ಪಾಠಶಾಲೆ 8660070677

Q. Find the opposite colour of Green?
Green ಬಣ್ಣದ ವಿರುದ್ಧ ಬಣ್ಣವನ್ನು ಗುರುತಿಸಿ.

a)Red **b) Orange** **c) Blue** **d)Yellow**

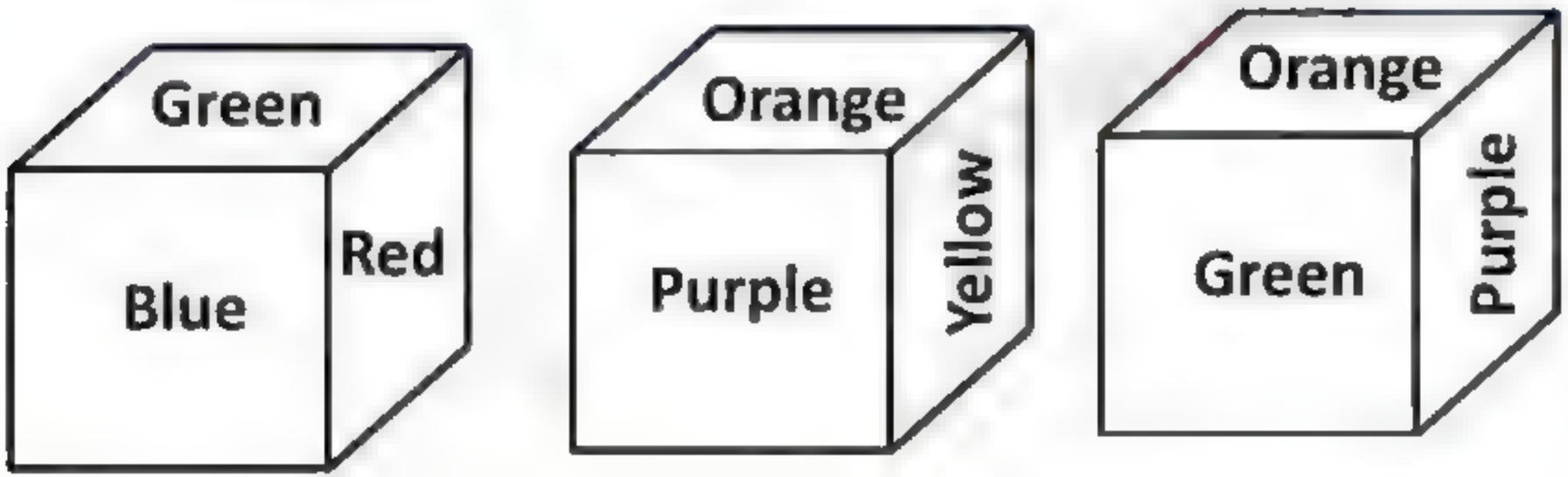

IGacademy Download App in PlayStore SUBSCRIBE IshwarGiri ಪಾಠಶಾಲೆ 8660070677

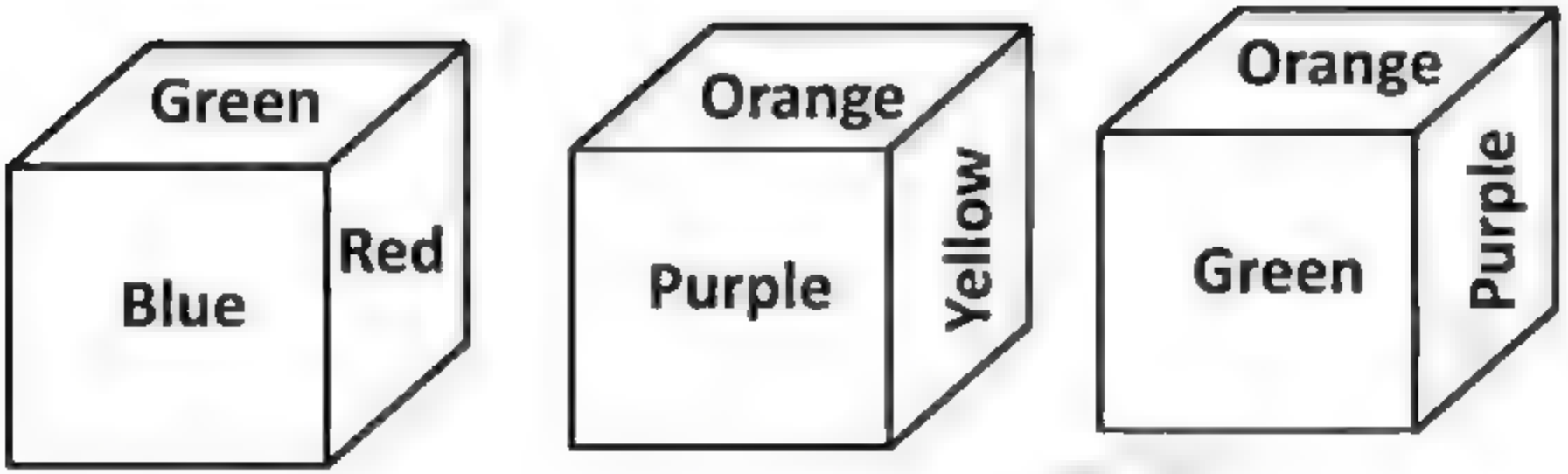

IGacademy Download App in PlayStore SUBSCRIBE IshwarGirl ಪಾಠಶಾಲೆ 8660070677

Q) Three forms of a dice are shown below. In this dice which dot will be on the surface opposite to the dot 1?

ದಾಳದ ಮೂರು ರೂಪಗಳನ್ನು ಕೆಳಗೆ ತೋರಿಸಲಾಗಿದೆ. ಈ ದಾಳದಲ್ಲಿ ಚುಕ್ಕೆ 1 ಕ್ಕೆ ವಿರುದ್ಧವಾದ ಮೇಲ್ಮೈಯಲ್ಲಿ ಎಷ್ಟು ಚುಕ್ಕೆ ಇರುತ್ತದೆ?

(A) 4 (B) 5 (C) 6 (D) 3



(i) (ii) (iii)

IGacademy Download App in PlayStore SUBSCRIBE IshwarGiri ಪಾಠಶಾಲೆ 8660070677



(i)



(ii)



(iii)

IGacademy Download App in PlayStore | SUBSCRIBE IshwarGiri ಪಾಠಶಾಲೆ | 8660070677

Q. Notice the following dices. Based on these, find the number opposite of number 3

Q. ಈ ಕೆಳಗಿನ ದಾಳಗಳನ್ನು ಗಮನಿಸಿ. ಇವುಗಳ ಆಧಾರದ ಮೇಲೆ ಸಂಖ್ಯೆ 3 ಕ್ಕೆ ವಿರುದ್ಧವಾದ ಸಂಖ್ಯೆಯನ್ನು ಕಂಡುಹಿಡಿಯಿರಿ

a) 5 **b) 4** **c) 2** **d) 6**

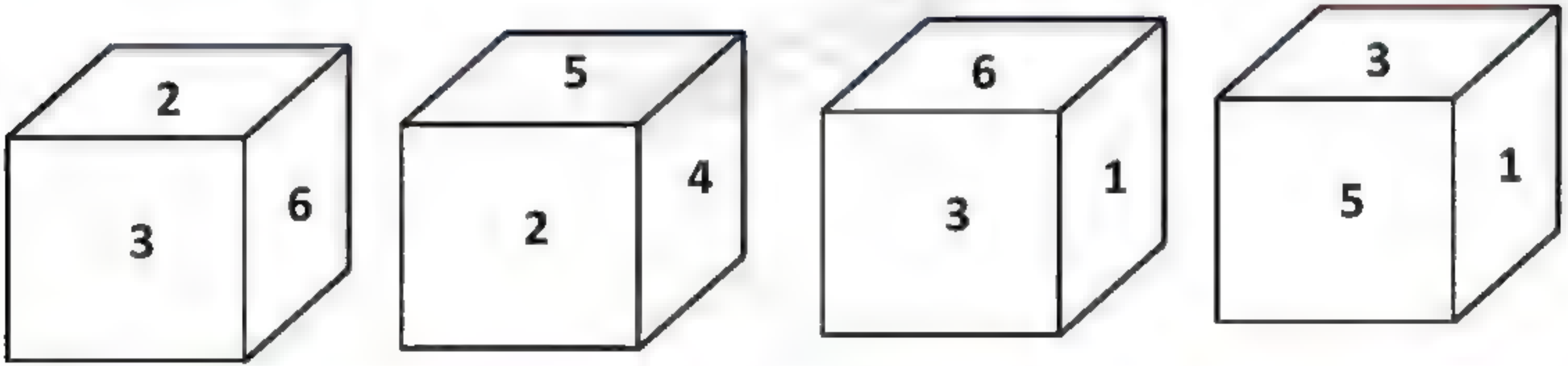

IGacademy Download App in PlayStore | SUBSCRIBE IshwarGiri ಪಾಠಶಾಲೆ | 8660070677

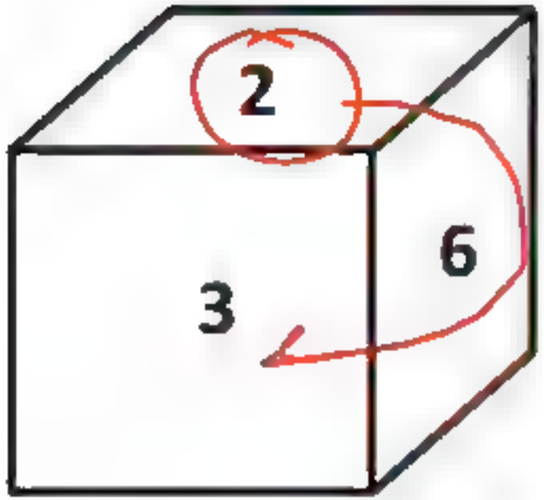

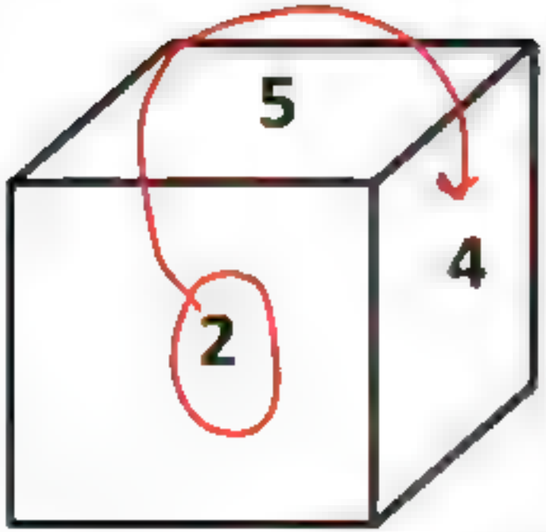

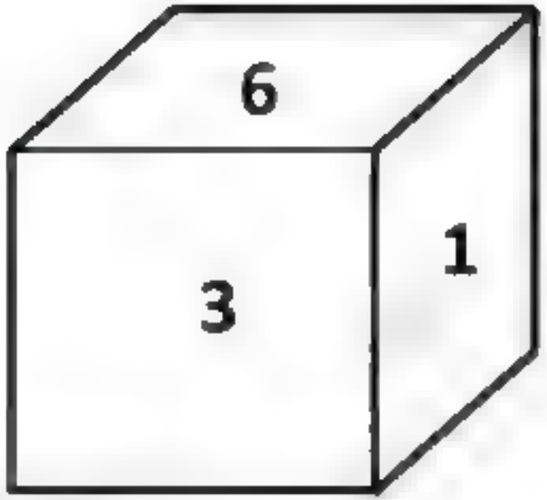

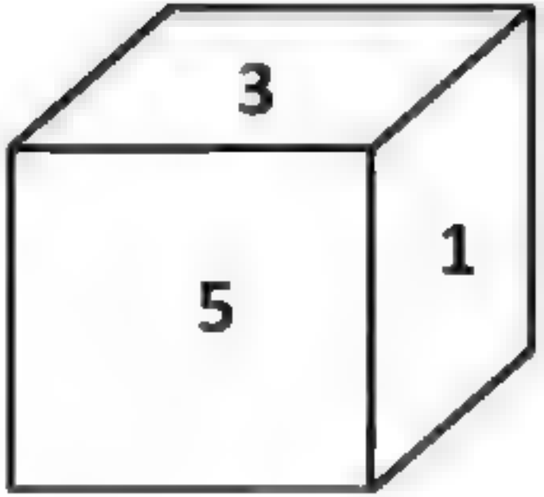

2 2

6 5

3 - 4

IGacademy Download App in PlayStore | SUBSCRIBE IshwarGirl ಪಾಠಶಾಲೆ | 8660070677

ESI - 2019

Q. What is the number opposite to 3 in the figure below

ಈ ಕೆಳಗೆ ಕೊಟ್ಟಿರುವ ಚಿತ್ರದಲ್ಲಿ 3 ಕ್ಕೆ ವಿರುದ್ಧವಾಗಿರುವ ಸಂಖ್ಯೆ ಯಾವುದು?

(a) 4 (b) 2 (c) 6 (d) 3





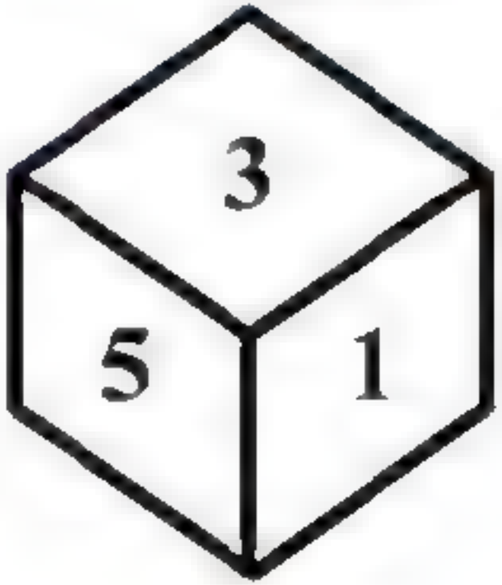

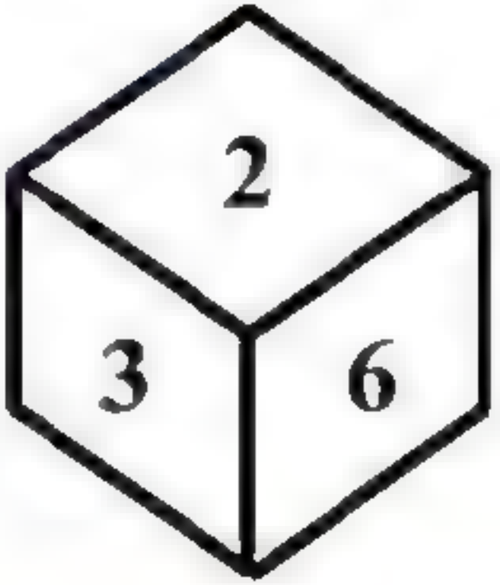

IGacademy Download App in PlayStore | SUBSCRIBE IshwarGiri ಪಾಠಶಾಲೆ | 8660070677





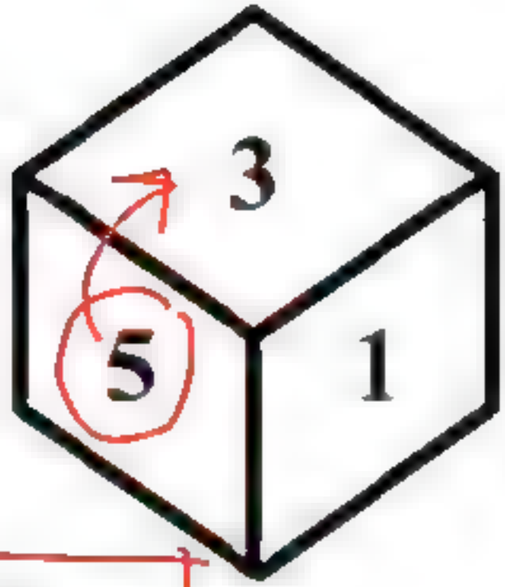

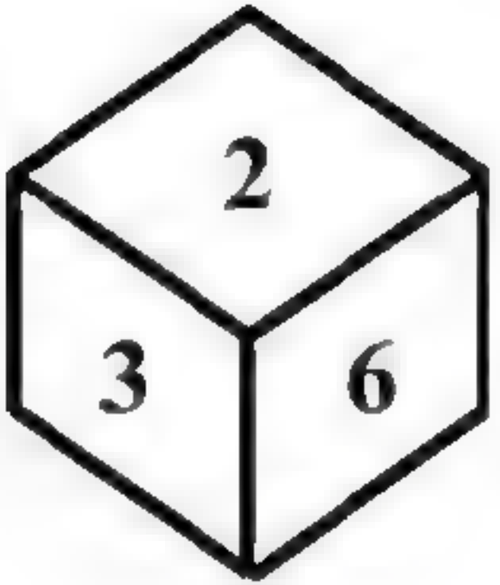

4 – 3

IGacademy Download App in PlayStore SUBSCRIBE IshwarGirl ಪಾಠಶಾಲೆ 8660070677

Q. Notice the following dices. Based on these, find the number opposite of number 3

Q. ಈ ಕೆಳಗಿನ ದಾಳಗಳನ್ನು ಗಮನಿಸಿ. ಇವುಗಳ ಆಧಾರದ ಮೇಲೆ ಸಂಖ್ಯೆ 3 ಕ್ಕೆ ವಿರುದ್ಧವಾದ ಸಂಖ್ಯೆಯನ್ನು ಕಂಡುಹಿಡಿಯಿರಿ

a) 4 **b) 2** **c) 6** **d) 5**

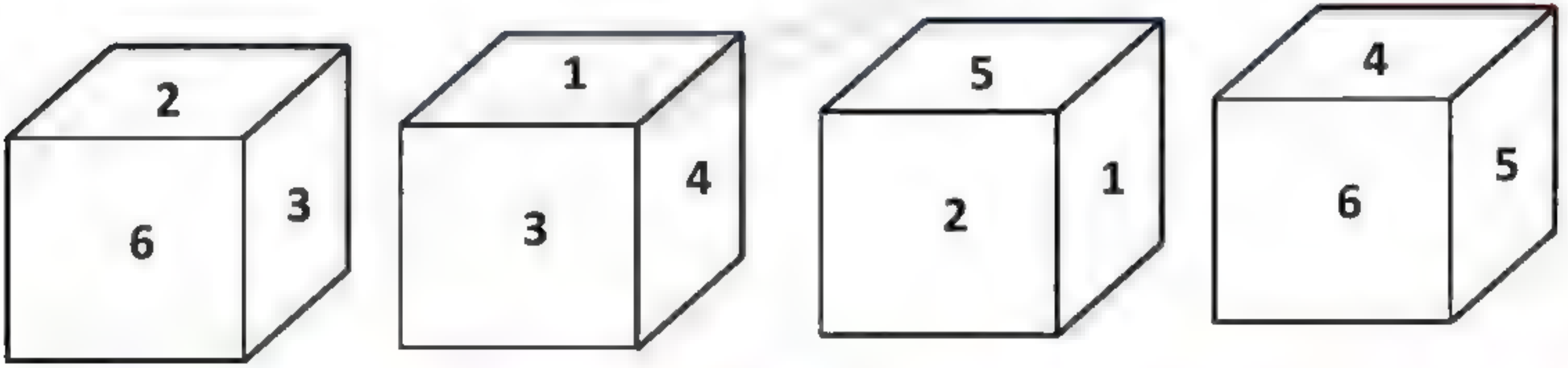

IGacademy Download App in PlayStore SUBSCRIBE IshwarGirl ಪಾಠಶಾಲೆ 8660070677

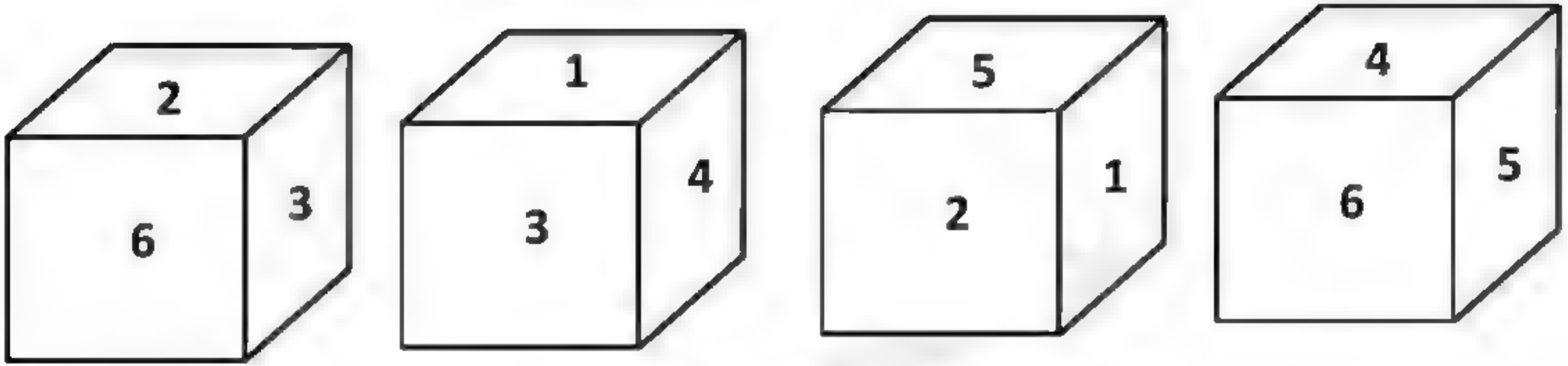

IGacademy Download App in PlayStore SUBSCRIBE IshwarGiri ಪಾಠಶಾಲೆ 8660070677

Q. Notice the following dices. Based on these, find the number opposite of number 4

Q. ಈ ಕೆಳಗಿನ ದಾಳಗಳನ್ನು ಗಮನಿಸಿ. ಇವುಗಳ ಆಧಾರದ ಮೇಲೆ ಸಂಖ್ಯೆ 4 ಕ್ಕೆ ವಿರುದ್ಧವಾದ ಸಂಖ್ಯೆಯನ್ನು ಕಂಡುಹಿಡಿಯಿರಿ

a) 5 b)2 c) 1 d) 6

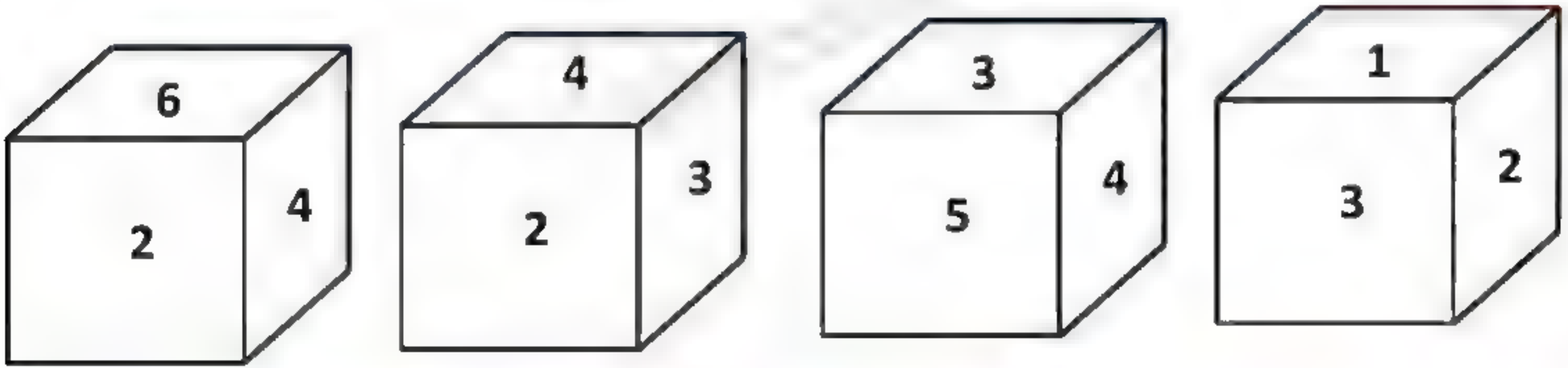

IGacademy Download App in PlayStore SUBSCRIBE IshwarGirl ಪಾಠಶಾಲೆ 8660070677

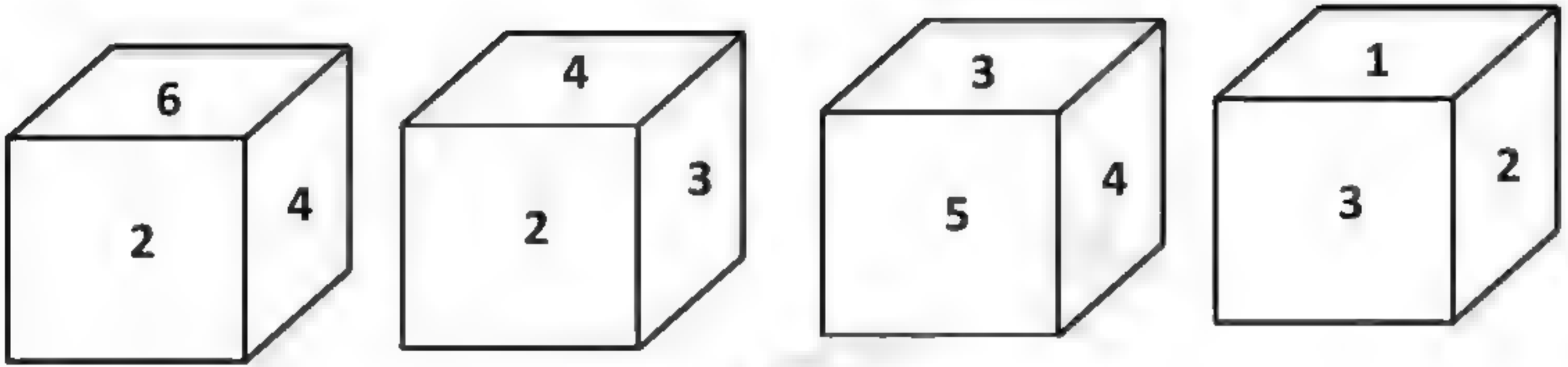

IGacademy Download App in PlayStore SUBSCRIBE IshwarGiri ಪಾಠಶಾಲೆ 8660070677

Q. Notice the following dices. Based on these, find the number opposite of number 5

Q. ಈ ಕೆಳಗಿನ ದಾಳಗಳನ್ನು ಗಮನಿಸಿ. ಇವುಗಳ ಆಧಾರದ ಮೇಲೆ ಸಂಖ್ಯೆ 5 ಕ್ಕೆ ವಿರುದ್ಧವಾದ ಸಂಖ್ಯೆಯನ್ನು ಕಂಡುಹಿಡಿಯಿರಿ

a) 1 **b) 2** **c) 6** **d) 3**

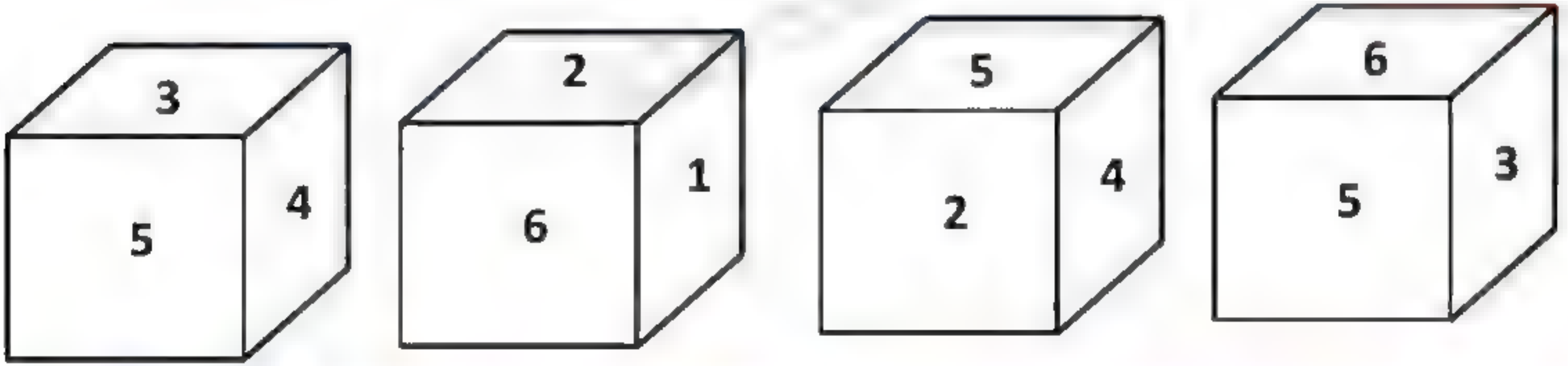

IGacademy Download App in PlayStore | SUBSCRIBE IshwarGirl ಪಾಠಶಾಲೆ | 8660070677

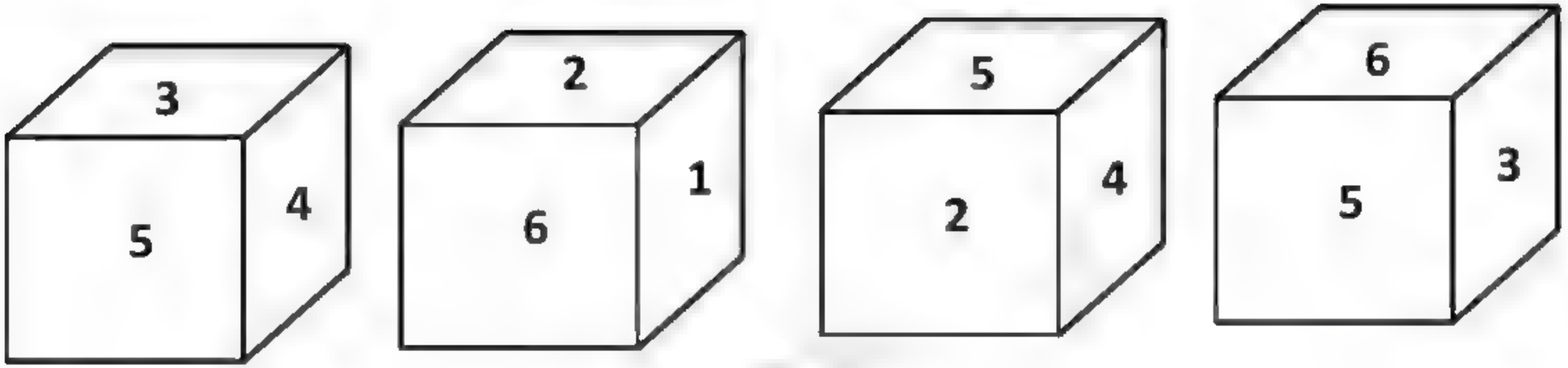

IGacademy Download App in PlayStore SUBSCRIBE IshwarGiri ಪಾಠಶಾಲೆ 8660070677

Q. Notice the following dices. Based on these, find the number opposite of number 6

Q. ಈ ಕೆಳಗಿನ ದಾಳಗಳನ್ನು ಗಮನಿಸಿ. ಇವುಗಳ ಆಧಾರದ ಮೇಲೆ ಸಂಖ್ಯೆ 6 ಕ್ಕೆ ವಿರುದ್ಧವಾದ ಸಂಖ್ಯೆಯನ್ನು ಕಂಡುಹಿಡಿಯಿರಿ

a) 2 **b) 5** **c) 4** **d) 2**

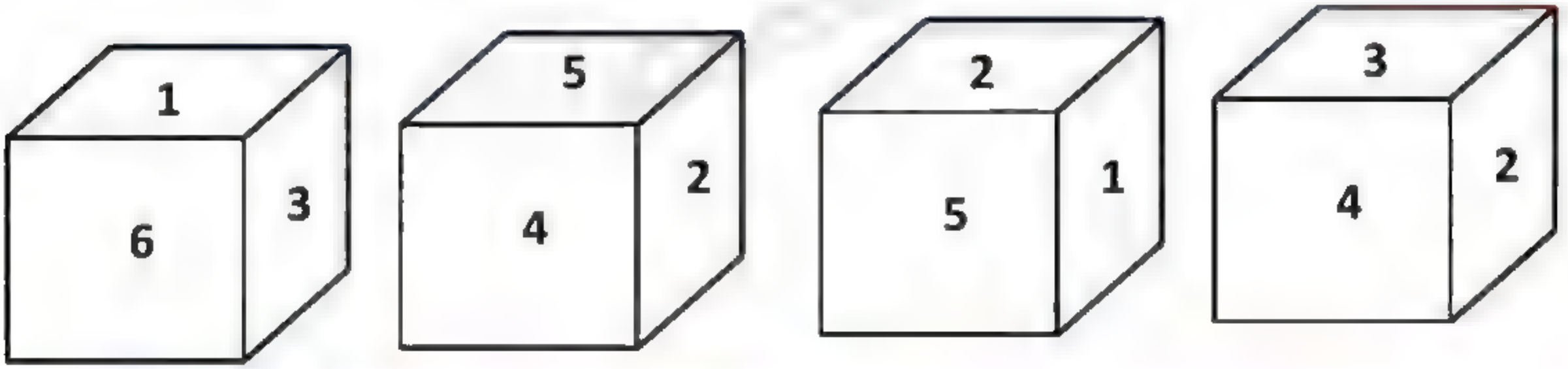

IGacademy Download App in PlayStore SUBSCRIBE IshwarGiri ಪಾಠಶಾಲೆ 8660070677

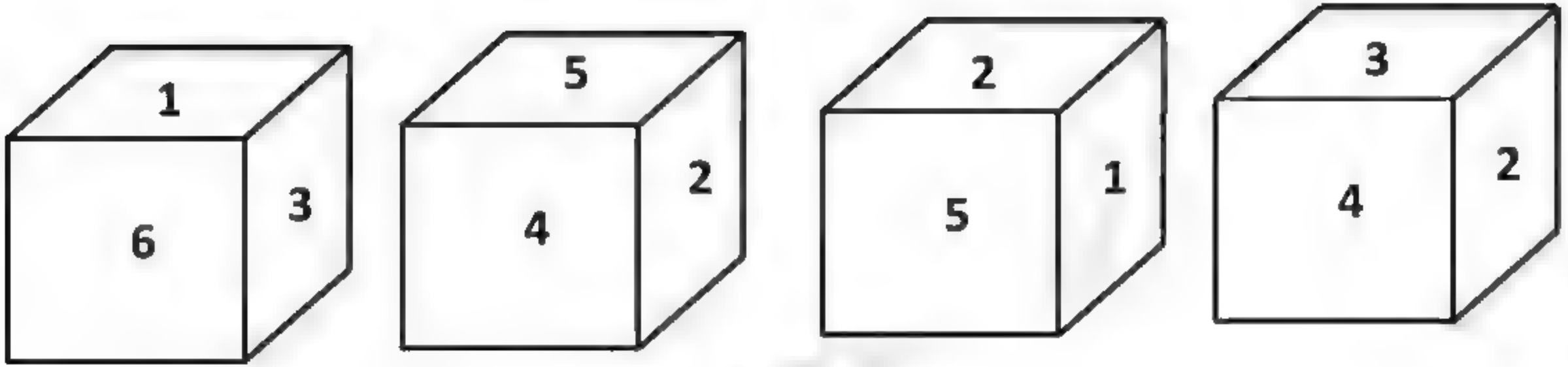

IGacademy Download App in PlayStore SUBSCRIBE IshwarGiri ಪಾಠಶಾಲೆ 8660070677

Q. Find the opposite colour of BLUE ?
BLUE ಬಣ್ಣದ ವಿರುದ್ಧ ಬಣ್ಣವನ್ನು ಗುರುತಿಸಿ.

a)White **b) Yellow** **c) Blue** **d)Grey**

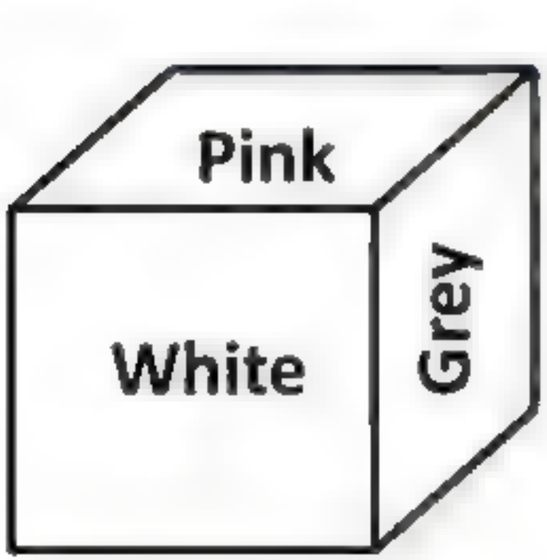

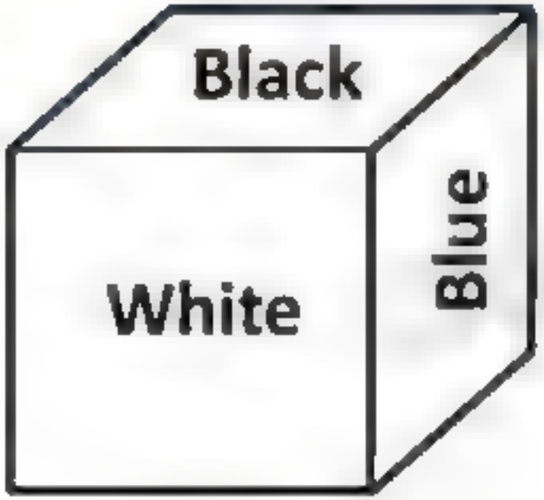

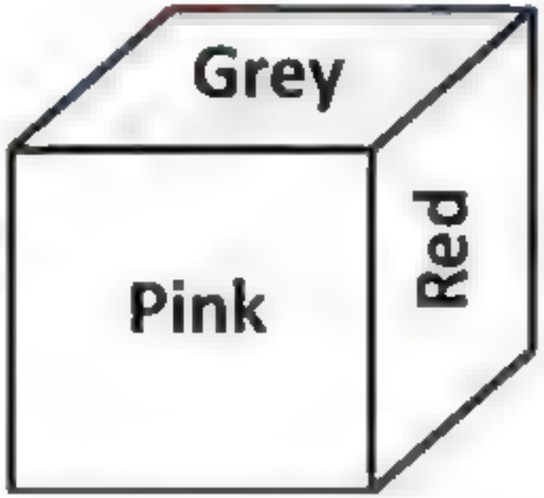

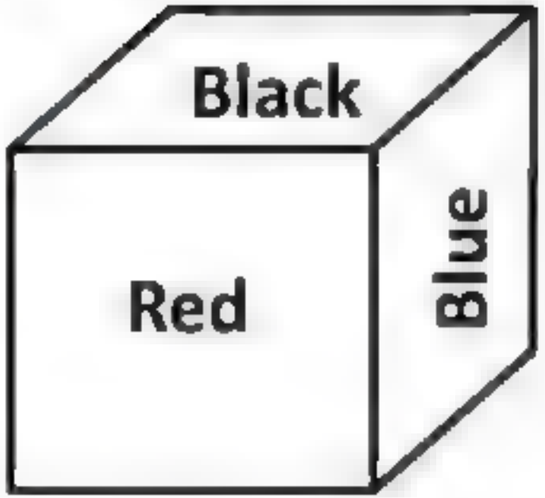

IGacademy Download App in PlayStore SUBSCRIBE IshwarGirl ಪಾಠಶಾಲೆ 8660070677

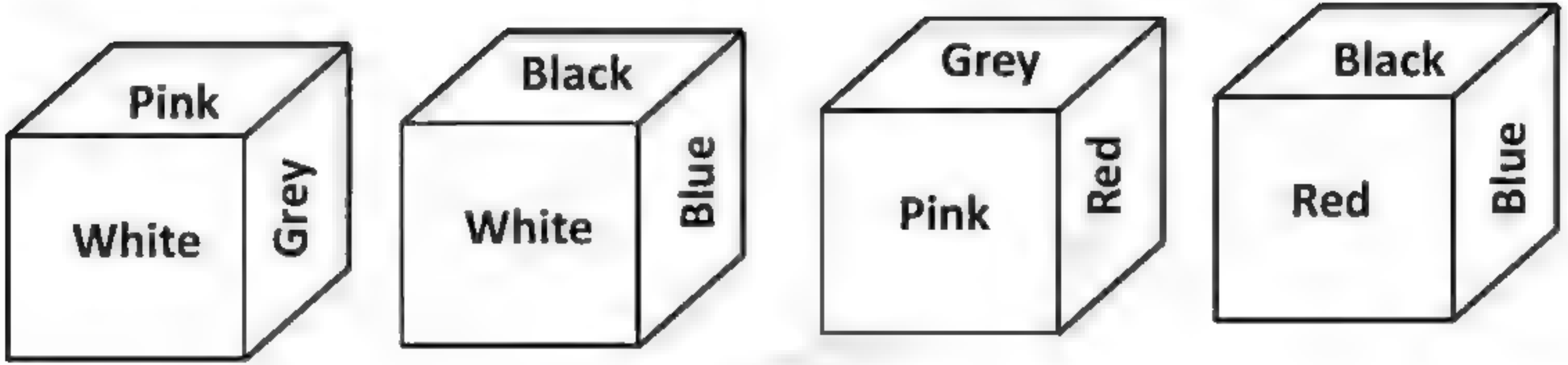

IGacademy Download App in PlayStore SUBSCRIBE IshwarGiri ಪಾಠಶಾಲೆ 8660070677

Q. Which colour is opposite to RED

RED ಬಣ್ಣದ ಅಭಿಮುಖ ಯಾವುದು

(a) Black (b) Yellow (c) Orange (d) Pink

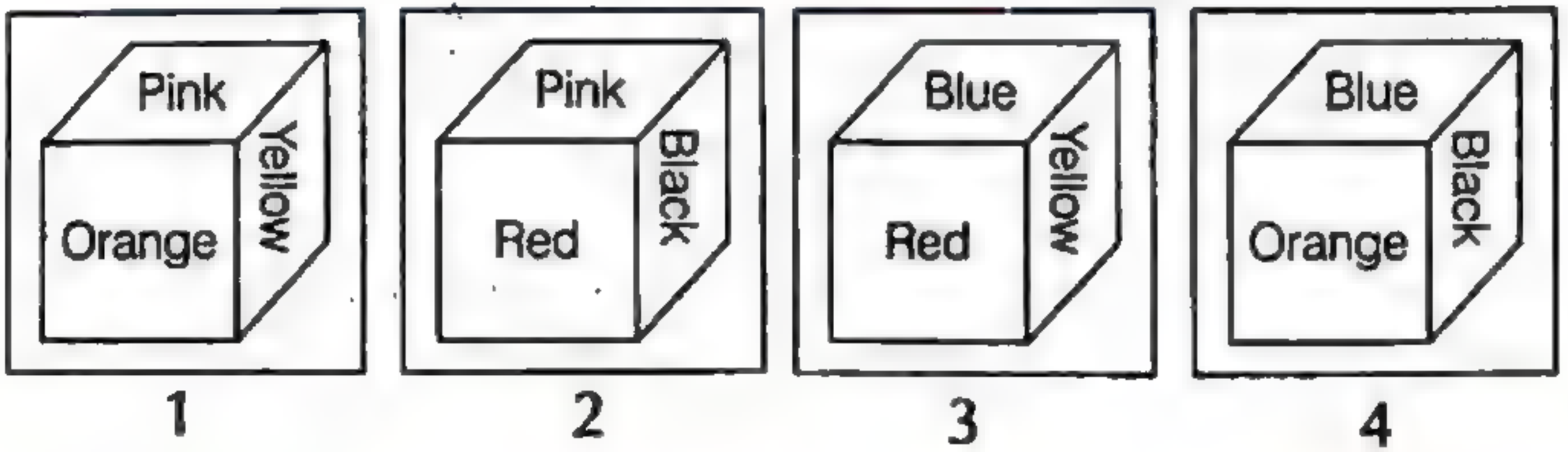

IGacademy Download App in PlayStore SUBSCRIBE IshwarGiri ಪಾಠಶಾಲೆ 8660070677

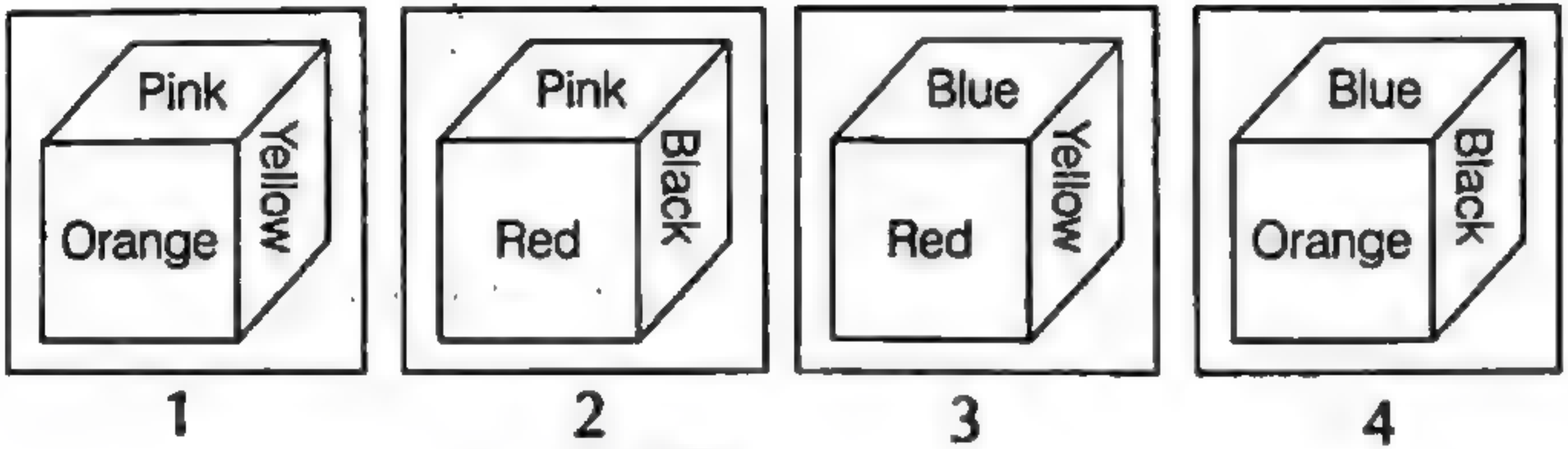

IGacademy Download App in PlayStore SUBSCRIBE IshwarGiri ಪಾಠಶಾಲೆ 8660070677

Q. Find the opposite symbol of ' * '

' * ' ನ ಅಭಿಮುಖ ಚಿಹ್ನೆಯನ್ನು ಕಂಡುಹಿಡಿಯಿರಿ.

a)÷ b)× c)% d)#

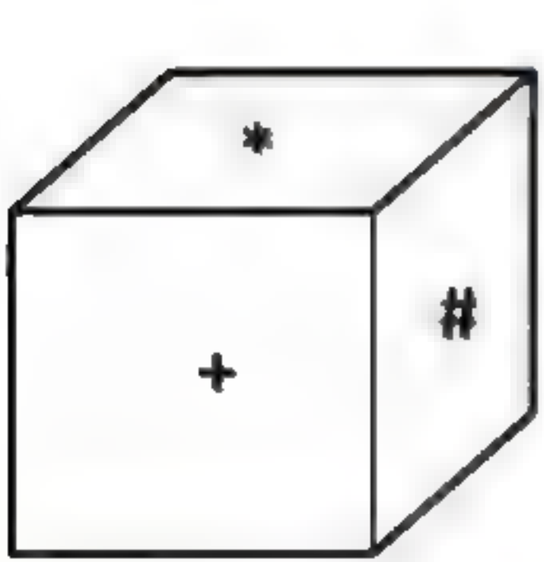

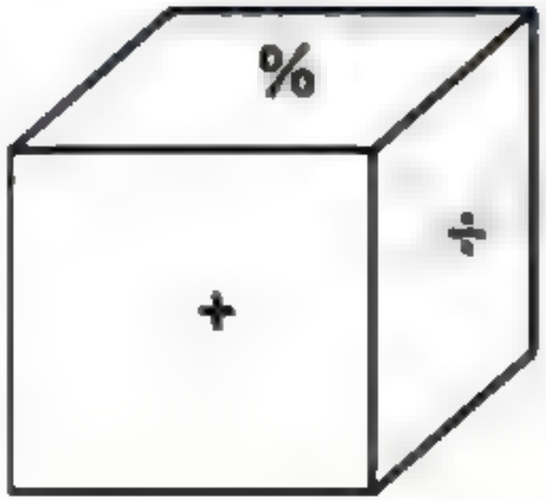

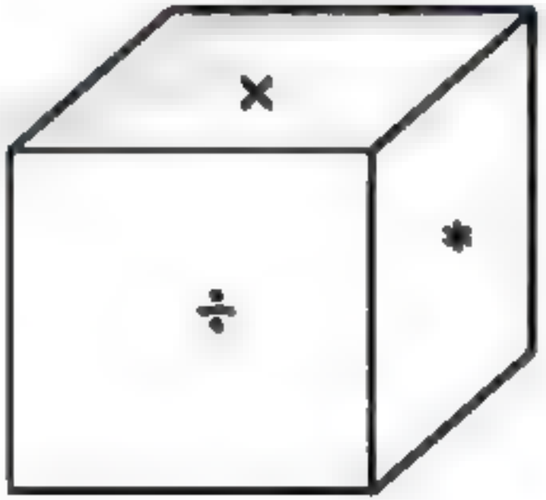

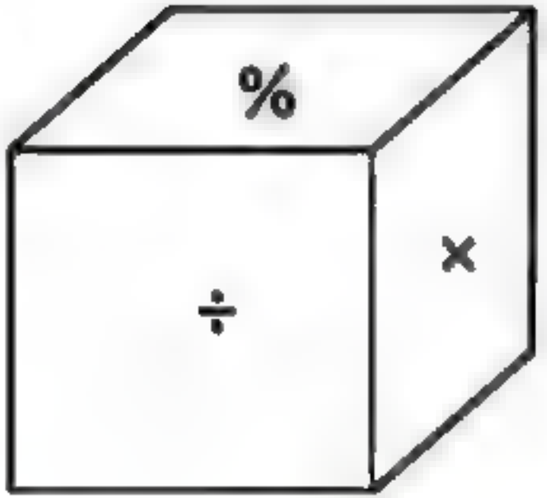

IGacademy Download App in PlayStore SUBSCRIBE IshwarGiri ಪಾಠಶಾಲೆ 8660070677

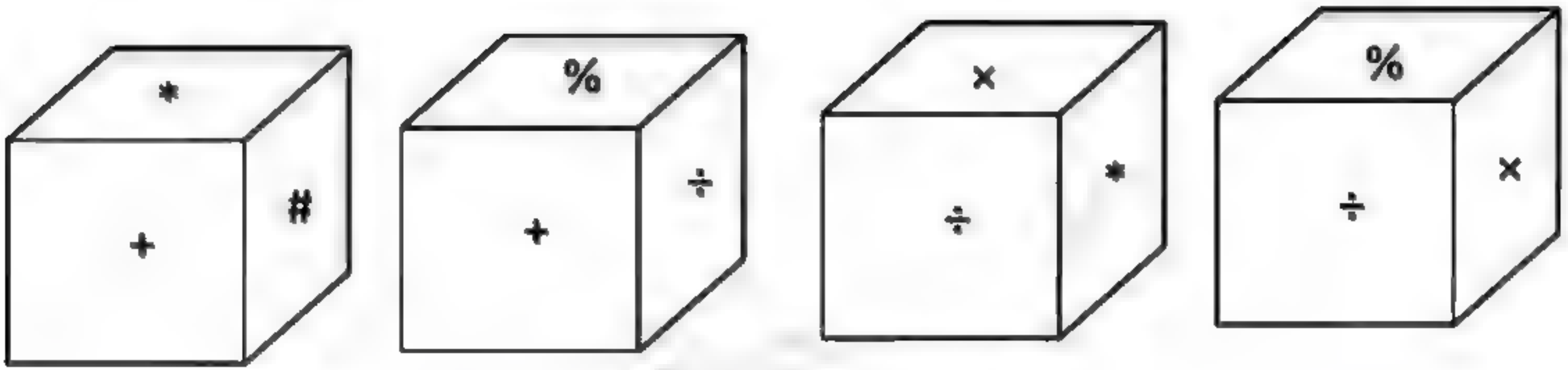

iGacademy Download App in PlayStore SUBSCRIBE IshwarGiri ಪಾಠಶಾಲೆ 8660070677

IAS – 2018

Q. What is the opposite face of the face with a dot in the picture above?

Q. ಈ ಮೇಲಿನ ಚಿತ್ರದಲ್ಲಿ ಒಂದು ಚುಕ್ಕೆ ಇರುವ ಮುಖದ ವಿರುದ್ಧ ಮುಖ ಯಾವುದು

a) 4 ಚುಕ್ಕಿ b) 3 ಚುಕ್ಕೆ c) 2 ಚುಕ್ಕೆ d) ಗೆರೆ

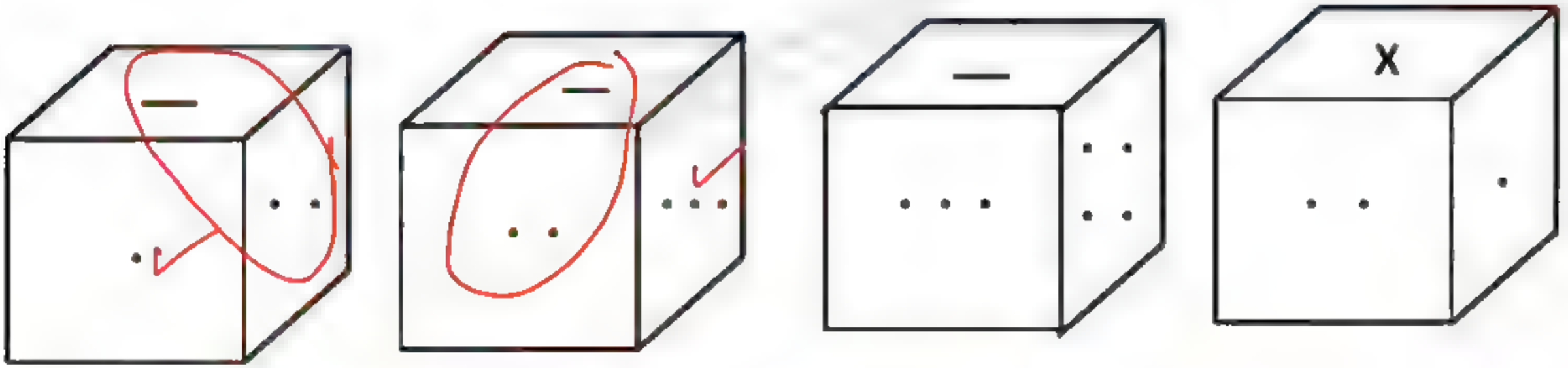

1 — 3

IGacademy Download App in PlayStore | SUBSCRIBE IshwarGirl ಪಾಠಶಾಲೆ | 8660070677

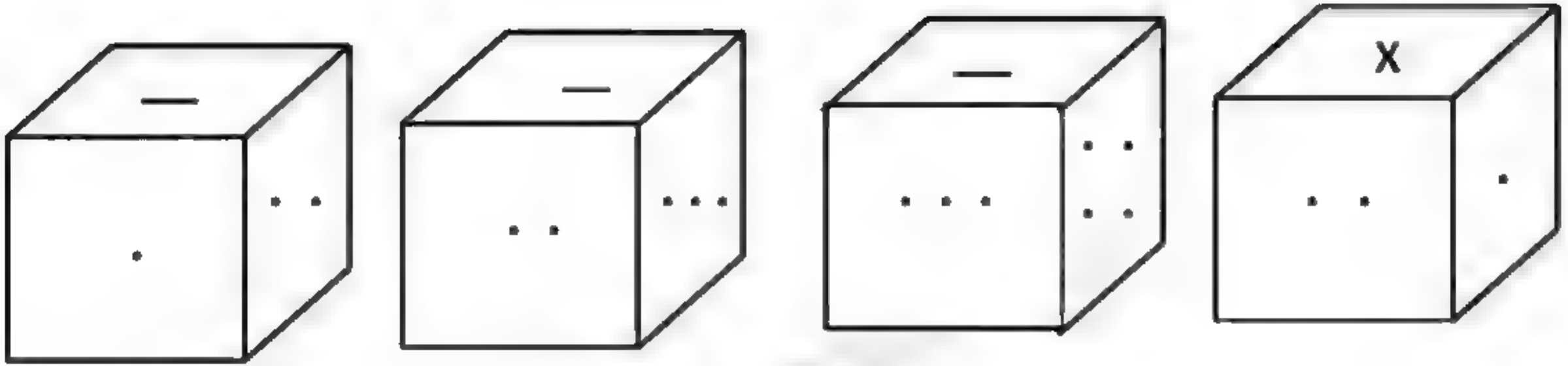

IGacademy Download App in PlayStore SUBSCRIBE IshwarGiri ಪಾಠಶಾಲೆ 8660070677

IAS – 2018

Q. What is the opposite face of the face with a dot in the picture above?

Q. ಈ ಮೇಲಿನ ಚಿತ್ರದಲ್ಲಿ ಎರಡು ಚುಕ್ಕೆ ಇರುವ ಮುಖದ ವಿರುದ್ಧ ಮುಖ ಯಾವುದು

a) 1 ಚುಕ್ಕೆ **b) 3 ಚುಕ್ಕೆ** **c) ನಾಲ್ಕು ಚುಕ್ಕಿ** **d) ಗೆರೆ**

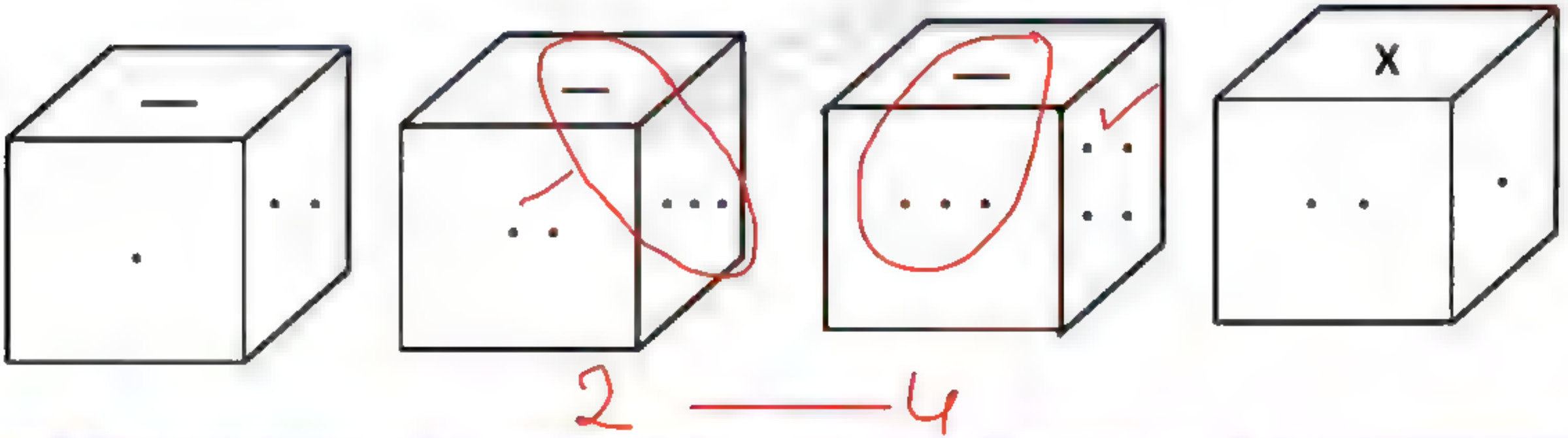

IGacademy Download App in PlayStore | SUBSCRIBE IshwarGirl ಪಾಠಶಾಲೆ | 8660070677

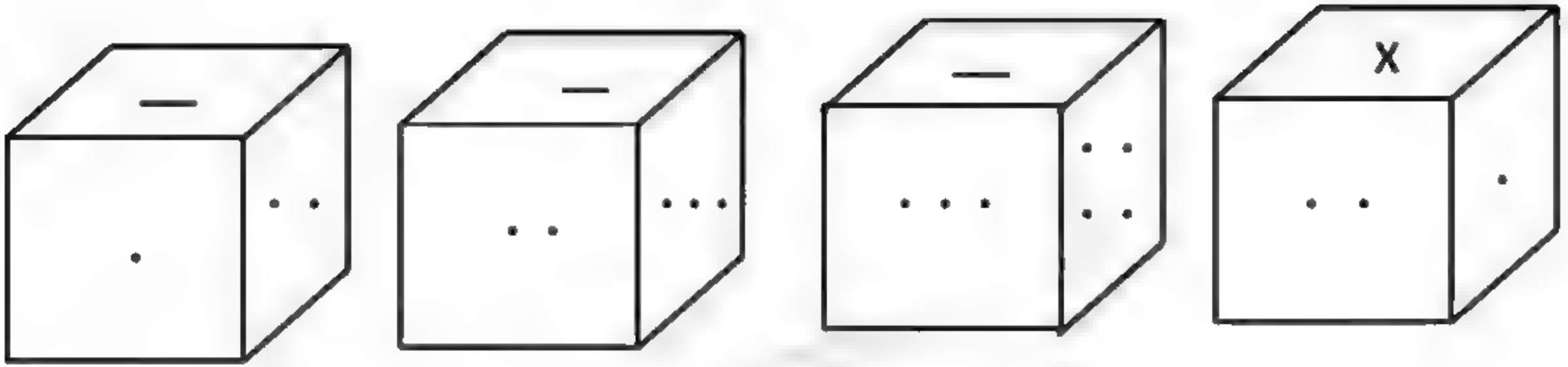

IGacademy Download App in PlayStore SUBSCRIBE IshwarGiri ಪಾಠಶಾಲೆ 8660070677

IAS – 2018

Q. What is the opposite face of the face with X in the picture above?

Q. ಈ ಮೇಲಿನ ಚಿತ್ರದಲ್ಲಿ X ಇರುವ ಮುಖದ ವಿರುದ್ಧ ಮುಖ ಯಾವುದು

a) 1 ಚುಕ್ಕೆ b) 2 ಚುಕ್ಕೆ c) ಗೆರೆ d) 4 ಚುಕ್ಕಿ

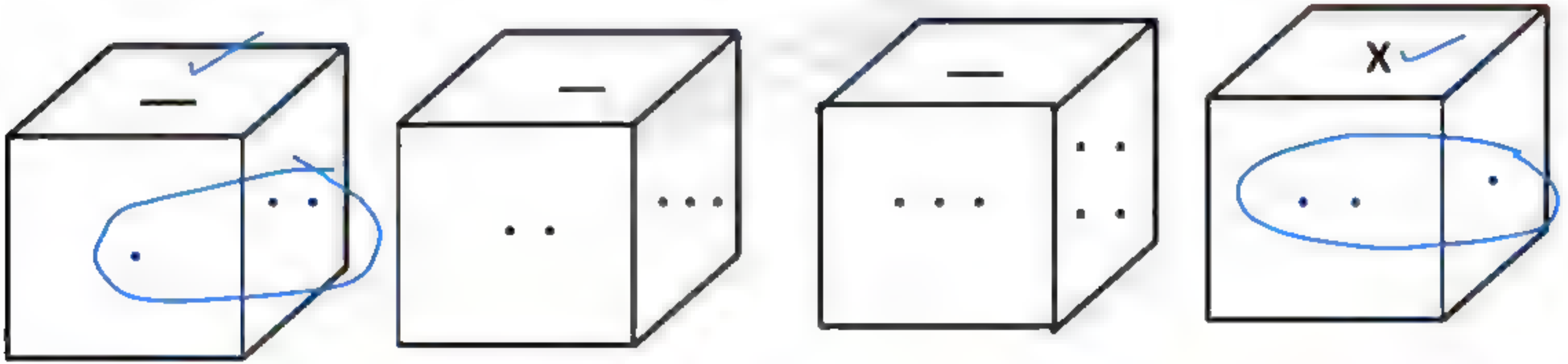

IGacademy Download App in PlayStore | SUBSCRIBE IshwarGirl ಪಾಠಶಾಲೆ | 8660070677

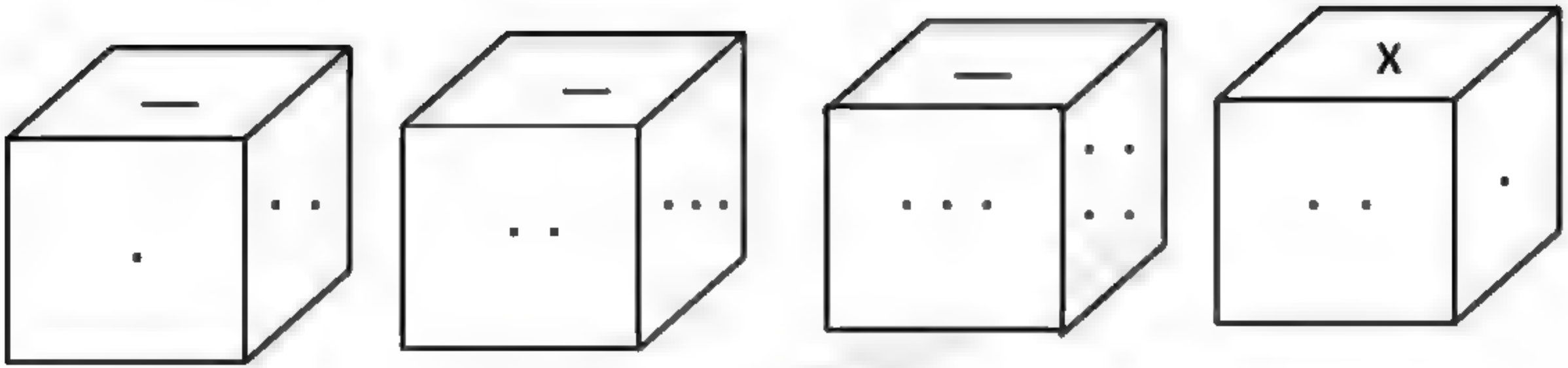

IGacademy Download App in PlayStore SUBSCRIBE IshwarGiri ಪಾಠಶಾಲೆ 8660070677

Q. Three states of dice are given in this picture

Q . ದಾಳದ ಮೂರು ರೂಪಗಳು ಈ ಚಿತ್ರದಲ್ಲಿವೆ

IAS - 2013

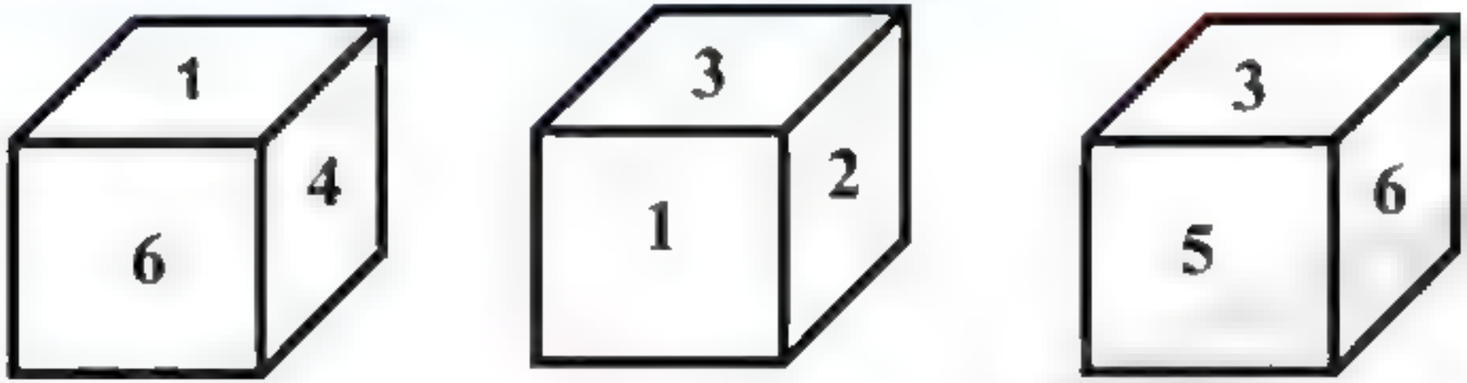

What are the numbers that come in the place of A and B in the following dice?

ಈ ಕೆಳಗಿನ ದಾಳದಲ್ಲಿ A ಮತ್ತು B ಯ ಸ್ಥಳದಲ್ಲಿ ಬರುವ ಸಂಖ್ಯೆಗಳು ಯಾವುವು

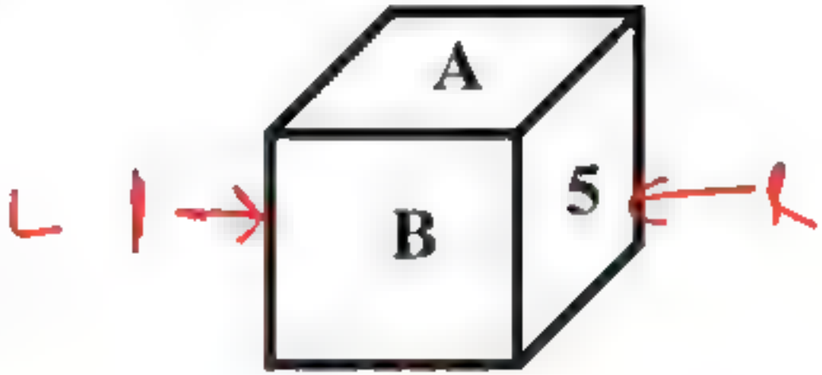

a) 2 ಮತ್ತು 3 b) 6 ಮತ್ತು 1 c) 1 ಮತ್ತು 4 d) 3 ಮತ್ತು 1

IGacademy Download App in PlayStore | SUBSCRIBE IshwarGiri ಪಾಠಶಾಲೆ | 8660070677

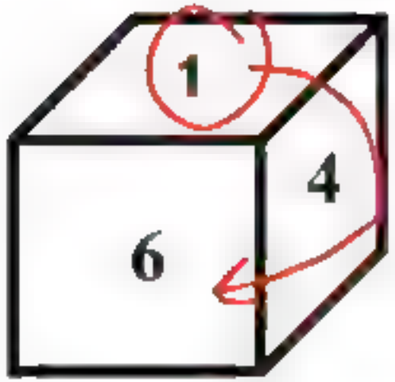

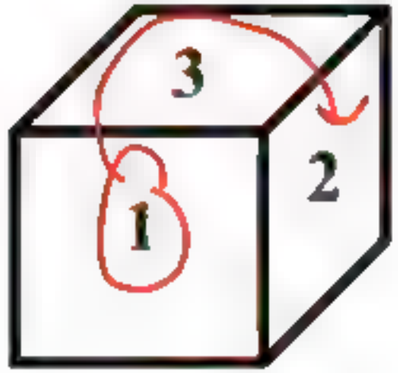

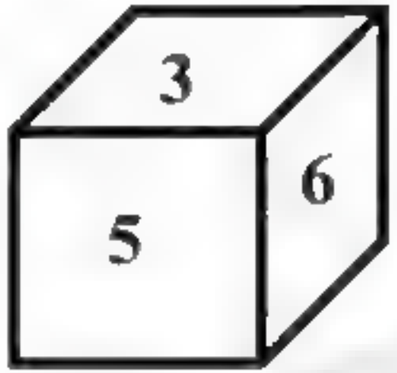

1 → ✕ (5)

4 → 3

6 → 2

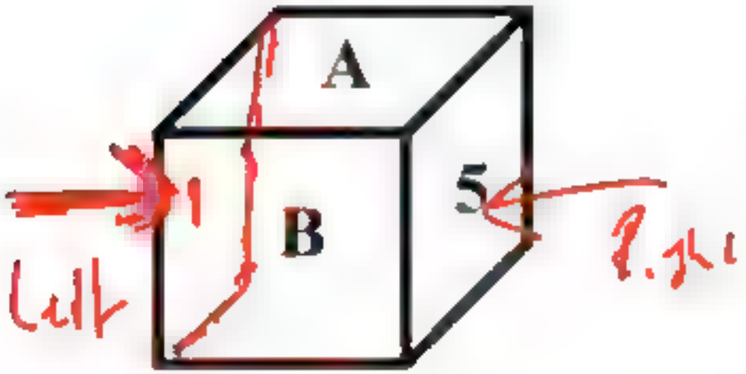

A = 1X

B = 1X

IGacademy Download App in PlayStore | SUBSCRIBE IshwarGiri ಪಾಠಶಾಲೆ | 8660070677

IGacademy Download App in PlayStore SUBSCRIBE IshwarGiri ಪಾಠಶಾಲೆ 8660070677

3 — 2



5 - 3

IGacademy Download App in PlayStore SUBSCRIBE IshwarGiri ಪಾಠಶಾಲೆ 8660070677

❖ **Type 2:** ಒಂದೇ ದಾಳದ ಎರಡು ಸ್ಥಿತಿಗಳನ್ನು ಕೊಟ್ಟಾಗ, ಎರಡು ಮುಖಗಳು ಸಾಮಾನ್ಯವಾಗಿದ್ದರೆ ಇನ್ನುಳಿದ ಮುಖಗಳು ಪರಸ್ಪರ ಅಭಿಮುಖವಾಗಿರುತ್ತವೆ.

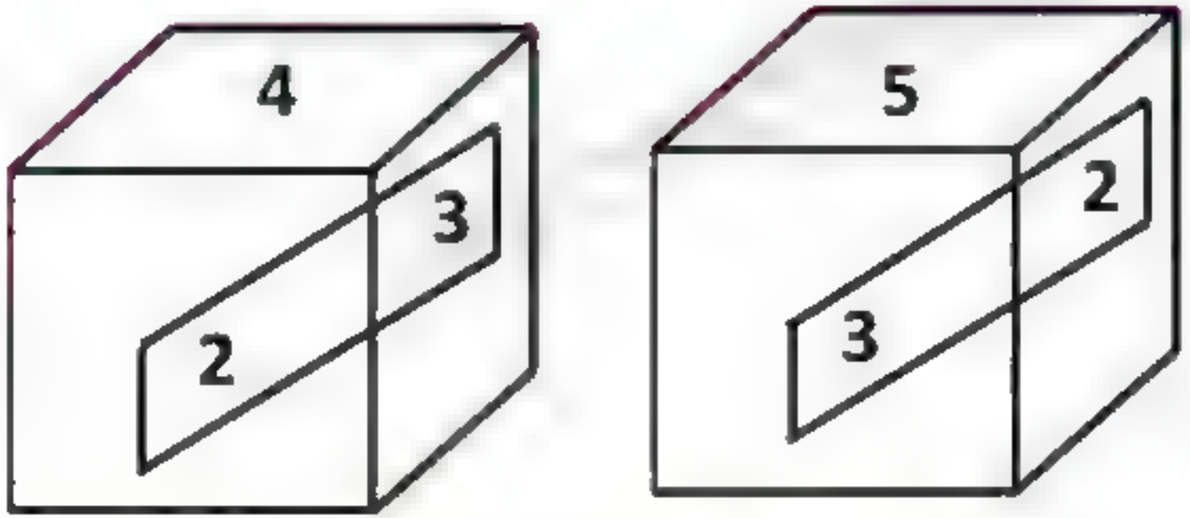

4 ⟷ 5

IGacademy Download App in PlayStore | SUBSCRIBE IshwarGirl ಪಾಠಶಾಲೆ | 8660070677

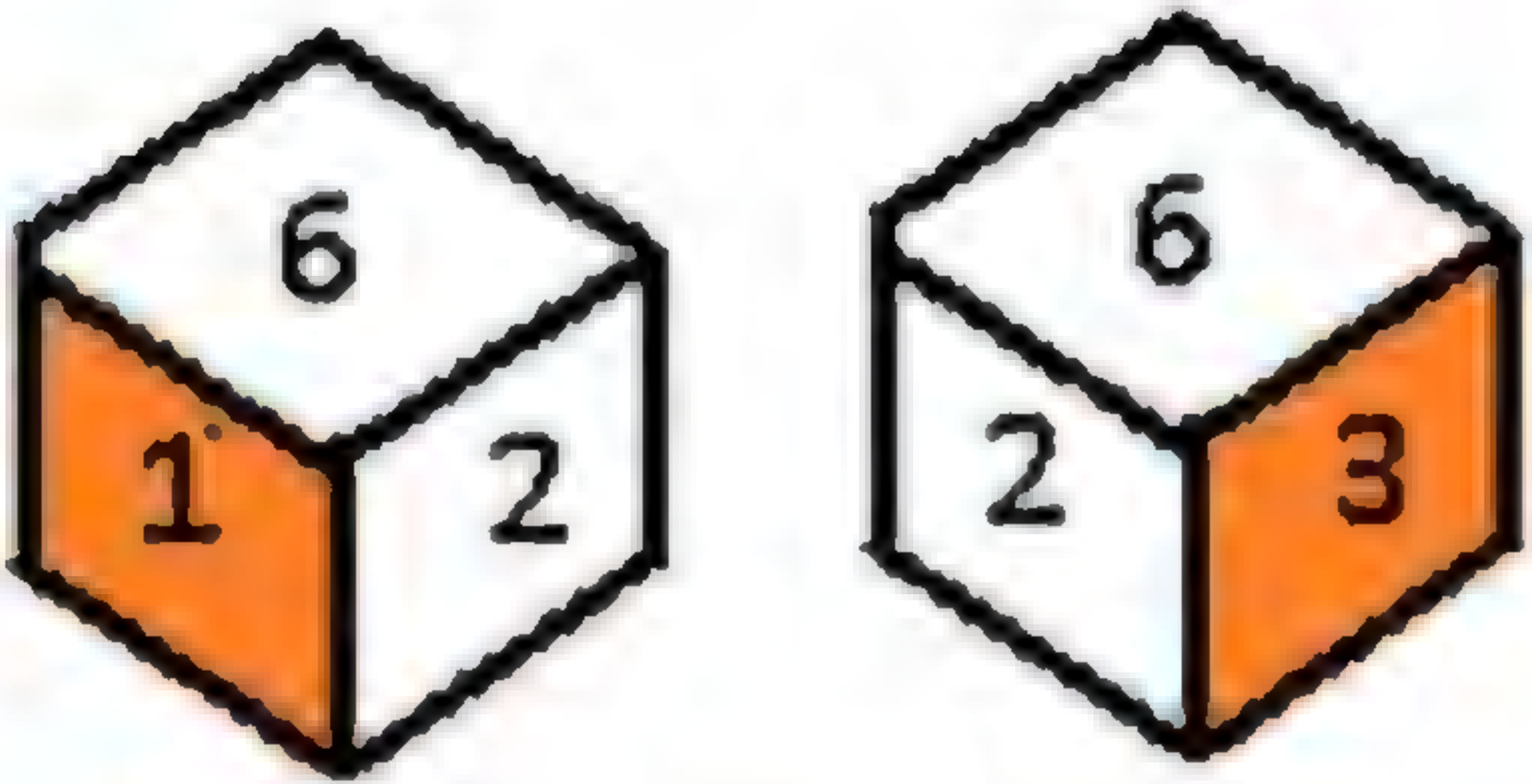

$1 \longleftrightarrow 3$

IGacademy Download App in PlayStore | SUBSCRIBE IshwarGiri ಪಾಠಶಾಲೆ | 8660070677

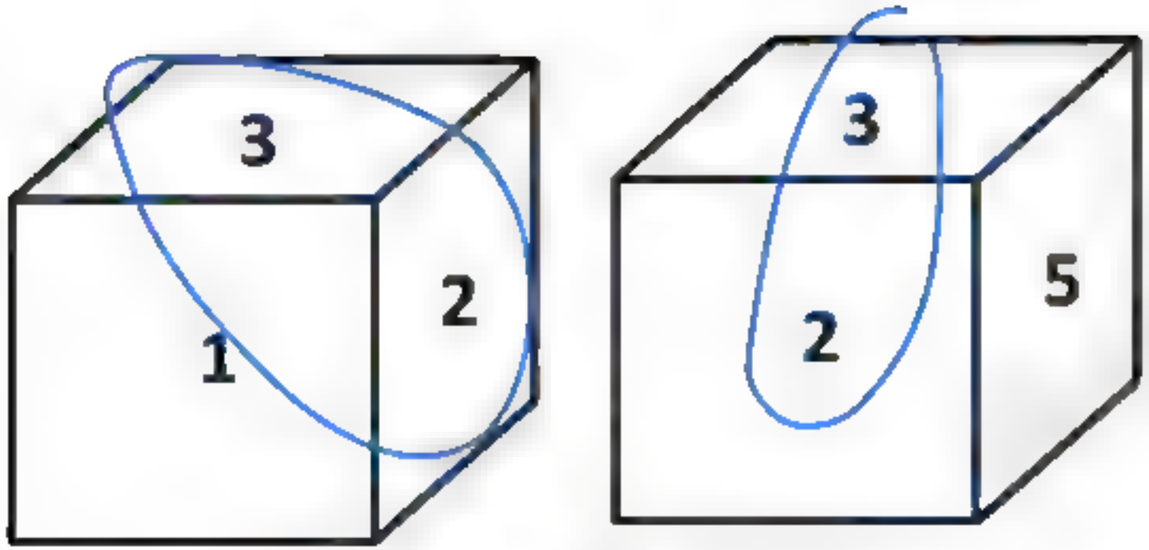

1 ⟷ 5

1 — 5

IGacademy Download App in PlayStore | SUBSCRIBE IshwarGirl ಪಾಠಶಾಲೆ | 8660070677

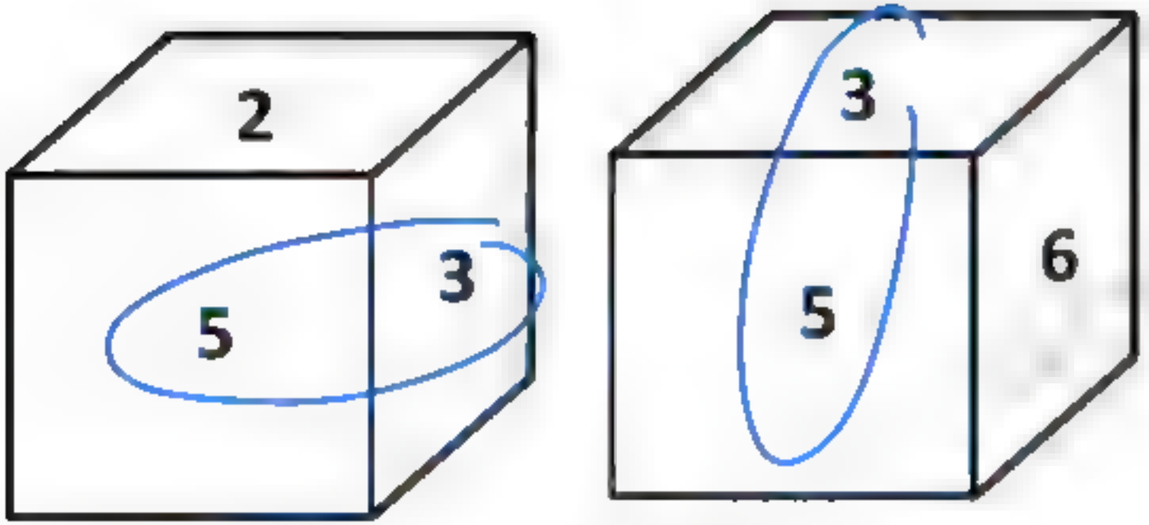

$2 \longleftrightarrow 6$

2 — 6

IGacademy Download App in PlayStore | SUBSCRIBE IshwarGiri ಪಾಠಶಾಲೆ | 8660070677

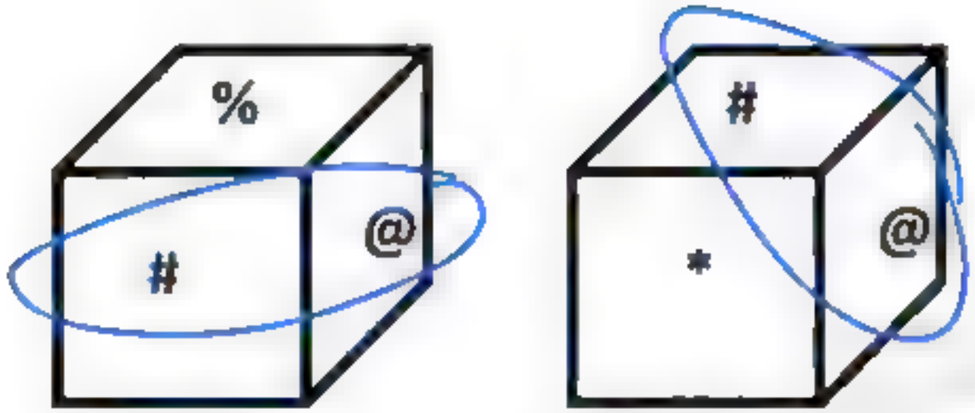

* ⟷ %

IGacademy Download App in PlayStore | SUBSCRIBE IshwarGiri ಪಾಠಶಾಲೆ | 8660070677

Q. Which number will be opposite to the 3, in given dice?
ಕೊಟ್ಟಿರುವ ದಾಳಗಳಲ್ಲಿ ಯಾವ ಸಂಖ್ಯೆ 3 ಕ್ಕೆ ವಿರುದ್ಧವಾಗಿರುತ್ತದೆ?

a)2 b)3 c)4 d)5

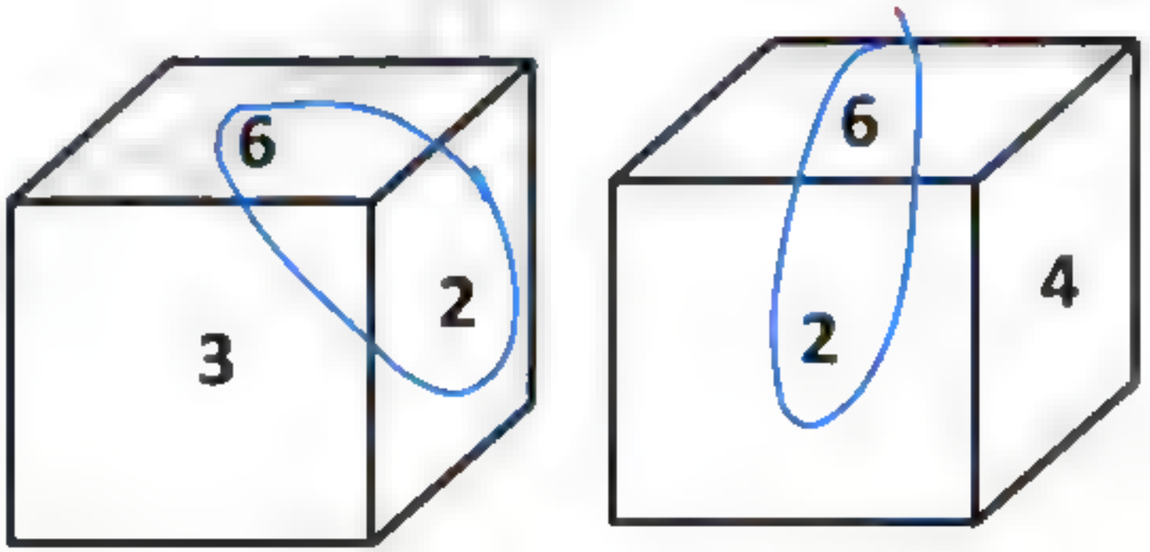

3 — 4

iGacademy Download App in PlayStore | SUBSCRIBE IshwarGirl ಪಾಠಶಾಲೆ | 8660070677

Q. Which number will be opposite to the 5, in given dice?

ದಾಳದ ಎರಡು ಸ್ಥಿತಿಗಳನ್ನು ನೀಡಲಾಗಿದೆ. ಕೊಟ್ಟಿರುವ ದಾಳಗಳಲ್ಲಿ ಯಾವ ಸಂಖ್ಯೆ 5 ಕ್ಕೆ ವಿರುದ್ಧವಾಗಿರುತ್ತದೆ?

a)1 b)4 c)3 d)2

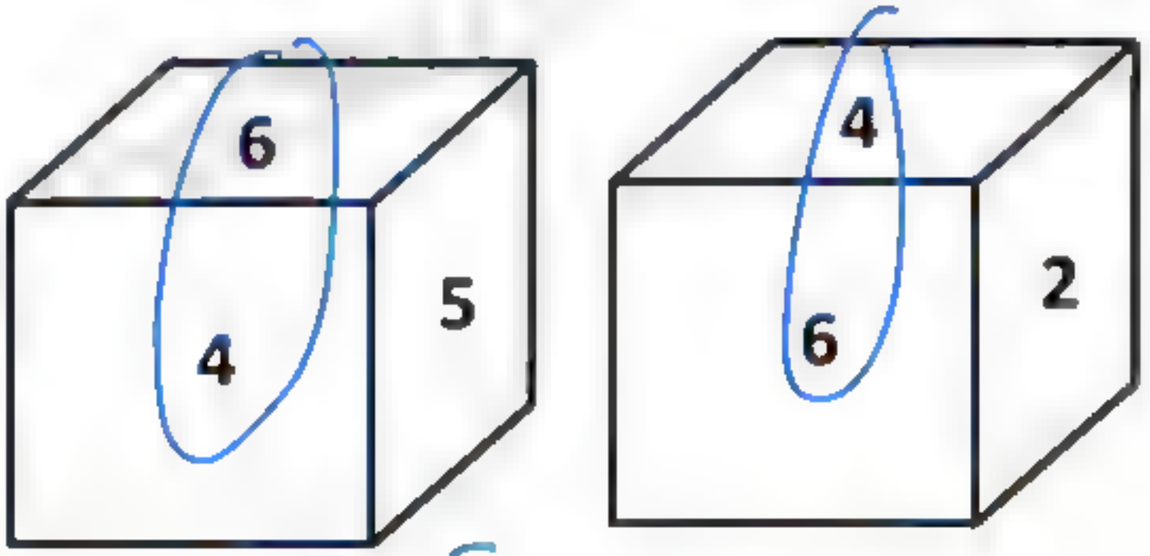

5 — 2

IGacademy Download App in PlayStore | SUBSCRIBE IshwarGiri ಪಾಠಶಾಲೆ | 8660070677

Q. Which number will be opposite to the 5, in given dice?
ಕೊಟ್ಟಿರುವ ದಾಳಗಳಲ್ಲಿ ಯಾವ ಸಂಖ್ಯೆ 5 ಕ್ಕೆ ವಿರುದ್ಧವಾಗಿರುತ್ತದೆ?

a)1 **b)3** **c)6** **d)4**

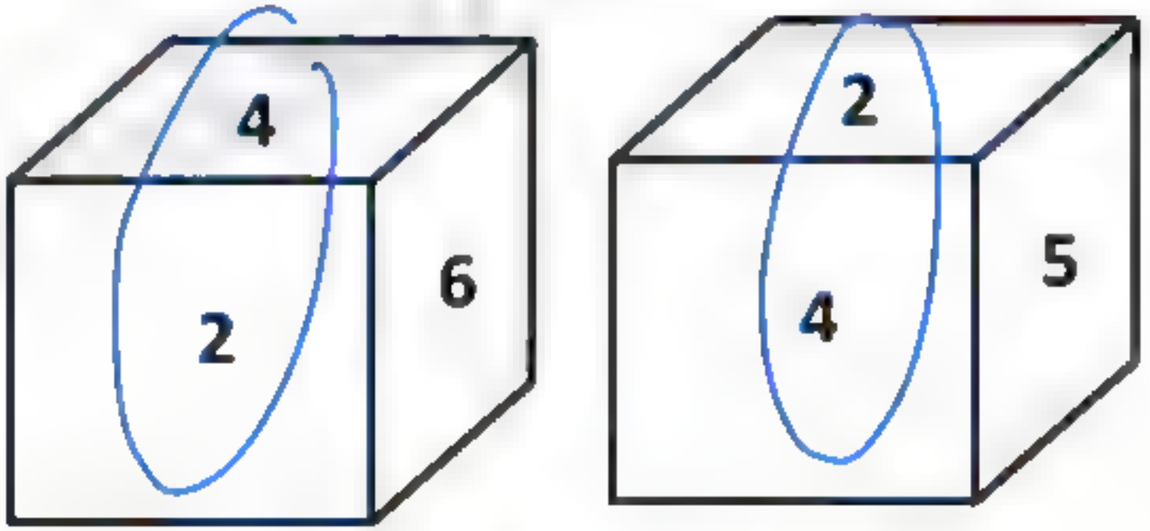

6 — 5

IGacademy Download App in PlayStore | SUBSCRIBE IshwarGirl ಪಾಠಶಾಲೆ | 8660070677

Q. Find the opposite of face having 1 dot.

1 ಚುಕ್ಕೆ ಹೊಂದಿರುವ ಮುಖದ ಅಭಿಮುಖದಲ್ಲಿ ಎಷ್ಟು ಚುಕ್ಕಿಗಳಿವೆ.

a)2 **b)4** **c)6** **d)5**

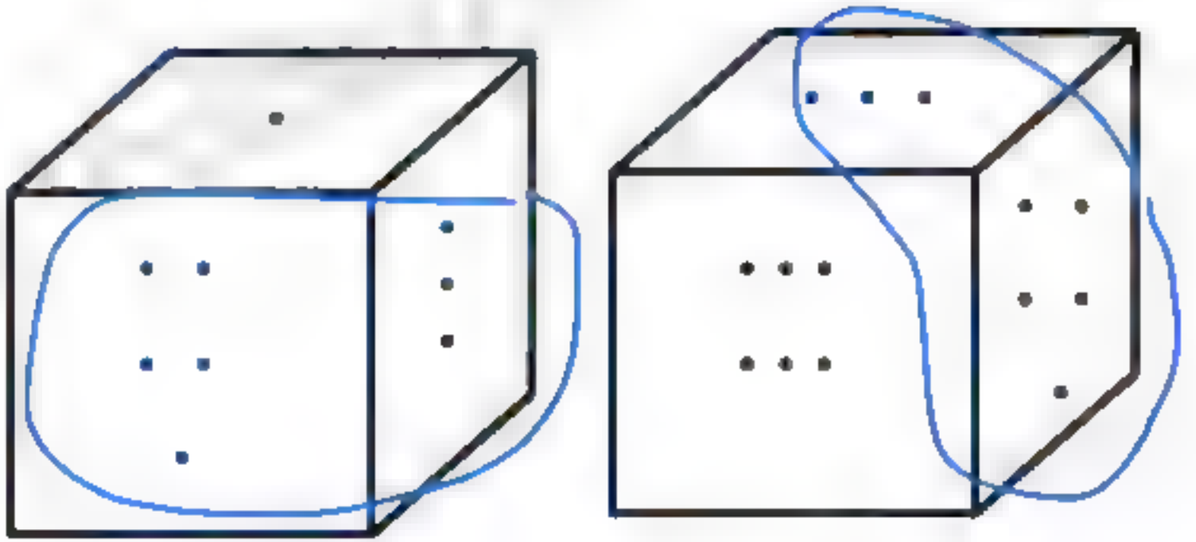

1 — 6

iGacademy Download App in PlayStore | SUBSCRIBE IshwarGirl ಪಾಠಶಾಲೆ | 8660070677

Q. Notice the following dices. Based on these, find the symbol opposite of $

Q. ಈ ಕೆಳಗಿನ ದಾಳಗಳನ್ನು ಗಮನಿಸಿ. ಇವುಗಳ ಆಧಾರದ ಮೇಲೆ $ ಗೆ ವಿರುದ್ಧವಾದ ಸಂಕೇತವನ್ನು ಕಂಡುಹಿಡಿಯಿರಿ

a) @ **b) #** **c) *** **d) $**

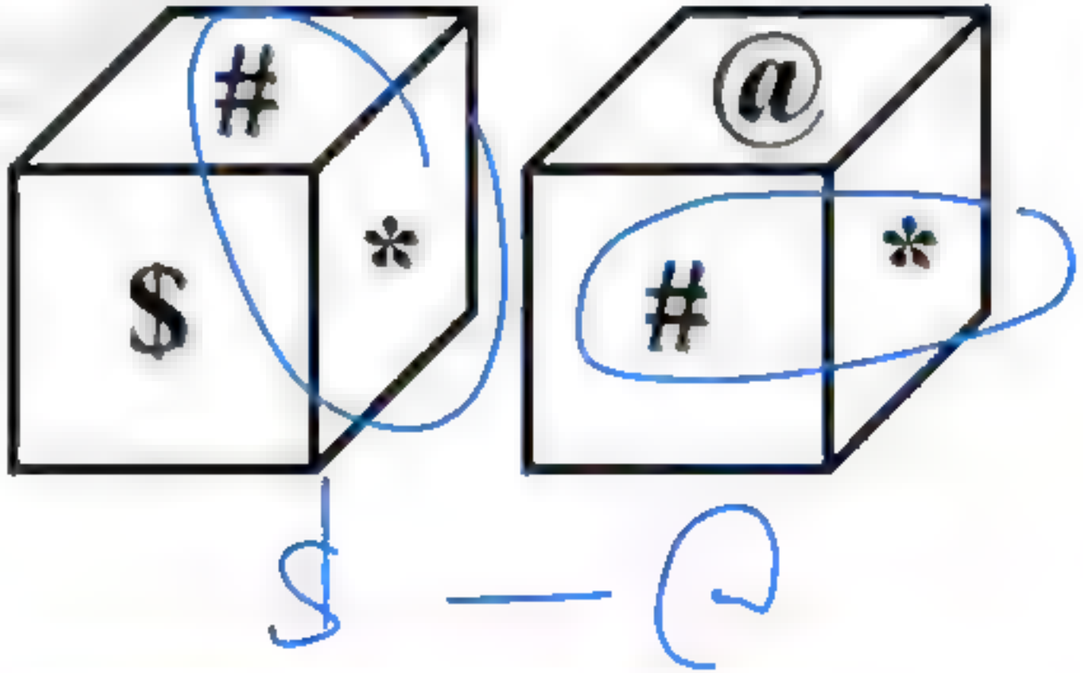

IGacademy Download App in PlayStore | SUBSCRIBE IshwarGirl ಪಾಠಶಾಲೆ | 8660070677

Q. Find the opposite colour of black?

a)White b) Yellow c) Blue d)Gray

Black ಬಣ್ಣದ ವಿರುದ್ಧ ಬಣ್ಣವನ್ನು ಗುರುತಿಸಿ.

a)White b) Yellow c) Blue d)Gray

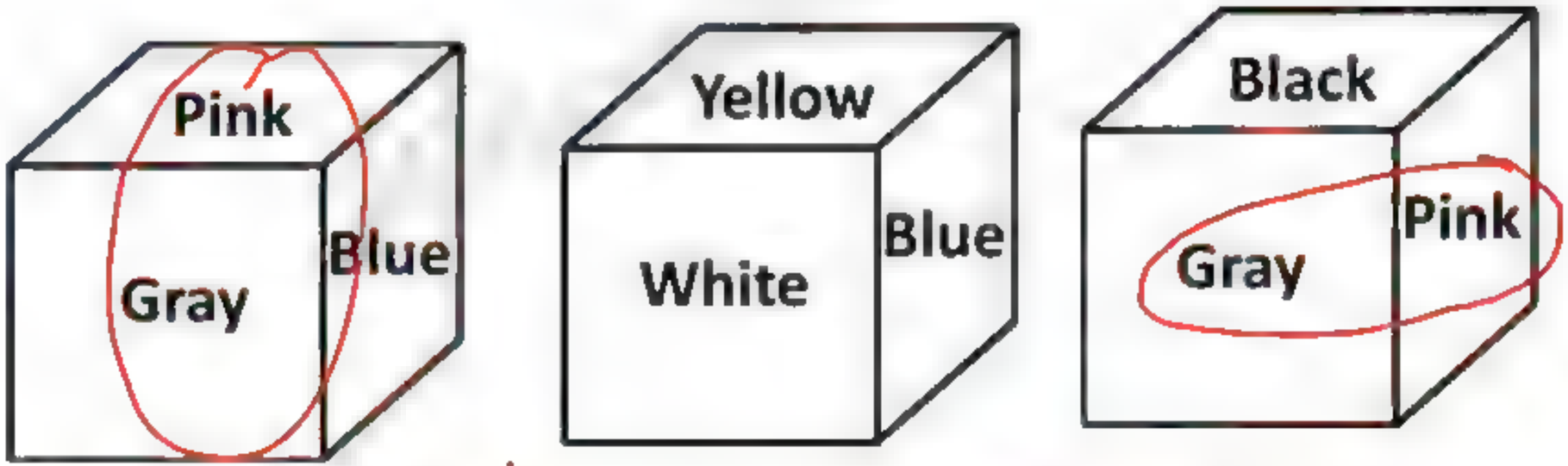

Blue —— Black

IGacademy Download App in PlayStore | SUBSCRIBE IshwarGirl ಪಾಠಶಾಲೆ | 8660070677

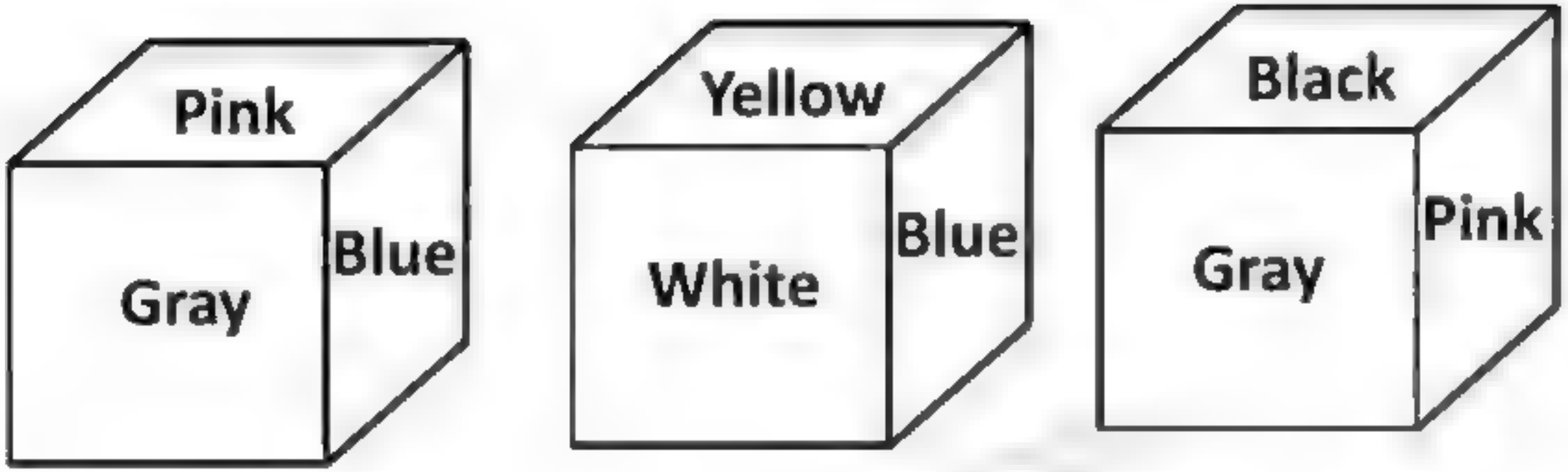

iGacademy Download App in PlayStore SUBSCRIBE IshwarGiri ಪಾಠಶಾಲೆ 8660070677

Q. Find the opposite colour of Grey?

Grey ಬಣ್ಣದ ವಿರುದ್ಧ ಬಣ್ಣವನ್ನು ಗುರುತಿಸಿ.

a)Red **b) white** **c) Blue** **d)pink**

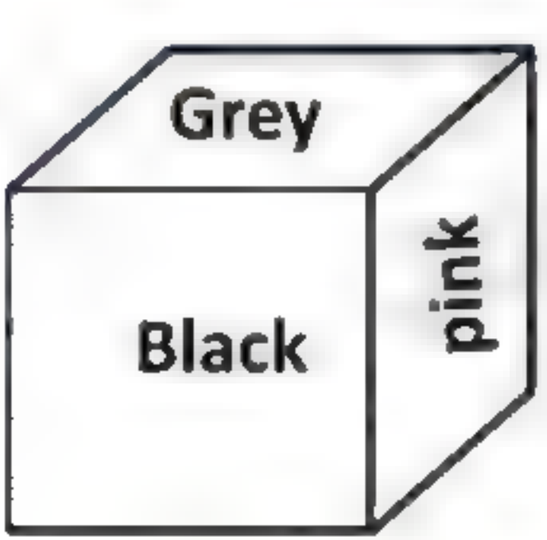

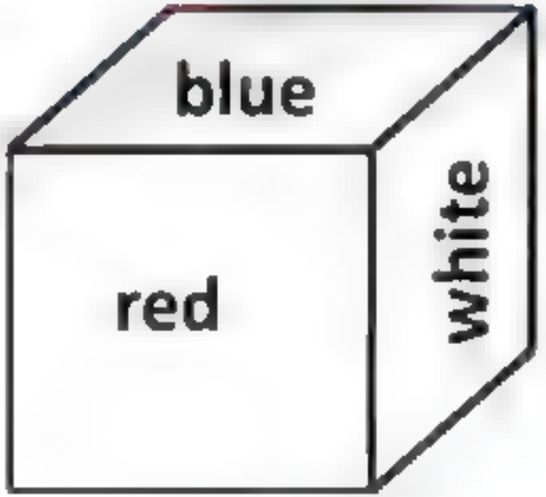

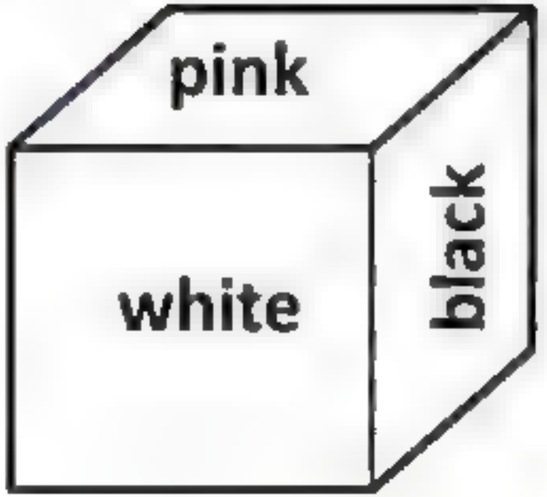

IGacademy Download App in PlayStore | SUBSCRIBE IshwarGirl ಪಾಠಶಾಲೆ | 8660070677

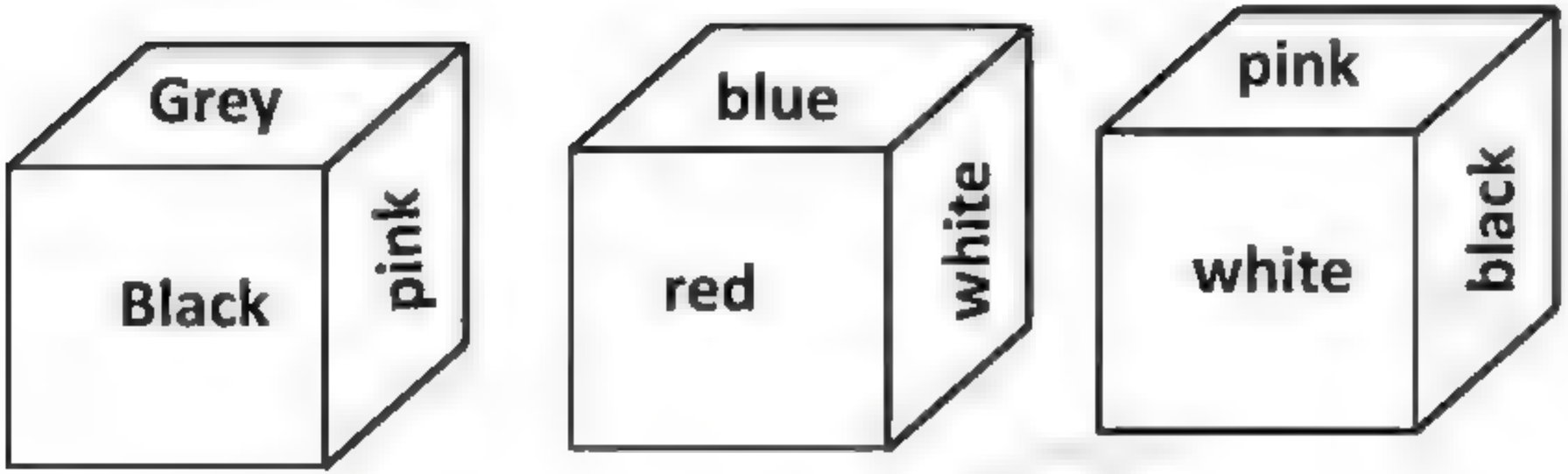

IGacademy Download App in PlayStore SUBSCRIBE IshwarGirl ಪಾಠಶಾಲೆ 8660070677

Q. Find opposite face of 2 ?

2 ರ ಅಭಿಮುಖ ಯಾವುದು?

(A) 3 (b) 1 (c) 5 (d) 4

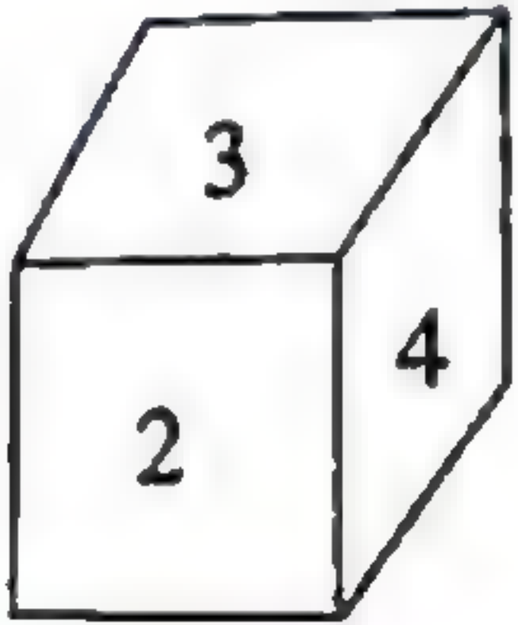

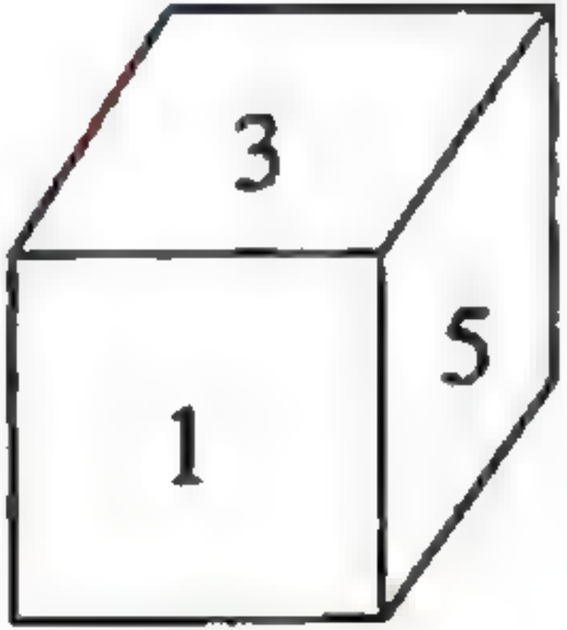

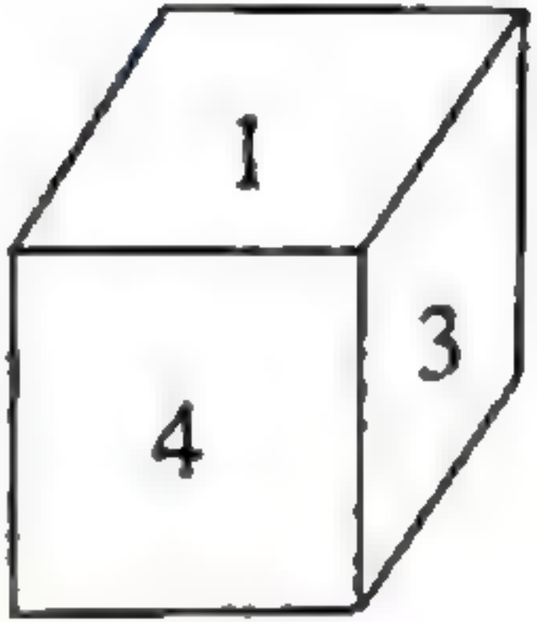

IGacademy Download App in PlayStore | SUBSCRIBE IshwarGiri ಪಾಠಶಾಲೆ | 8660070677

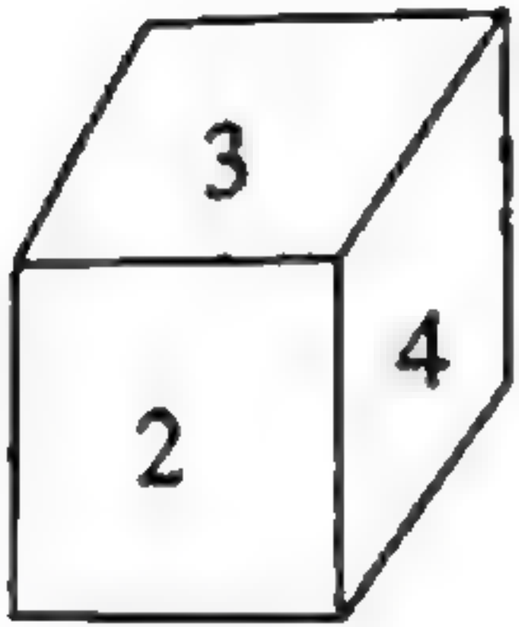

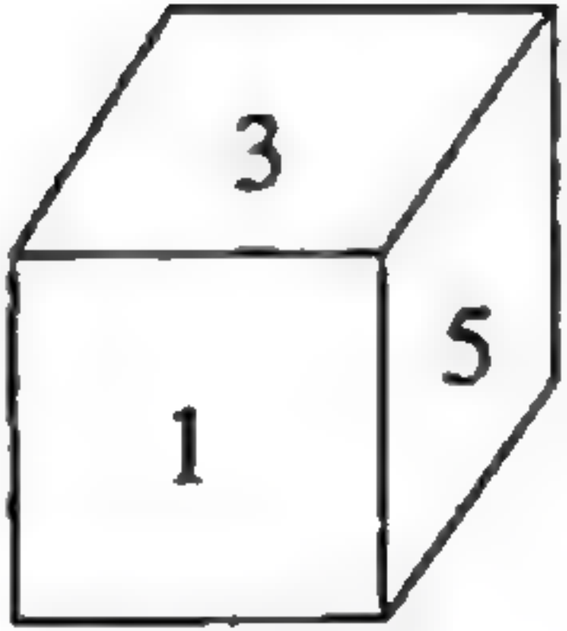

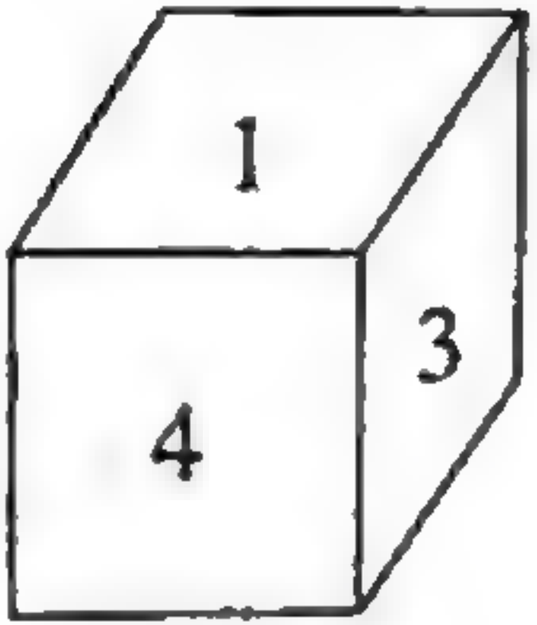

IGacademy Download App in PlayStore SUBSCRIBE IshwarGirl ಪಾಠಶಾಲೆ 8660070677

Q. Find opposite face of symbol ' + '

' + ' ರ ಅಭಿಮುಖ ಚಿಹ್ನೆಯನ್ನು ಕಂಡುಹಿಡಿಯಿರಿ.

a)<> b)% c)* d)+

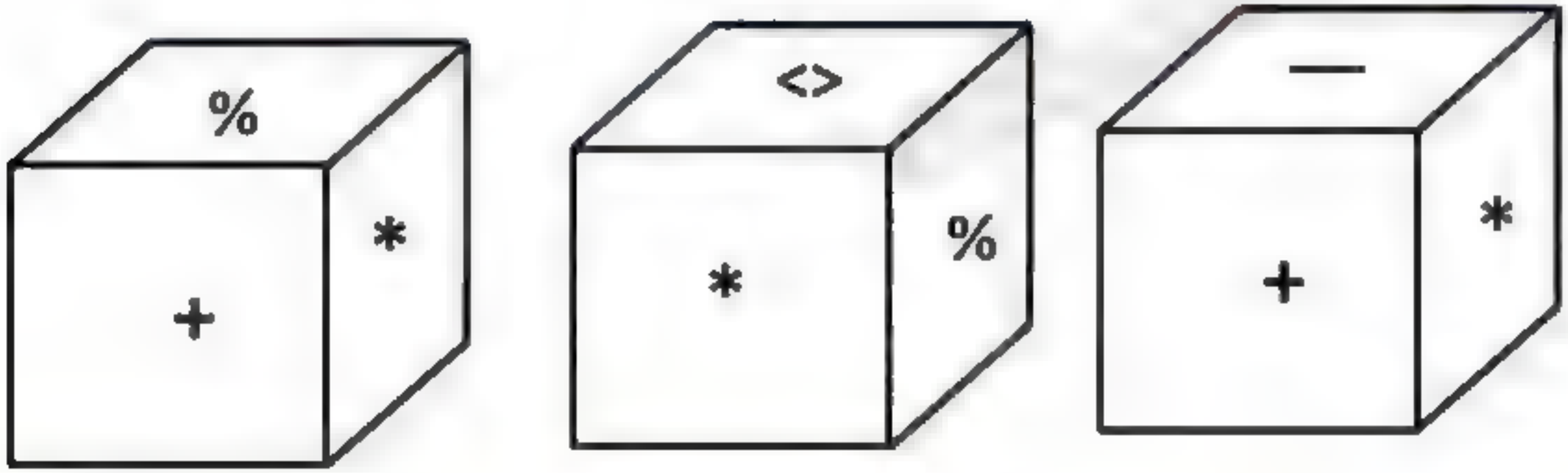

IGacademy Download App in PlayStore | SUBSCRIBE IshwarGiri ಪಾಠಶಾಲೆ | 8660070677

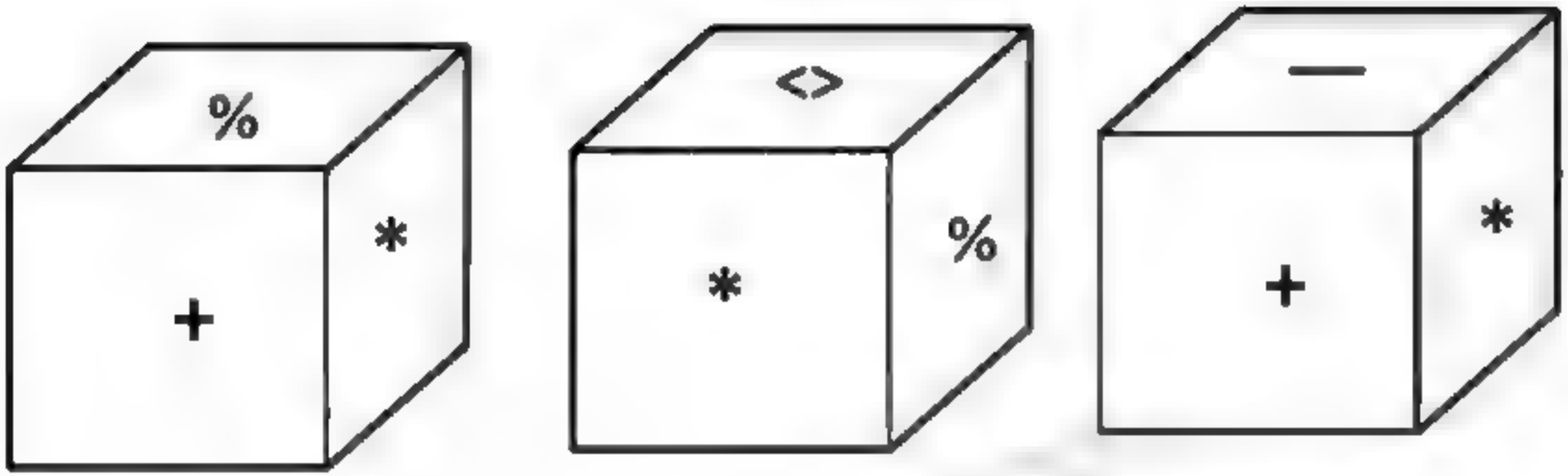

IGacademy Download App in PlayStore SUBSCRIBE IshwarGiri ಪಾಠಶಾಲೆ 8660070677

Q. Which number will be opposite to the 5, in given dice?

ದಾಳದ 4 ಸ್ಥಿತಿಗಳನ್ನು ನೀಡಲಾಗಿದೆ. ಕೊಟ್ಟಿರುವ ದಾಳಗಳಲ್ಲಿ ಯಾವ ಸಂಖ್ಯೆ 5 ಕ್ಕೆ ವಿರುದ್ಧವಾಗಿರುತ್ತದೆ?

a)1 b)4 c)3 d)6

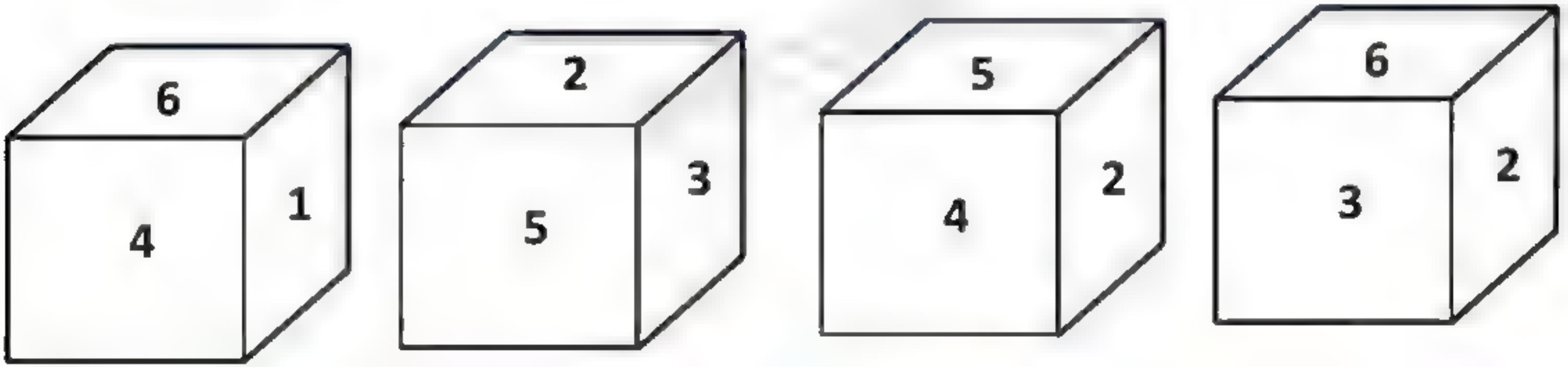

IGacademy Download App in PlayStore SUBSCRIBE IshwarGiri ಪಾಠಶಾಲೆ 8660070677

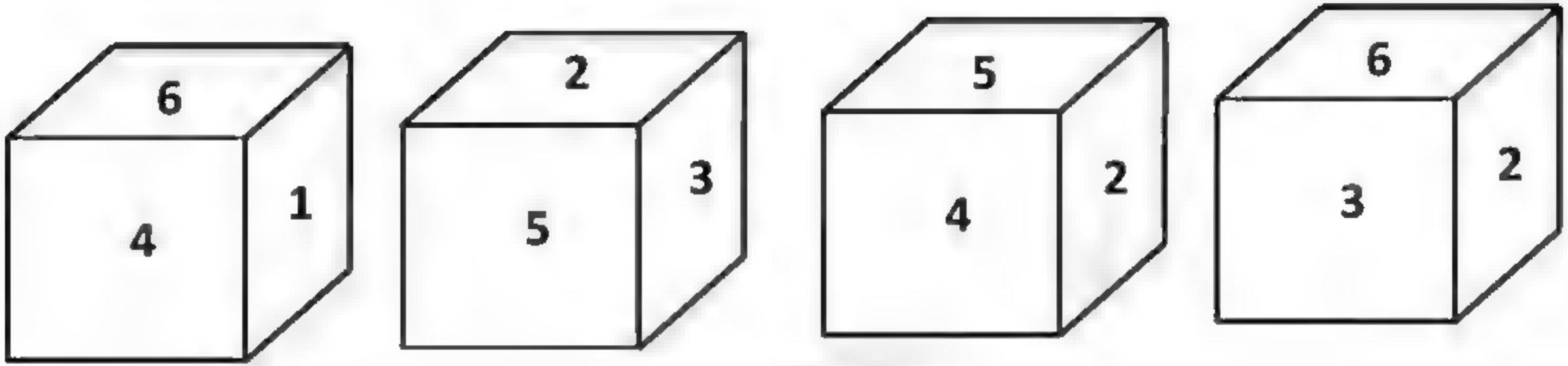

IGacademy Download App in PlayStore SUBSCRIBE IshwarGiri ಪಾಠಶಾಲೆ 8660070677

PSI – 2015

Q. Which of the following is the number on the opposite face of 6?

Q. ಈ ಕೆಳಗಿನ ಚಿತ್ರದಲ್ಲಿ 6 ರ ವಿರುದ್ಧ ಮುಖದಲ್ಲಿರುವ ಸಂಖ್ಯೆ ಯಾವುದು?

a) 1 **b) 2** **c) 3** **d) 4**

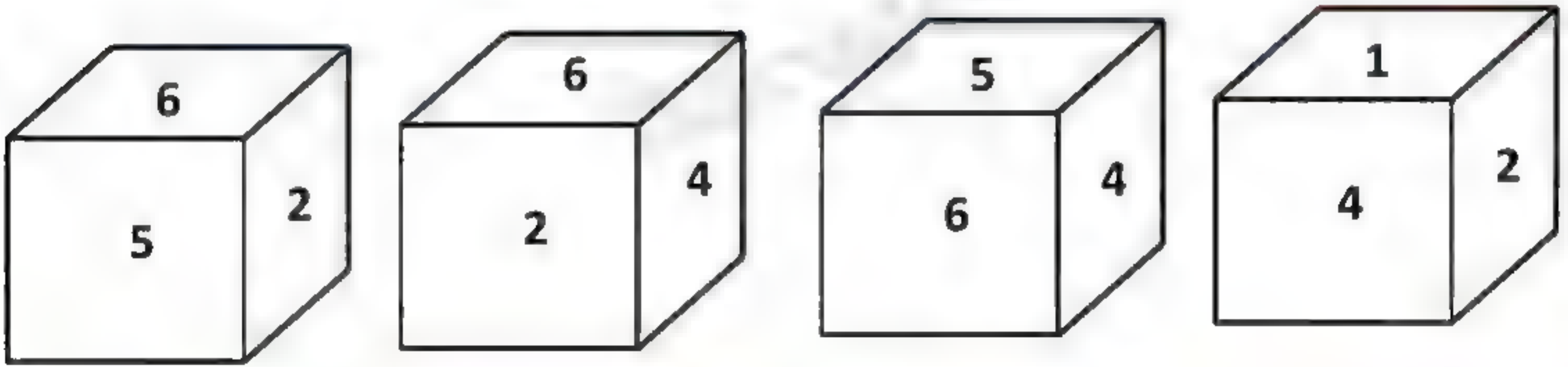

IGacademy Download App In PlayStore SUBSCRIBE IshwarGirl ಪಾಠಶಾಲೆ 8660070677

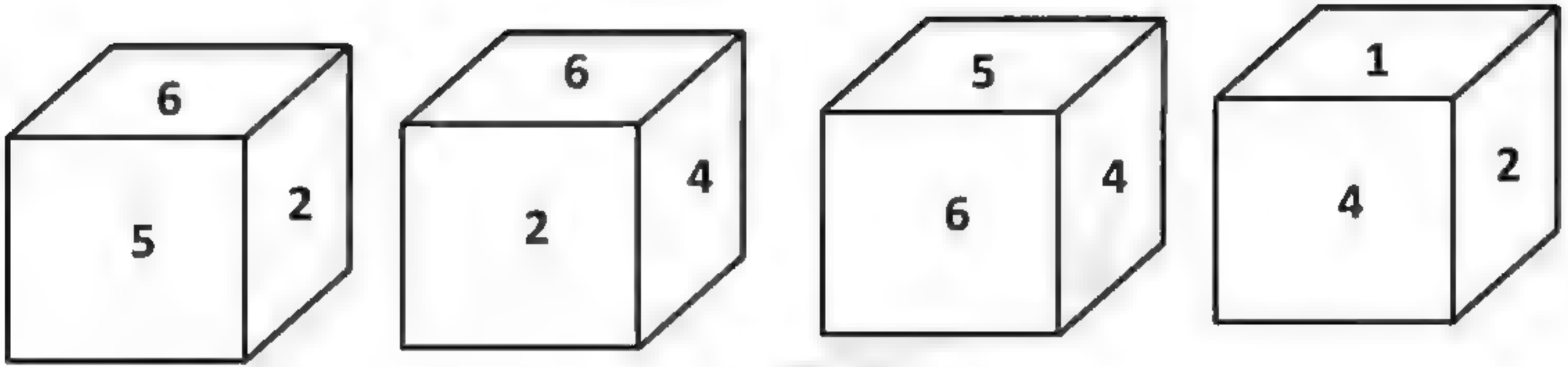

IGacademy Download App in PlayStore | SUBSCRIBE IshwarGiri ಪಾಠಶಾಲೆ | 8660070677

Q. Which is the opposite face of B

B ಯ ಅಭಿಮುಖ ಯಾವುದು?

(a) A **(b) D** **(c) E** **(d) C**

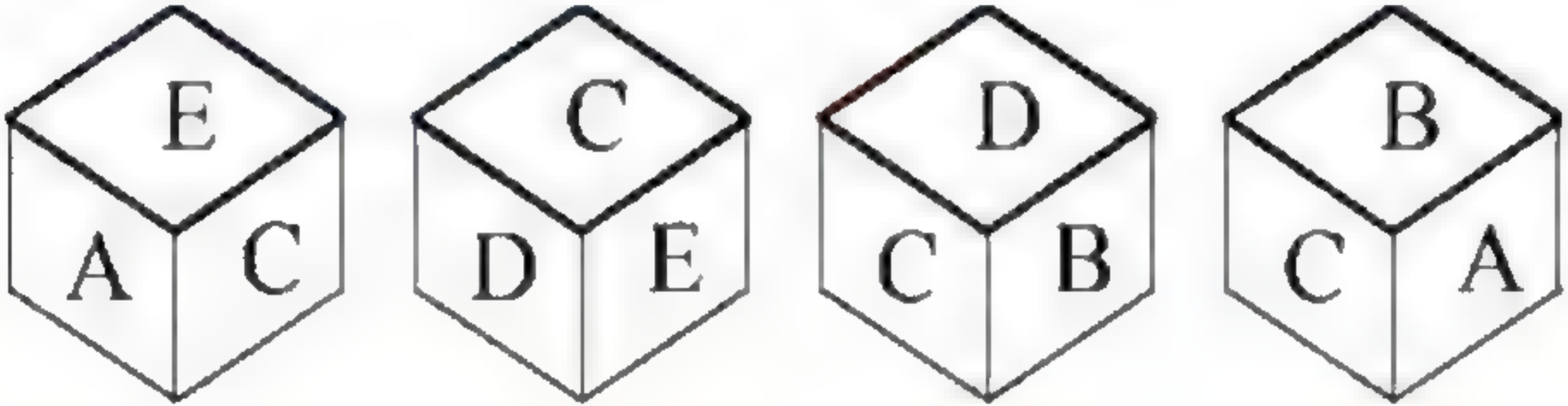

IGacademy Download App in PlayStore SUBSCRIBE IshwarGirl ಪಾಠಶಾಲೆ 8660070677

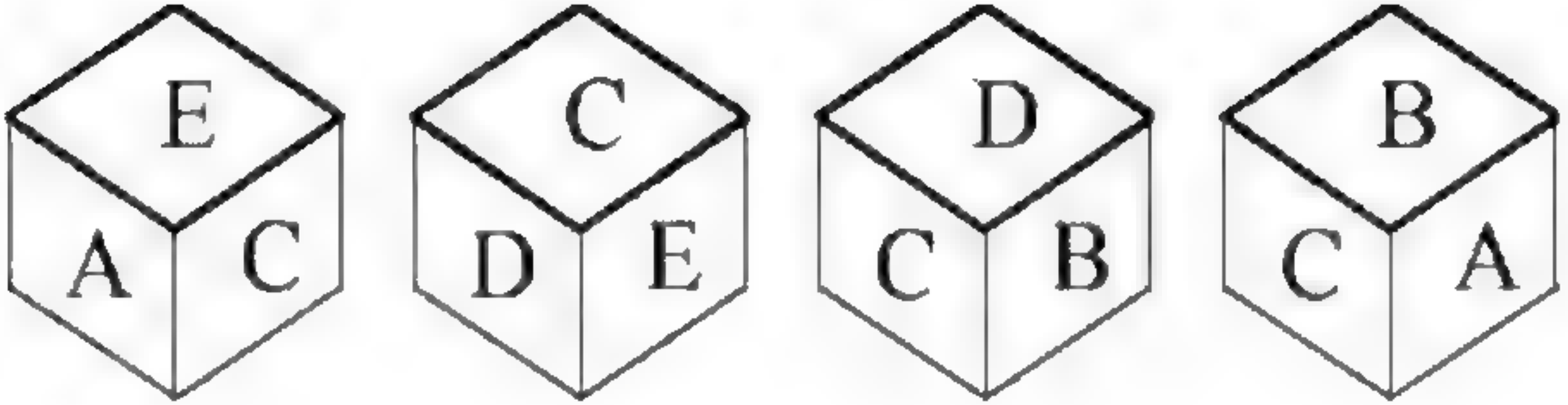

IGacademy Download App in PlayStore SUBSCRIBE IshwarGiri ಪಾಠಶಾಲೆ 8660070677

APC - 2018

Q. From the four positions of a dice given a below. Find the color which is opposite to yellow

(a) Violet (b) Red (c) Rose (d) Blue

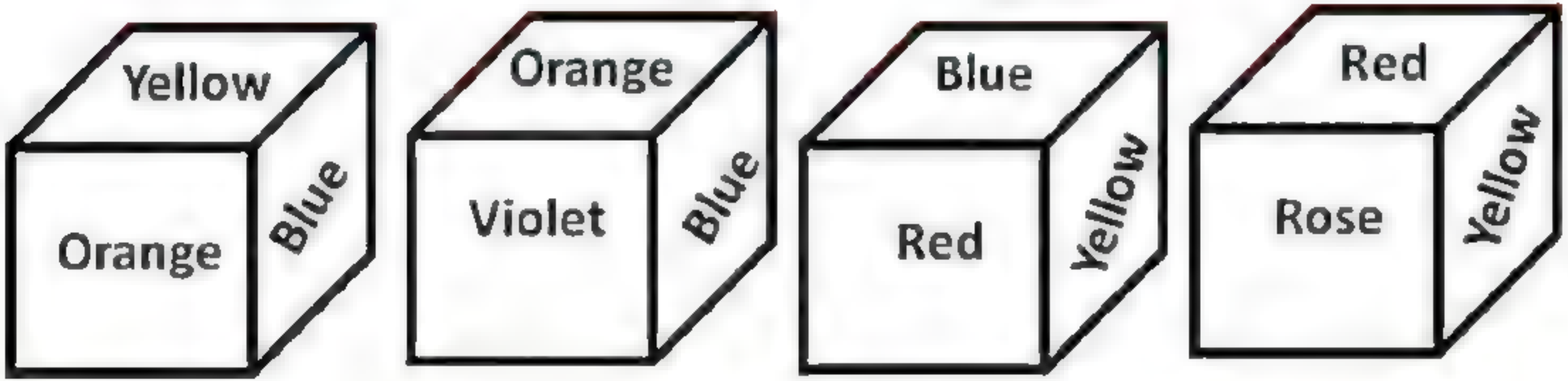

IGacademy Download App in PlayStore SUBSCRIBE IshwarGiri ಪಾಠಶಾಲೆ 8660070677

APC - 2018

Q. ಕೆಳಗೆ ನೀಡಲ್ಪಟ್ಟ ದಾಳವೊಂದರ ನಾಲ್ಕು ಸ್ಥಿತಿಗಳಿಂದ ಹಳದಿ ಬಣ್ಣಕ್ಕೆ ವಿರುದ್ಧವಾಗಿರುವ ಬಣ್ಣವನ್ನು ಕಂಡುಹಿಡಿಯಿರಿ

(a) ನೇರಳೆ (b) ಕೆಂಪು (c) ಗುಲಾಬಿ (d) ನೀಲಿ

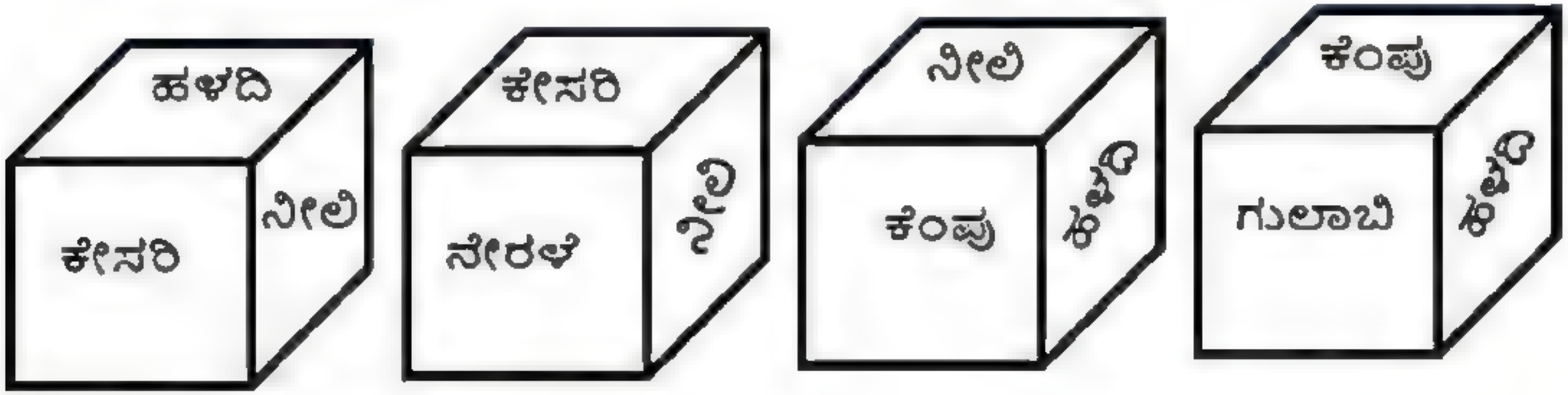

IGacademy Download App in PlayStore SUBSCRIBE IshwarGiri ಪಾಠಶಾಲೆ 8660070677

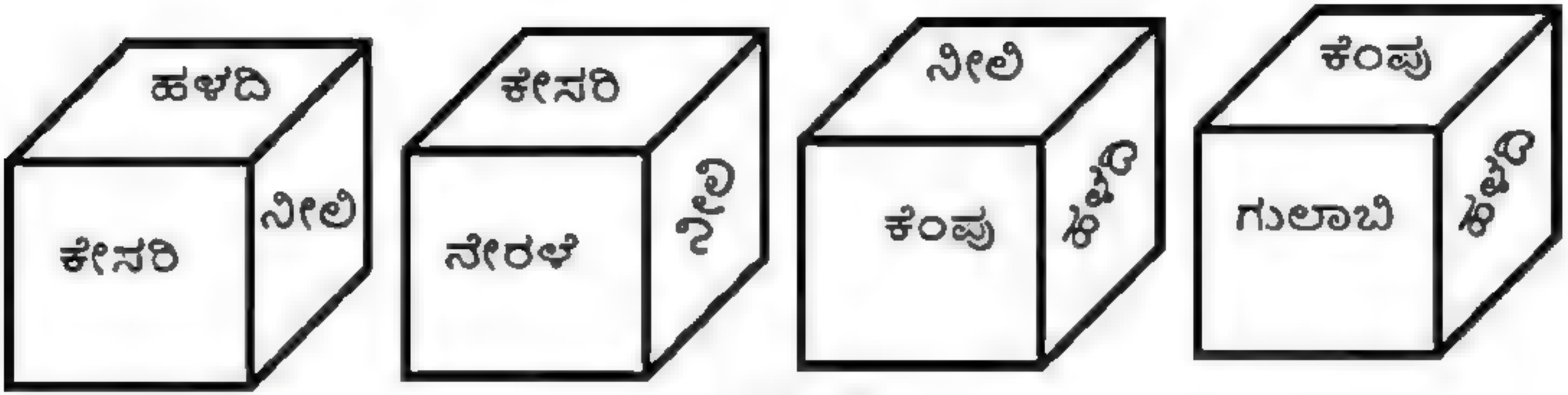

IGacademy Download App in PlayStore SUBSCRIBE IshwarGirl ಪಾಠಶಾಲೆ 8660070677

Q. Notice the following dices. Based on these, find the letter opposite of s

Q. ಈ ಕೆಳಗಿನ ದಾಳಗಳನ್ನು ಗಮನಿಸಿ. ಇವುಗಳ ಆಧಾರದ ಮೇಲೆ s ಕ್ಕೆ ವಿರುದ್ಧವಾದ ಅಕ್ಷರ?

a) y **b) u** **c) d** **d) w**

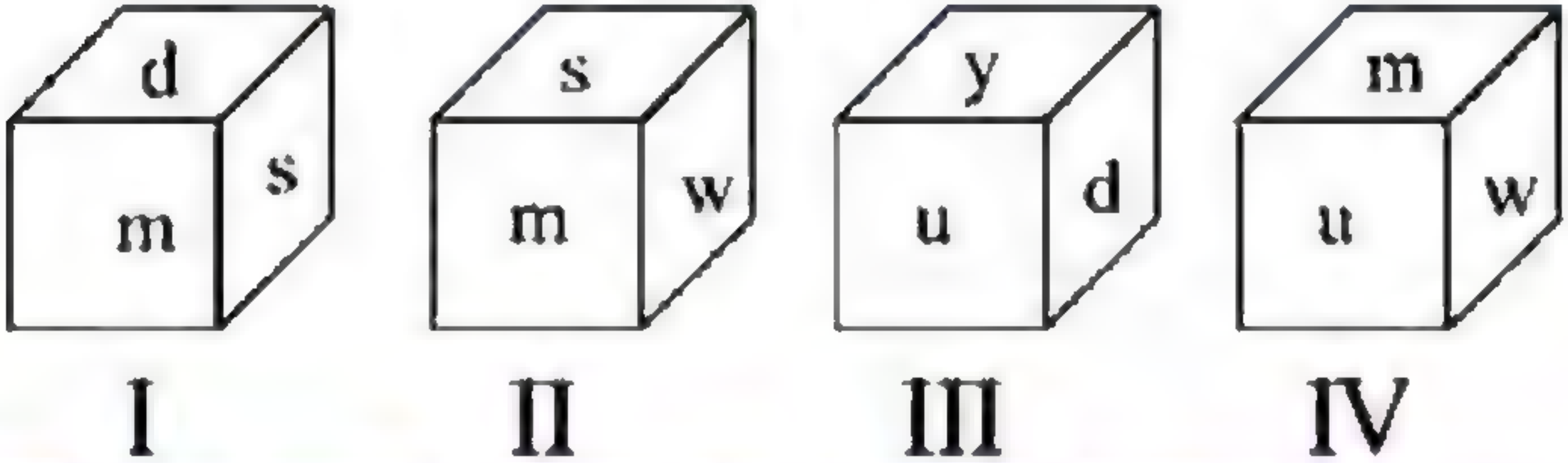

IGacademy Download App in PlayStore | SUBSCRIBE IshwarGirl ಪಾಠಶಾಲೆ | 8660070677

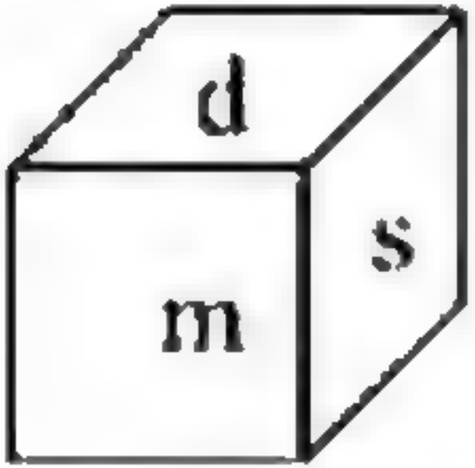

I

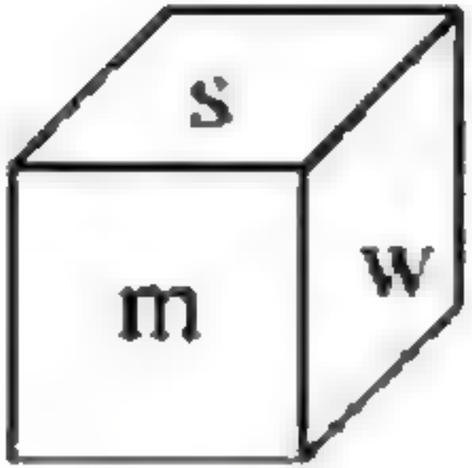

II

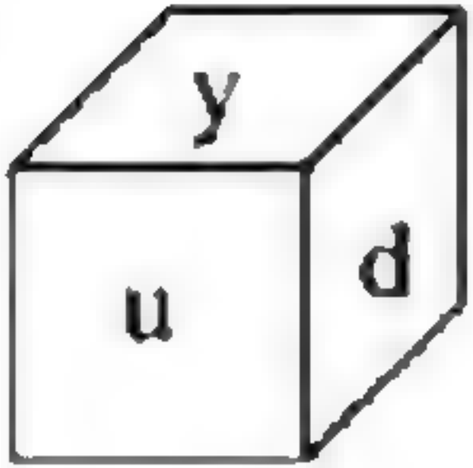

III

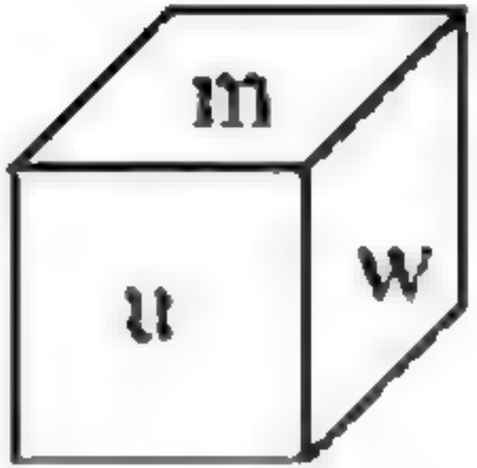

IV

IGacademy Download App in PlayStore SUBSCRIBE IshwarGiri ಪಾಠಶಾಲೆ 8660070677

Q. Find the number opposite to %.
% ಹೊಂದಿರುವ ಮುಖದ ಅಭಿಮುಖವನ್ನು ಹುಡುಕಿ

a) + **b) -** **c) o** **d) none**

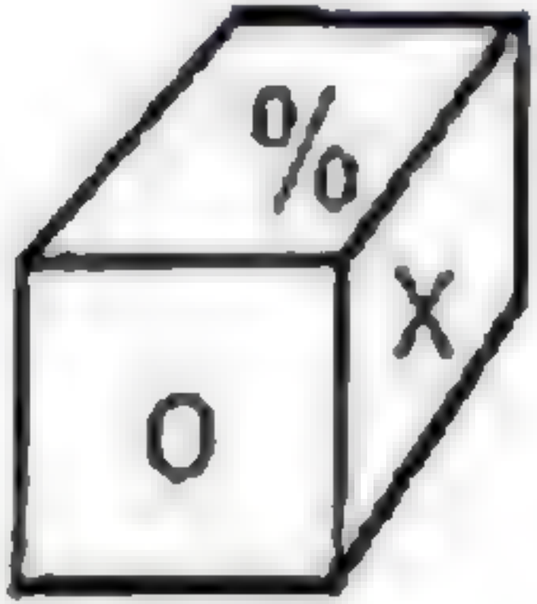

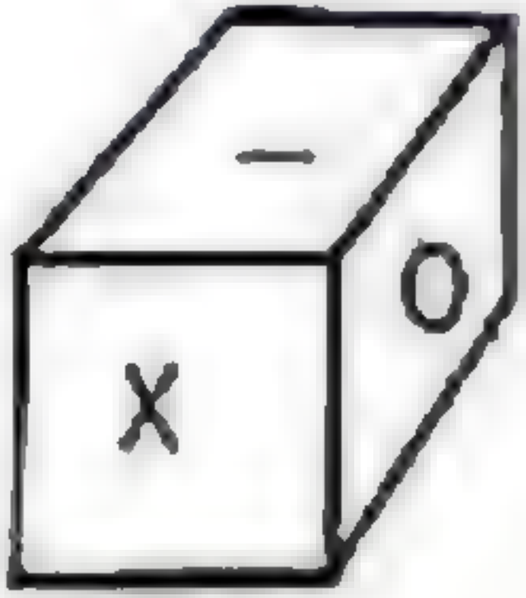

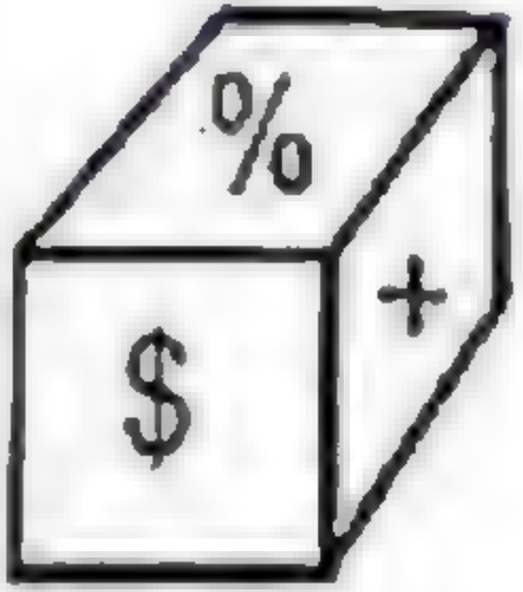

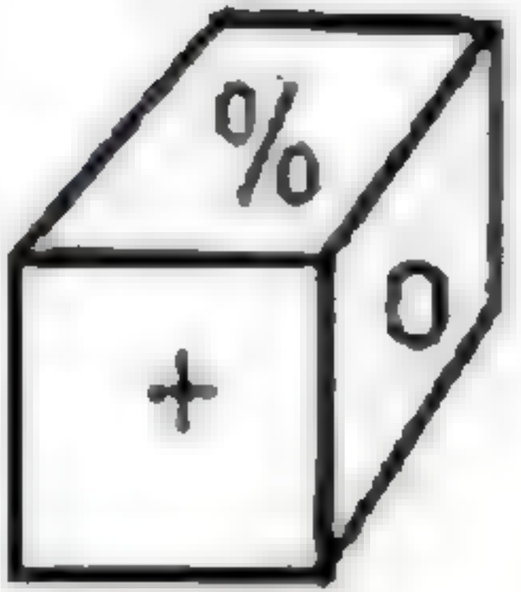

IGacademy Download App in PlayStore SUBSCRIBE IshwarGirl ಪಾಠಶಾಲೆ 8660070677

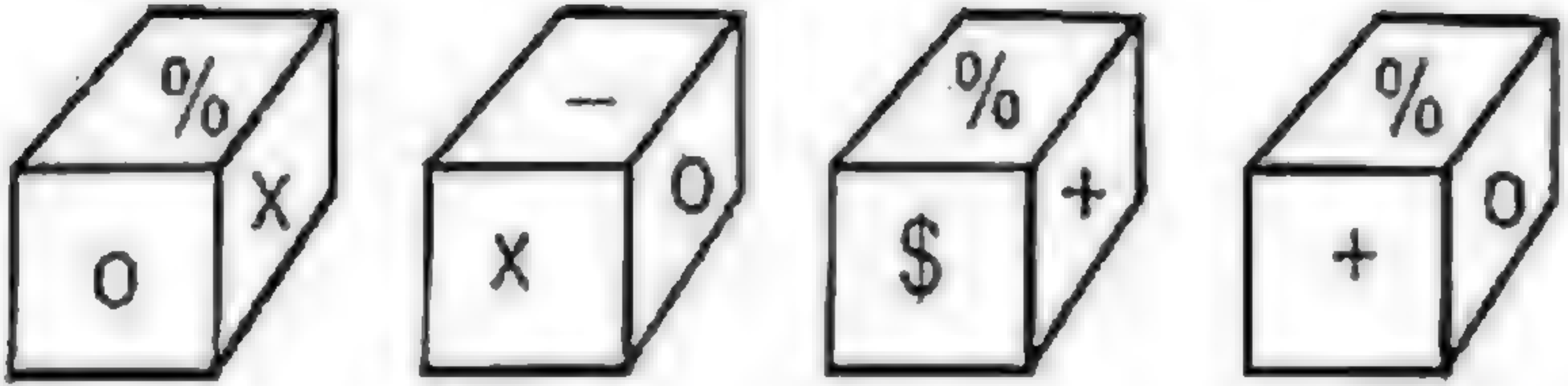

IGacademy Download App in PlayStore SUBSCRIBE IshwarGiri ಪಾಠಶಾಲೆ 8660070677

ಉದಾಹರಣೆ

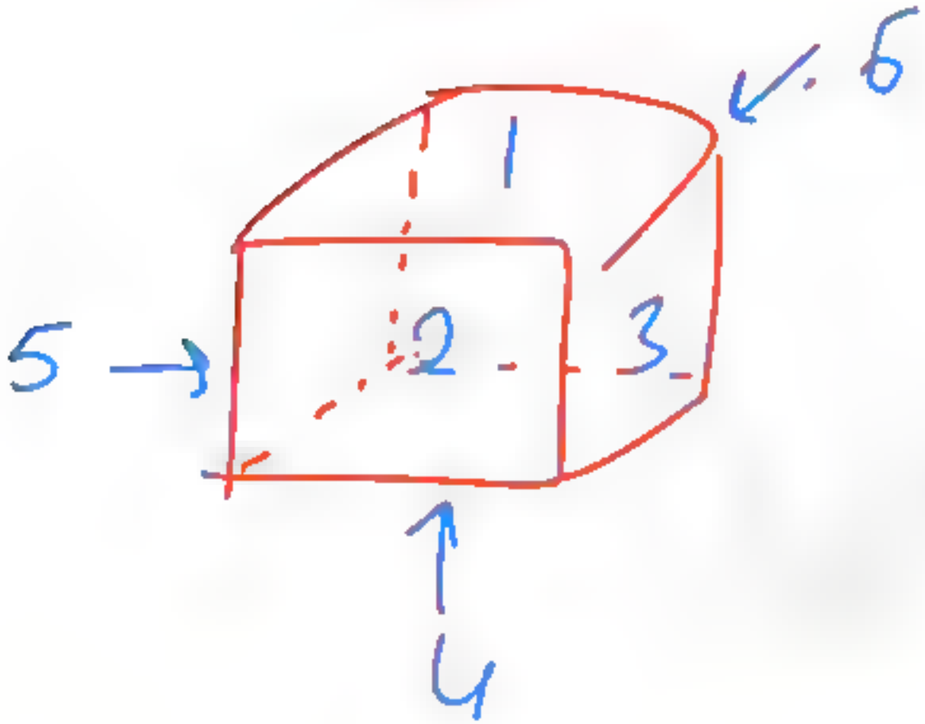

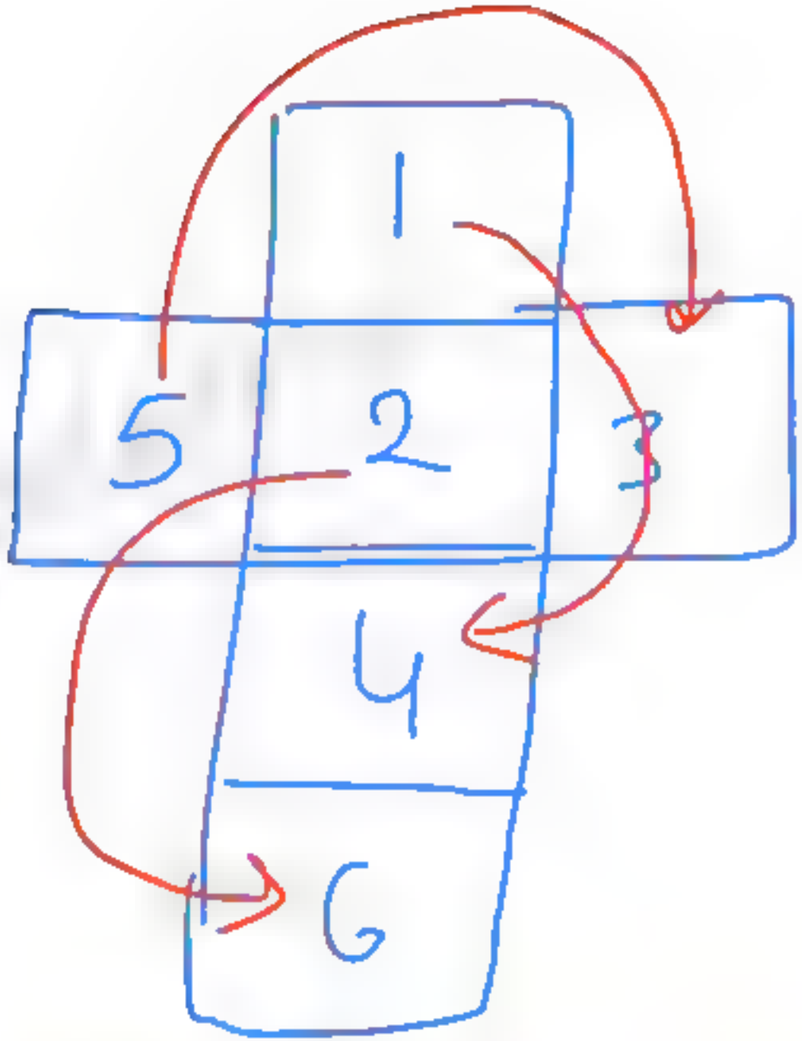

IGacademy Download App in PlayStore SUBSCRIBE IshwarGiri ಪಾಠಶಾಲೆ 8660070677

❖ **Type 3:** ಕೊಟ್ಟಿರುವ ಮುಚ್ಚಿದ ದಾಳಗಳಲ್ಲಿ ತೆರೆದ ದಾಳವನ್ನು ಹೋಲುವ ದಾಳದಲ್ಲಿ ಅಭಿಮುಖ ಸಂಖ್ಯೆಗಳು ಎಂದಿಗೂ ಜೊತೆಗೆ ಇರುವುದಿಲ್ಲ

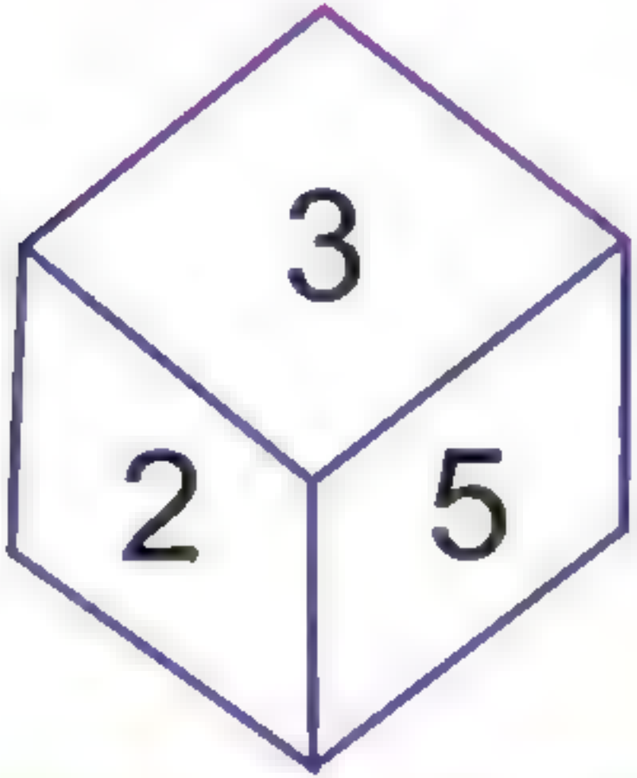

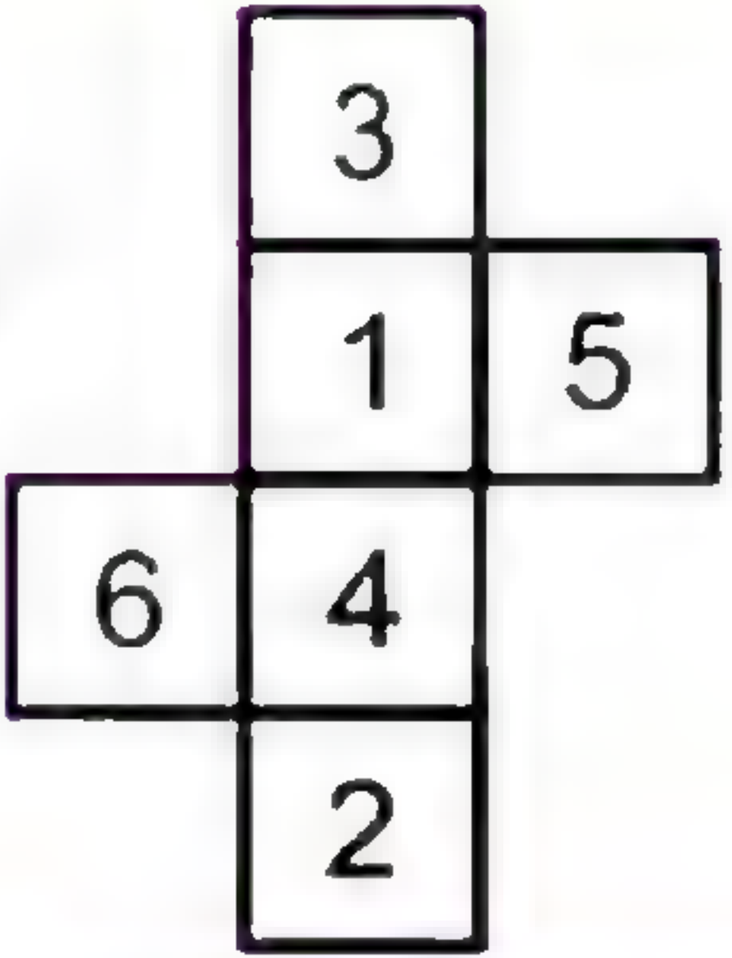

IGacademy Download App in PlayStore | SUBSCRIBE IshwarGirl ಪಾಠಶಾಲೆ | 8660070677

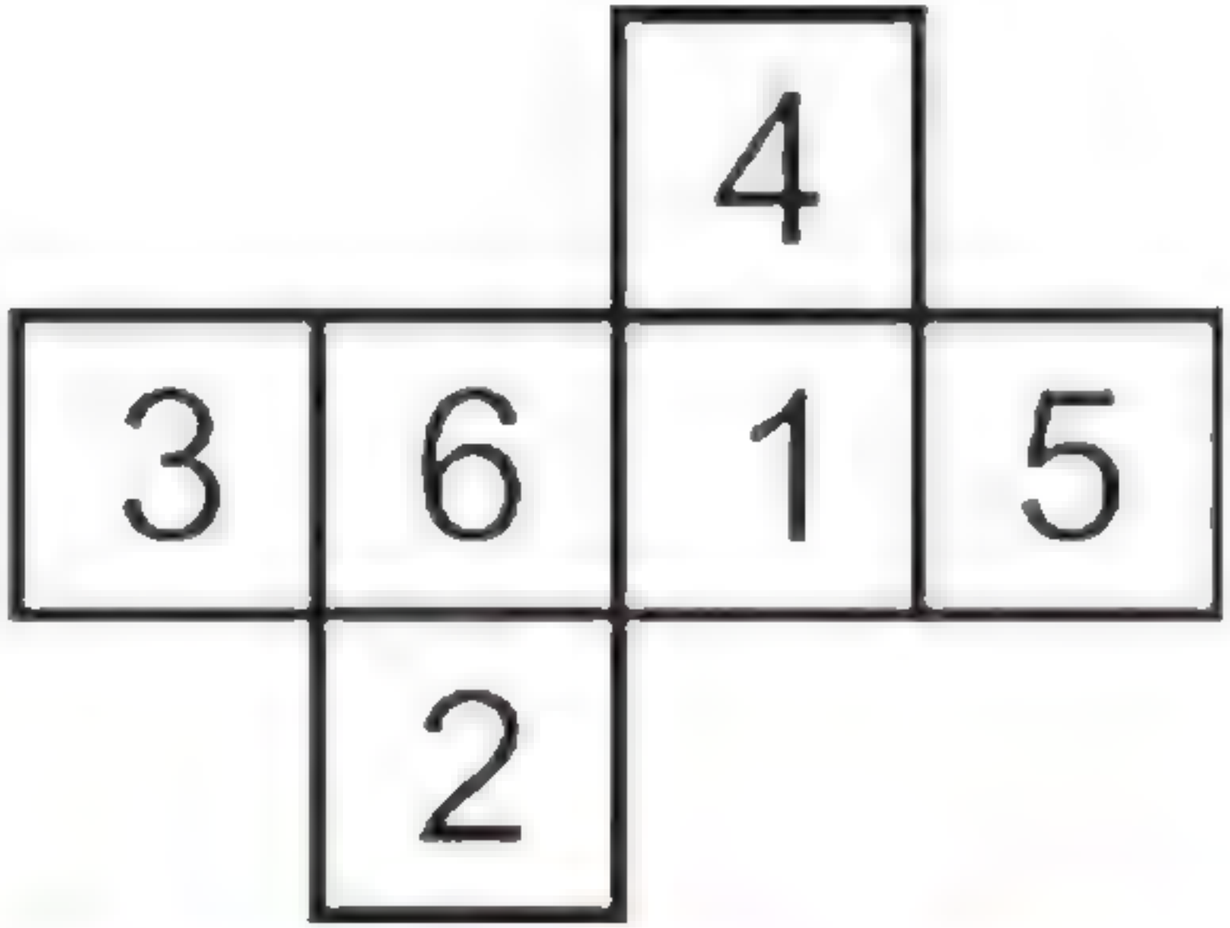

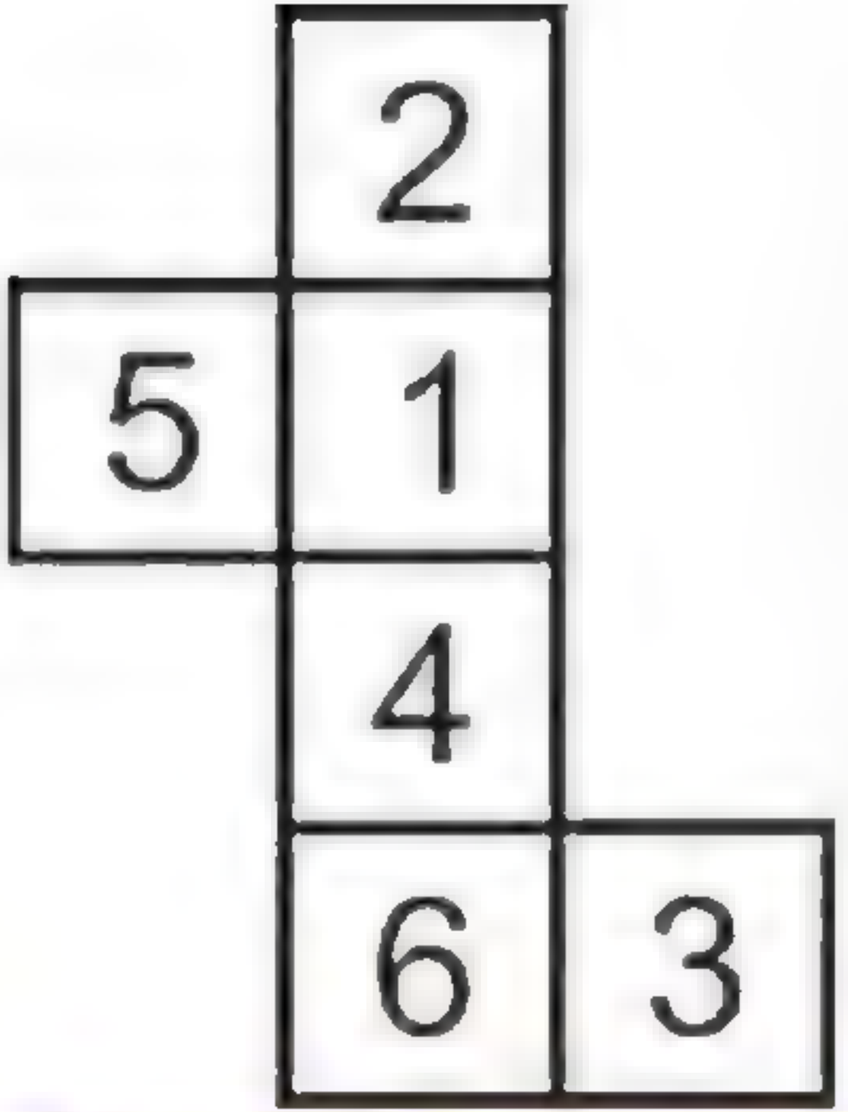

IGacademy Download App in PlayStore | SUBSCRIBE IshwarGiri ಪಾಠಶಾಲೆ | 8660070677

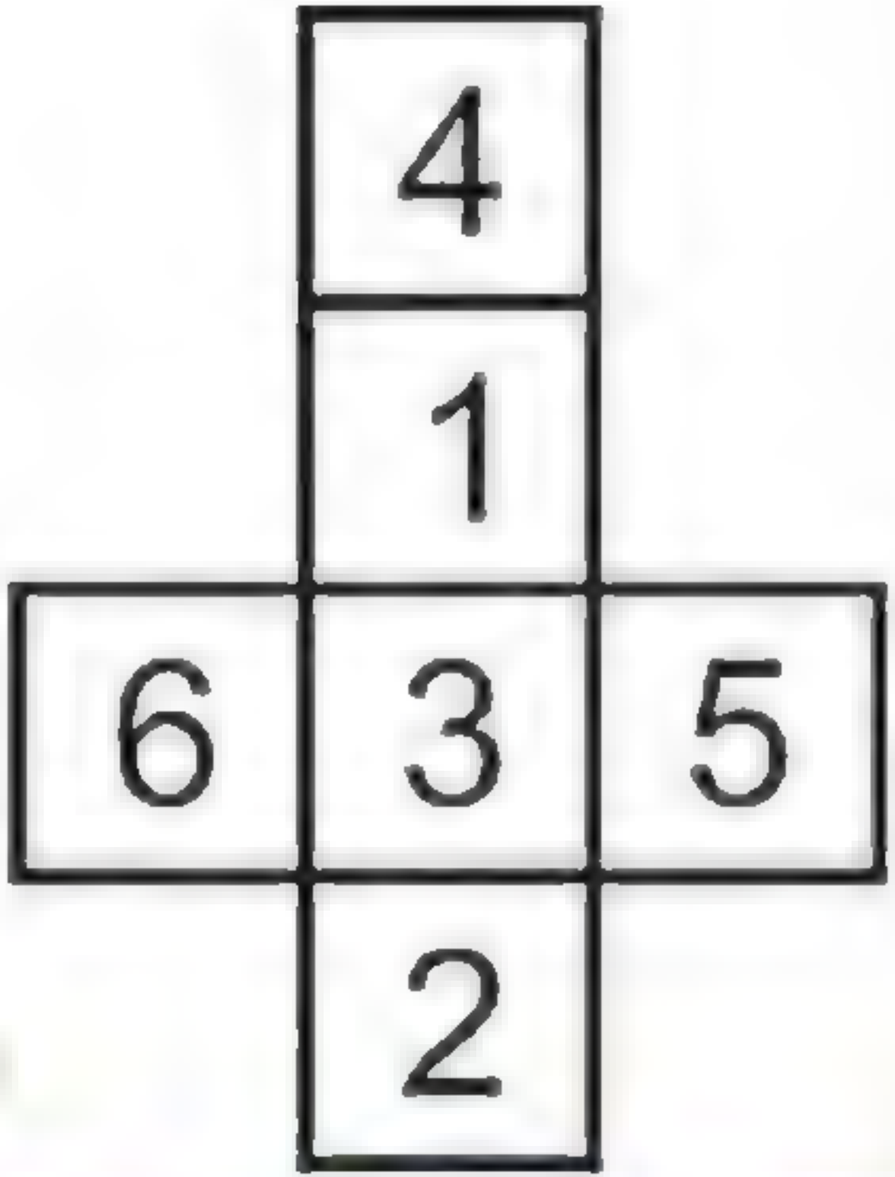

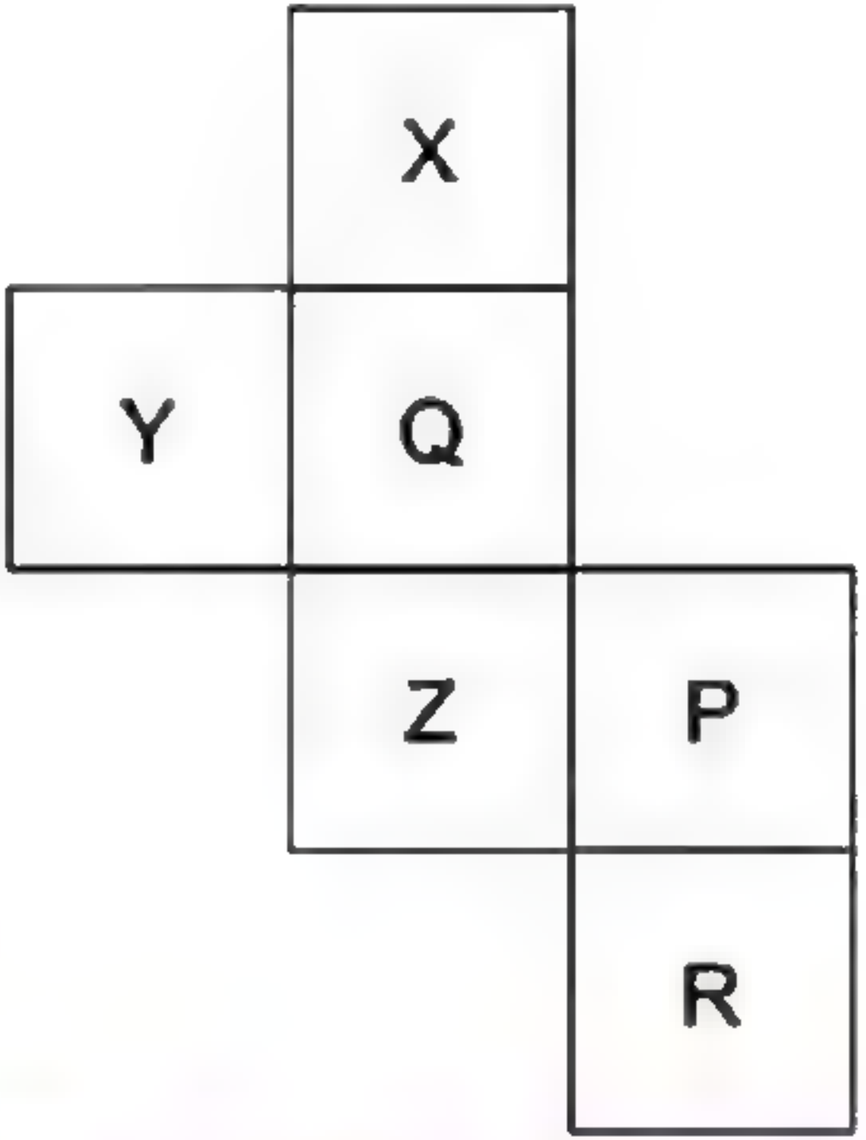

IGacademy Download App in PlayStore SUBSCRIBE IshwarGiri ಪಾಠಶಾಲೆ 8660070677

❖ ತೆರೆದ ದಾಳದ ಮುಖಗಳು ಒಂದೇ ನೇರ ರೇಖೆಯಲ್ಲಿದ್ದರೆ, ಪರ್ಯಾಯ ಮುಖಗಳು ಒಂದಕ್ಕೊಂದು ಅಭಿಮುಖವಾಗಿರುತ್ತವೆ.

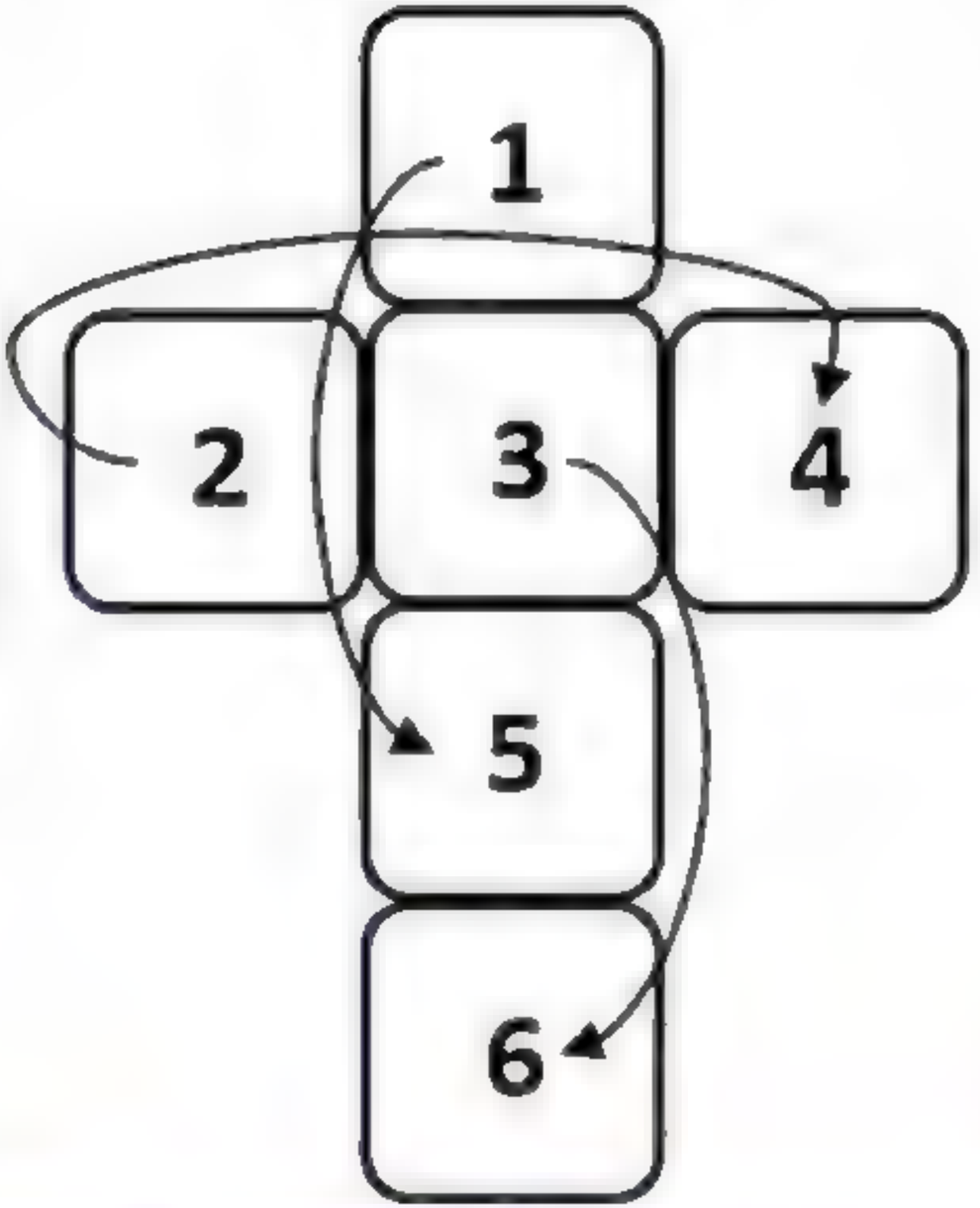

2 ⟷ 4

1 ⟷ 5

3 ⟷ 6

IGacademy Download App in PlayStore | SUBSCRIBE IshwarGiri ಪಾಠಶಾಲೆ | 8660070677

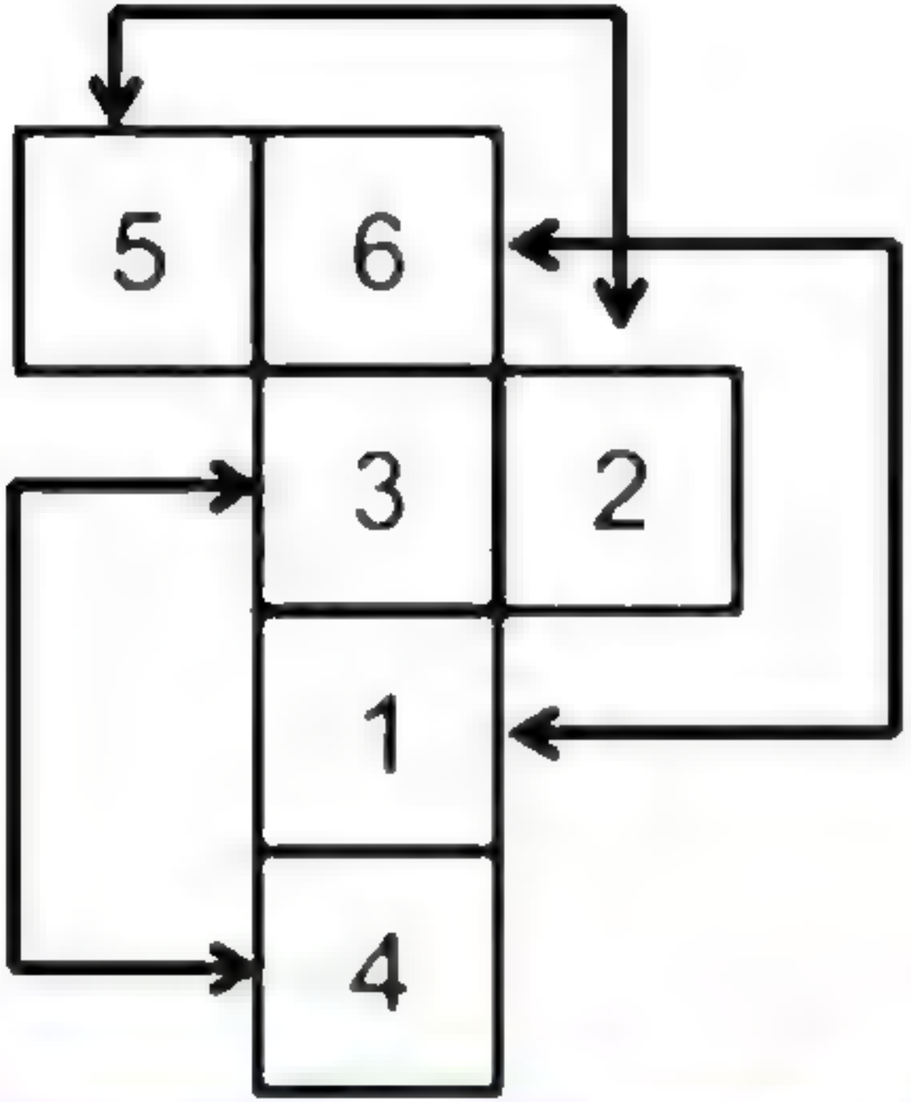

6 ⟷ 1

3 ⟷ 4

5 ⟷ 2

IGacademy Download App in PlayStore | SUBSCRIBE IshwarGiri ಪಾಠಶಾಲೆ | 8660070677

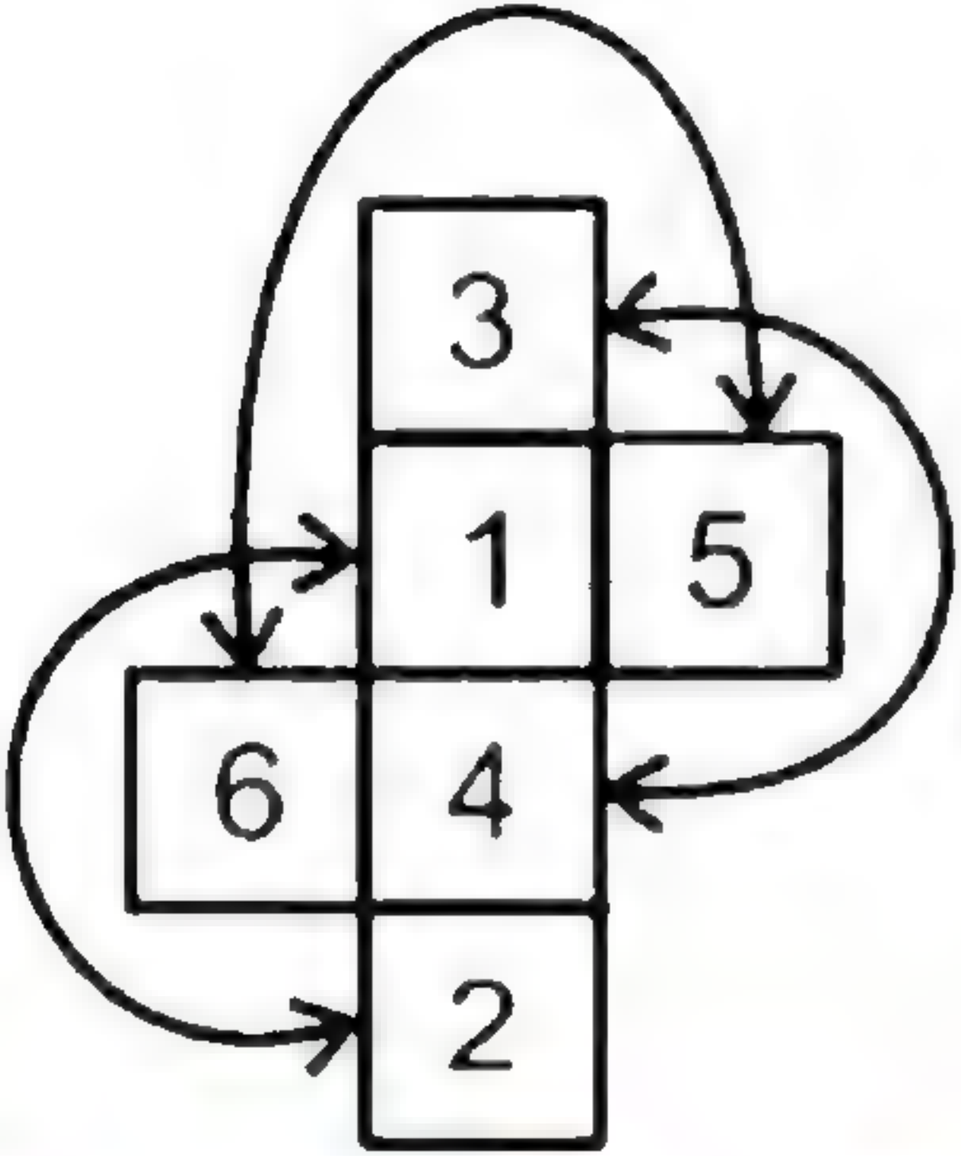

2 ⟷ 5

1 ⟷ 5

3 ⟷ 6

IGacademy Download App in PlayStore | SUBSCRIBE IshwarGiri ಪಾಠಶಾಲೆ | 8660070677

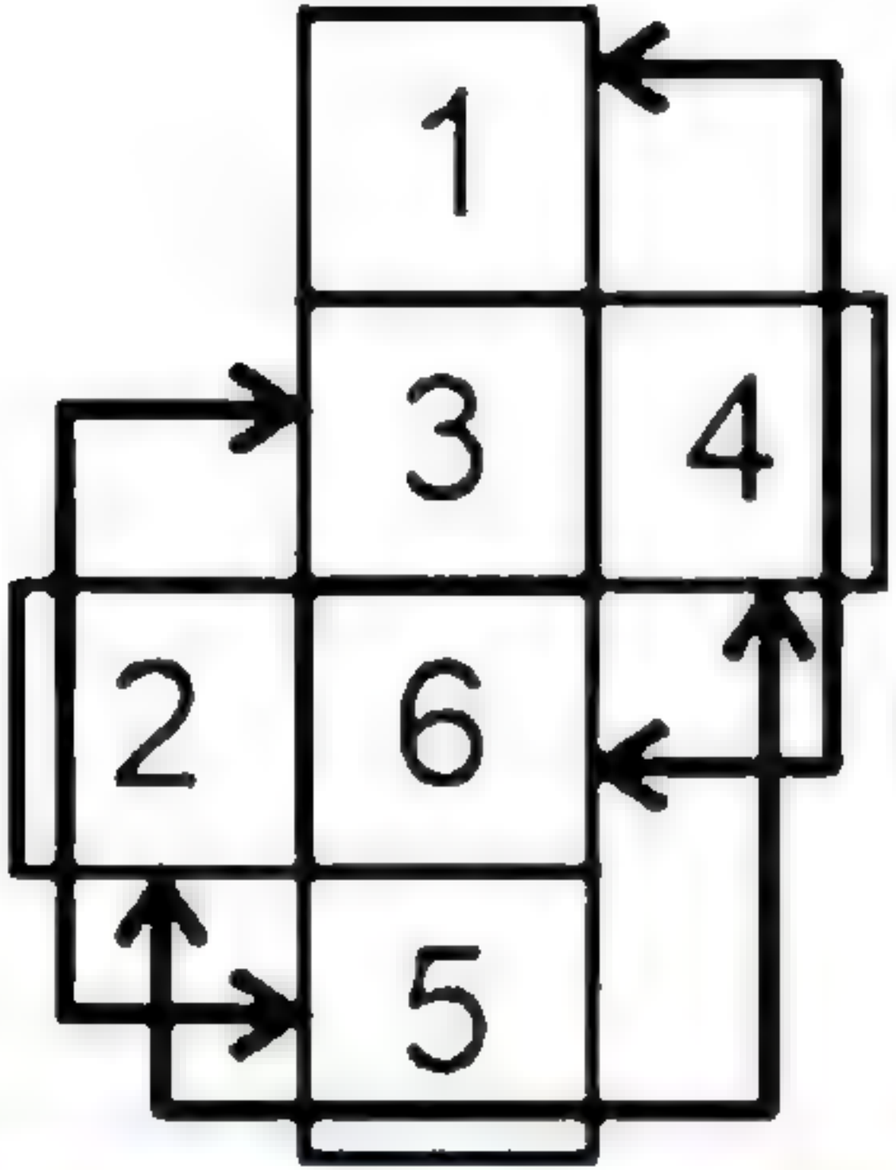

1 ⟷ 6

3 ⟷ 5

2 ⟷ 4

IGacademy Download App in PlayStore | SUBSCRIBE IshwarGiri ಪಾಠಶಾಲೆ | 8660070677

Q. Find out the correct option which is related to the given open dice

ಕೊಟ್ಟಿರುವ ತೆರೆದ ದಾಳಕ್ಕೆ ಸಂಬಂಧಿಸಿದ ಸರಿಯಾದ ಆಯ್ಕೆ ಕಂಡುಕೊಳ್ಳಿ

(a) 1 = 4, 2 = 5, 3 = 6

(b) 1 = 3, 2 = 5, 4 = 6 ✓

(c) 1 = 6, 2 = 5, 3 = 4

(d) 1 = 6, 2 = 4, 3 = 5

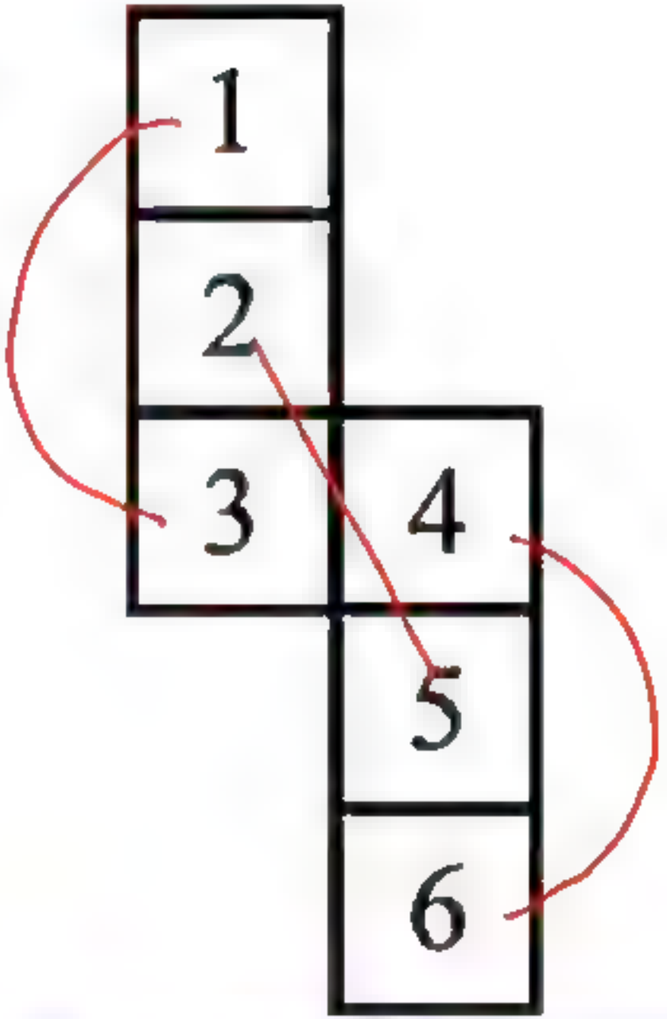

IGacademy Download App in PlayStore | SUBSCRIBE IshwarGirl ಪಾಠಶಾಲೆ | 8660070677

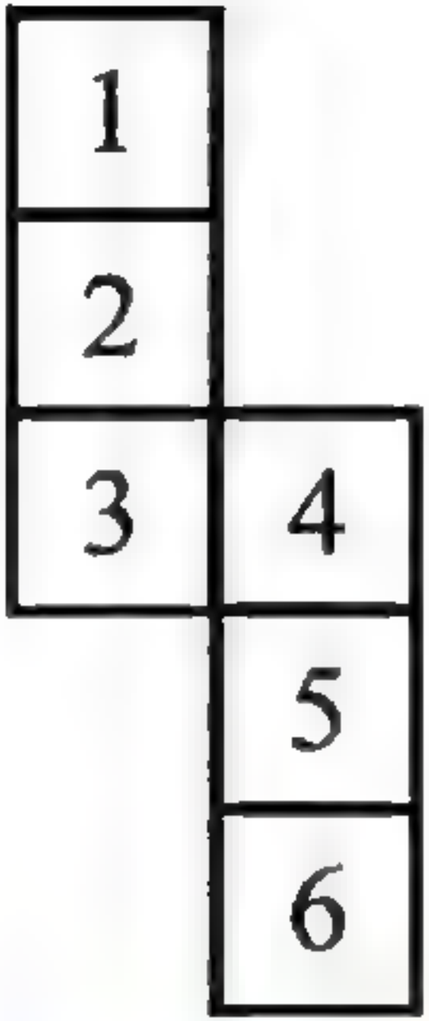

IGacademy Download App in PlayStore SUBSCRIBE IshwarGirl ಪಾಠಶಾಲೆ 8660070677

Q. Find out the correct option which is related to the given open dice

ಕೊಟ್ಟಿರುವ ತೆರೆದ ದಾಳಕ್ಕೆ ಸಂಬಂಧಿಸಿದ ಸರಿಯಾದ ಆಯ್ಕೆಯನ್ನು ಕಂಡುಕೊಳ್ಳಿ

(a) 1 = 5, 2 = 4, 3 = 6

(b) 1 = 6, 2 = 4, 3 = 5

(c) 1 = 4, 2 = 5, 3 = 6

(d) 1 = 2, 3 = 6, 4 = 5

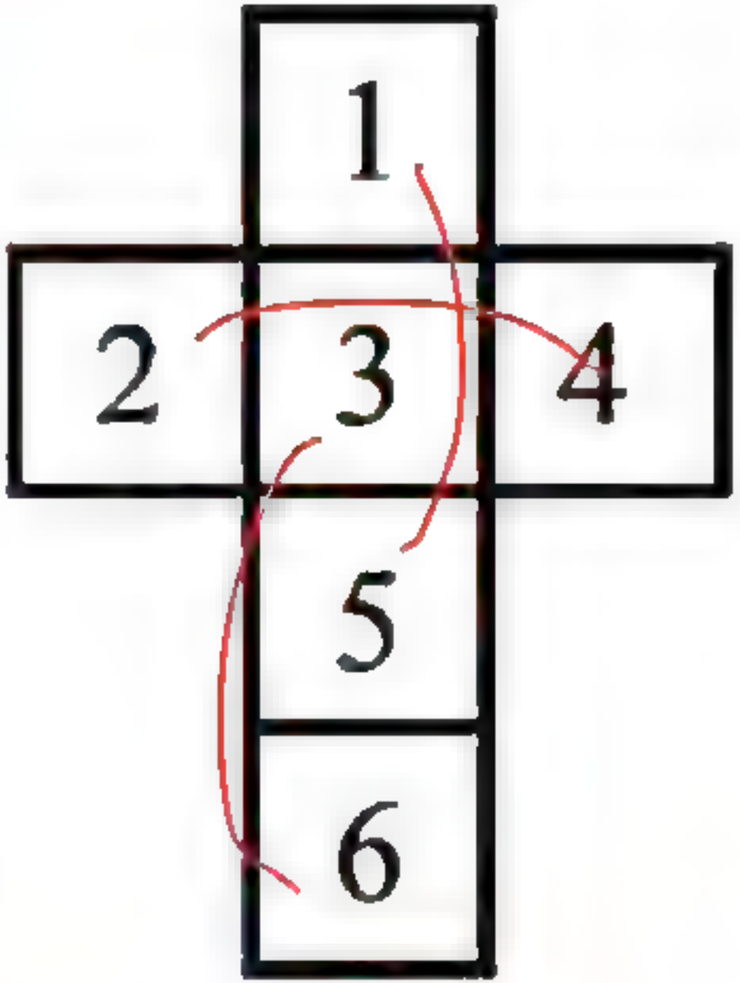

IGacademy Download App in PlayStore | SUBSCRIBE IshwarGirl ಪಾಠಶಾಲೆ | 8660070677

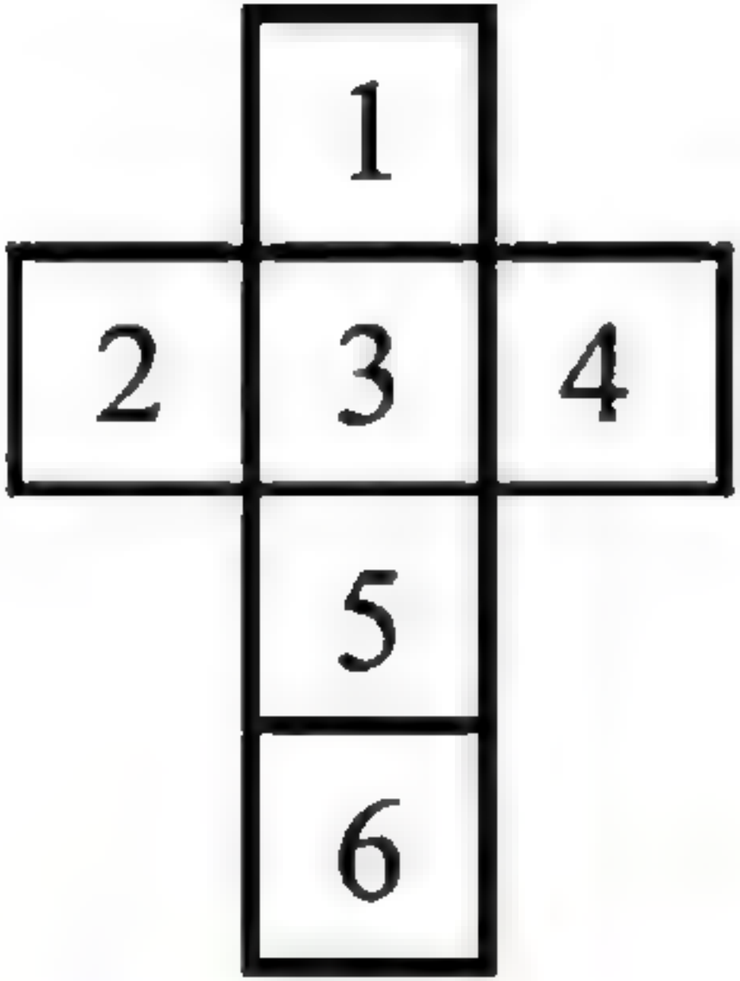

IGacademy Download App in PlayStore | SUBSCRIBE IshwarGiri ಪಾಠಶಾಲೆ | 8660070677

Q. Find out the correct option which is related to the given open dice

ಕೊಟ್ಟಿರುವ ತೆರೆದ ದಾಳಕ್ಕೆ ಸಂಬಂಧಿಸಿದ ಸರಿಯಾದ ಆಯ್ಕೆಯನ್ನು ಕಂಡುಕೊಳ್ಳಿ

(a) 1 = 5, 2 = 4, 3 = 6

(b) 1 = 6, 2 = 4, 3 = 5

(c) 1 = 2, 4 = 5, 3 = 6

(d) 1 = 3, 6 = 2, 4 = 5

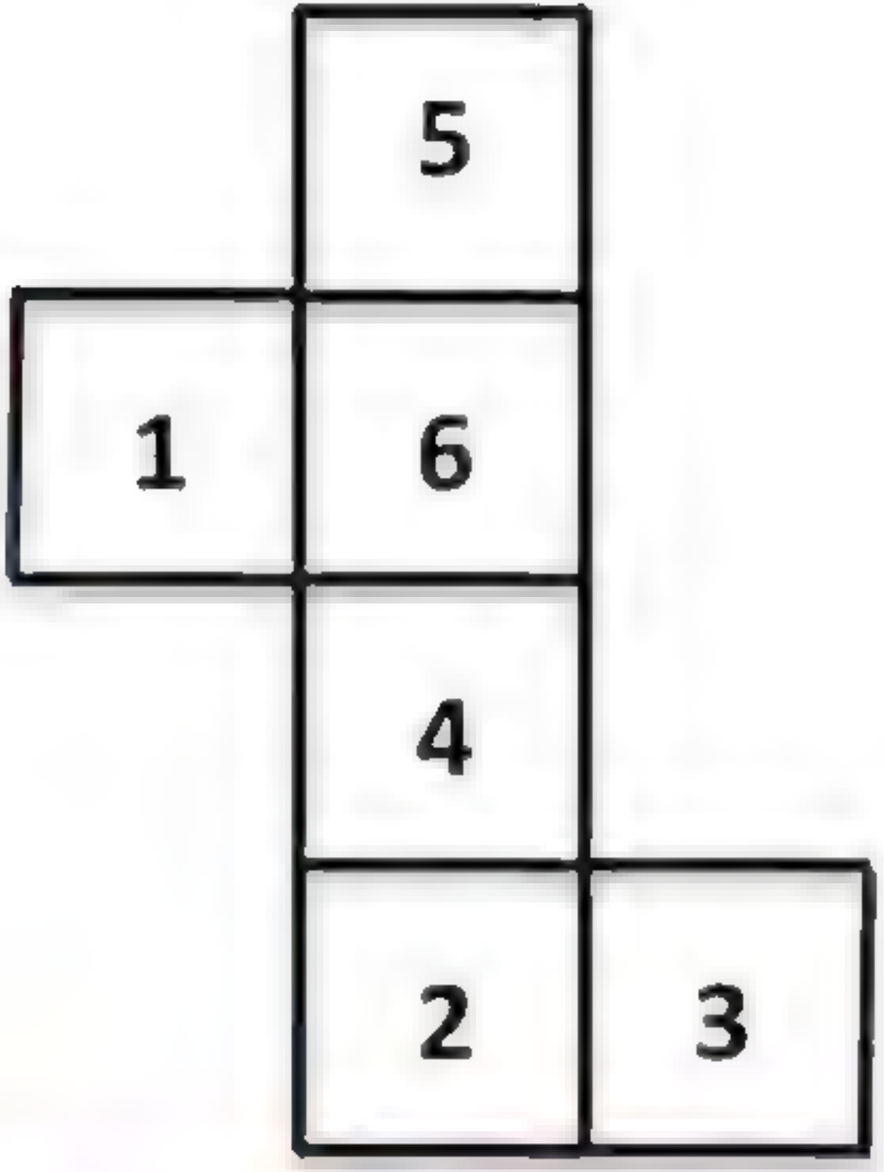

IGacademy Download App in PlayStore | SUBSCRIBE IshwarGiri ಪಾಠಶಾಲೆ | 8660070677

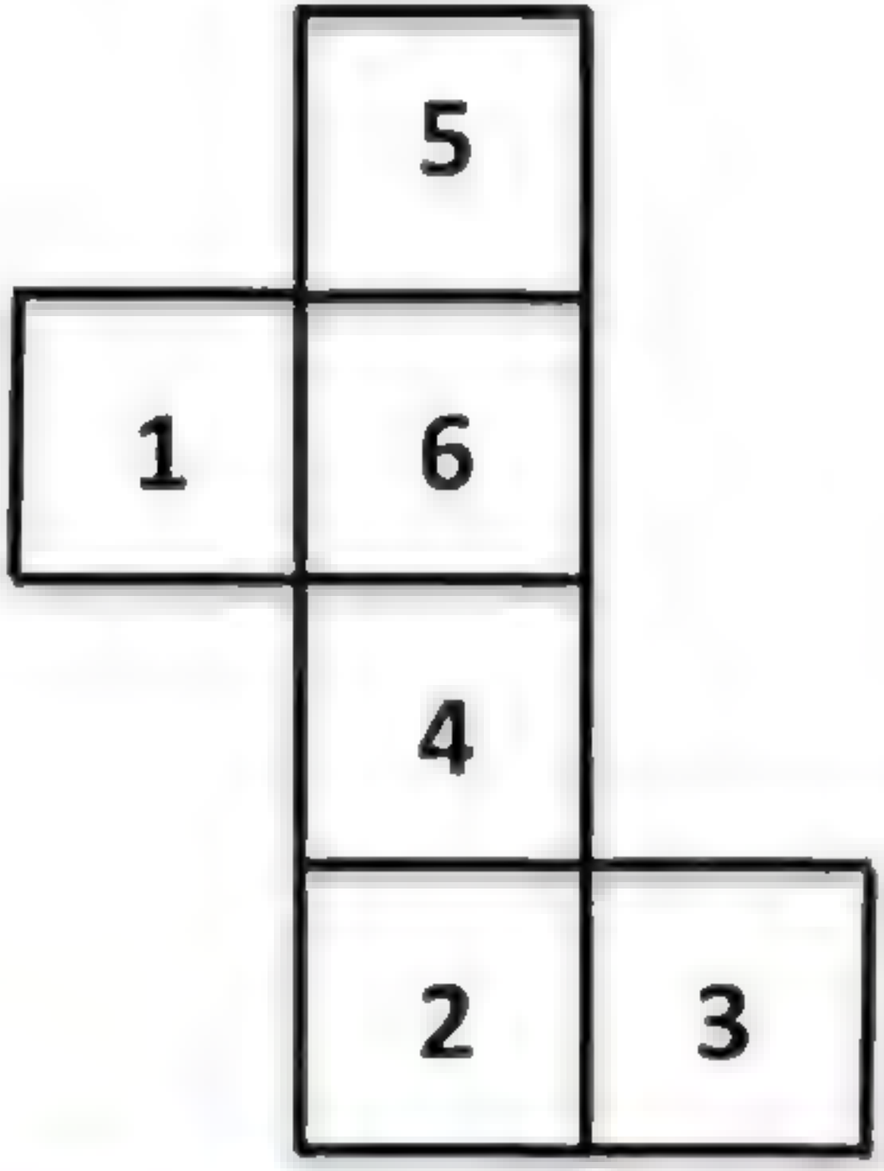

IGacademy Download App in PlayStore SUBSCRIBE IshwarGiri ಪಾಠಶಾಲೆ 8660070677

Q. If the figure is folded to form a cube, what would be the face opposite to $?

ದಾಳವನ್ನು ರೂಪಿಸಲು ಆಕೃತಿಯನ್ನು ಮಡಿಚಿದಾಗ, $ ಕ್ಕೆ ವಿರುದ್ಧವಾದ ಮುಖ ಯಾವುದು?

a) +
b) -
c) #
d) %

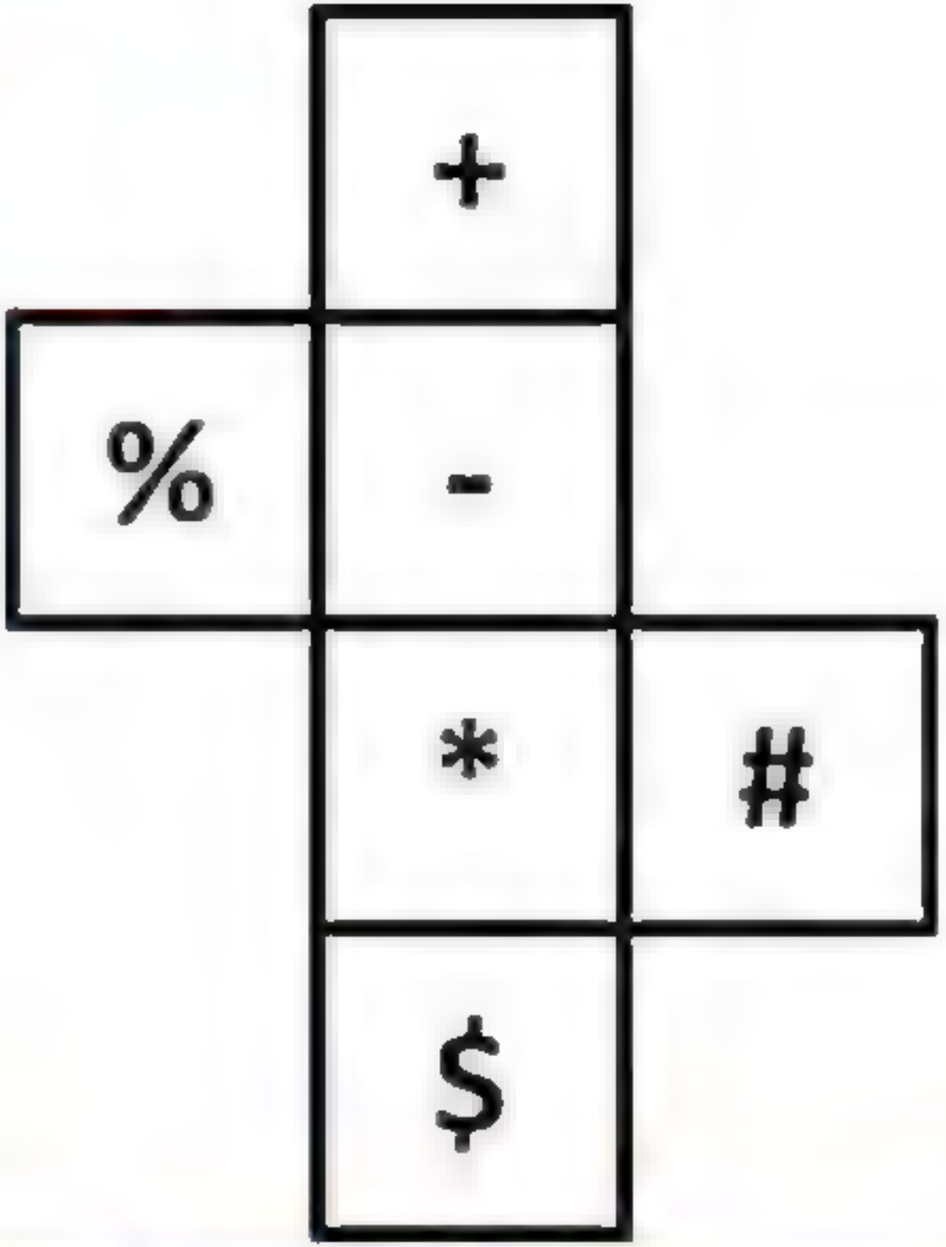

IGacademy Download App in PlayStore | SUBSCRIBE IshwarGiri ಪಾಠಶಾಲೆ | 8660070677

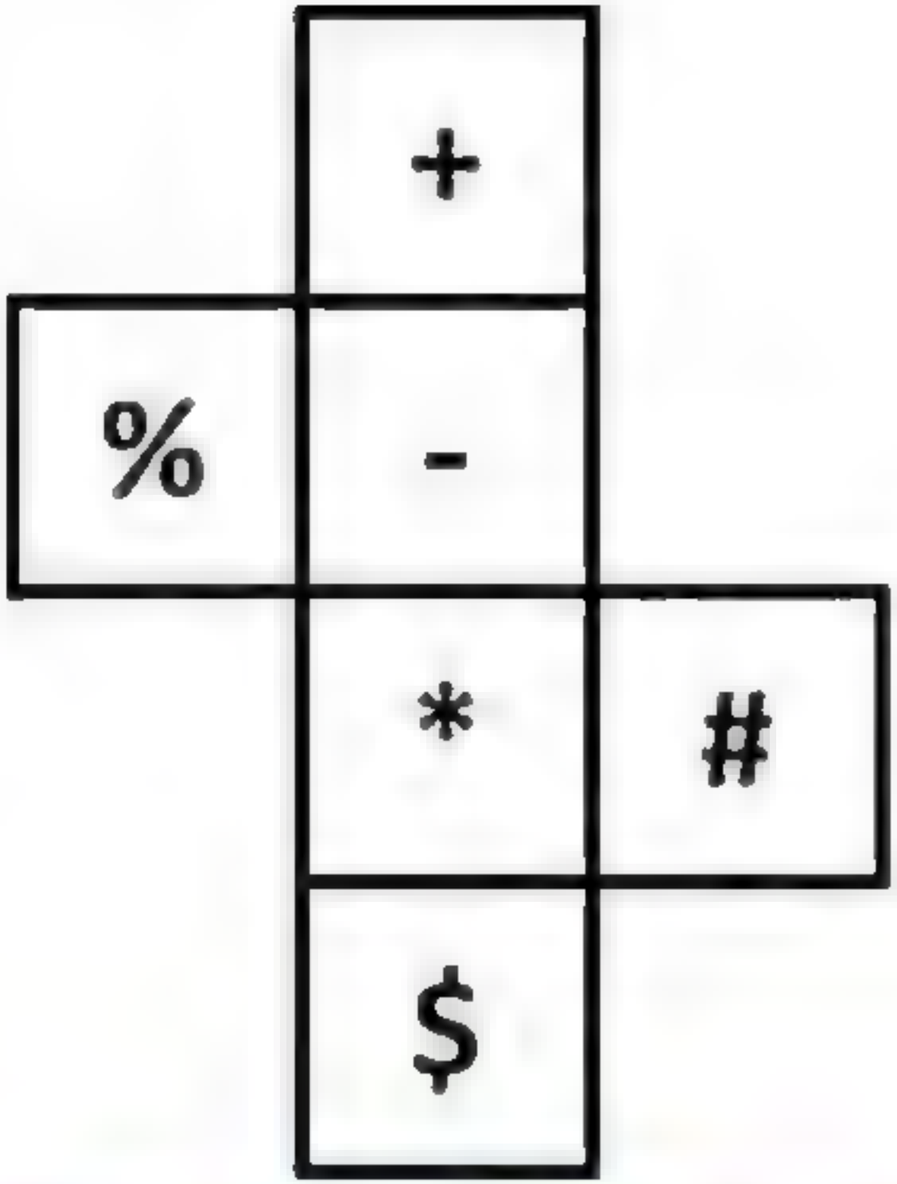

IGacademy Download App in PlayStore SUBSCRIBE IshwarGiri ಪಾಠಶಾಲೆ 8660070677

Q. If the figure is folded to form a cube, what would be the face opposite to II ?

ದಾಳವನ್ನು ರೂಪಿಸಲು ಆಕೃತಿಯನ್ನು ಮಡಿಚಿದಾಗ, II ಕ್ಕೆ ವಿರುದ್ಧವಾದ ಮುಖ ಯಾವುದು?

a)

b) *

c) ₹

d) =

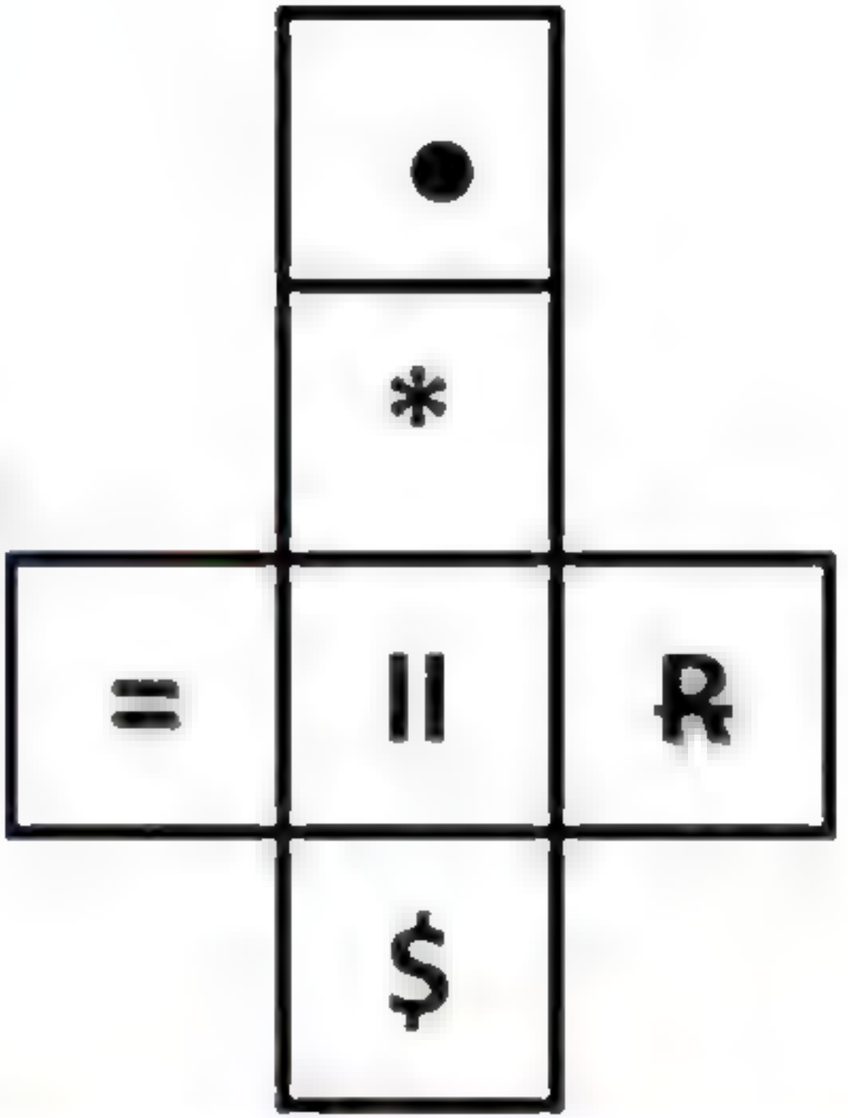

IGacademy Download App in PlayStore | SUBSCRIBE IshwarGirl ಪಾಠಶಾಲೆ | 8660070677

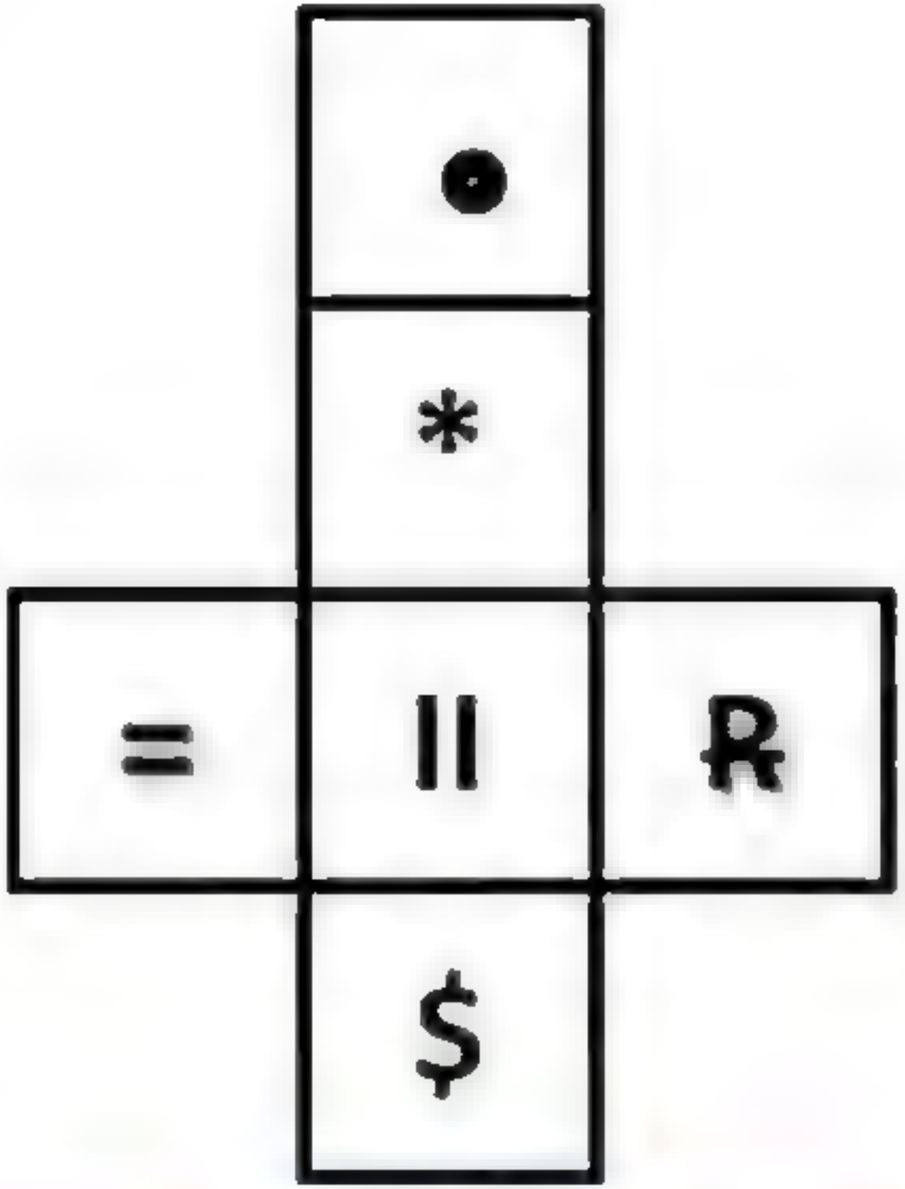

IGacademy Download App in PlayStore SUBSCRIBE IshwarGiri ಪಾಠಶಾಲೆ 8660070677

Q. If the figure is folded to form a cube, what would be the face opposite to W?
ದಾಳವನ್ನು ರೂಪಿಸಲು ಆಕೃತಿಯನ್ನು ಮಡಿಚಿದಾಗ, W ಗೆ ವಿರುದ್ಧವಾದ ಮುಖ ಯಾವುದು?

a) R
b) G
c) B
d)O

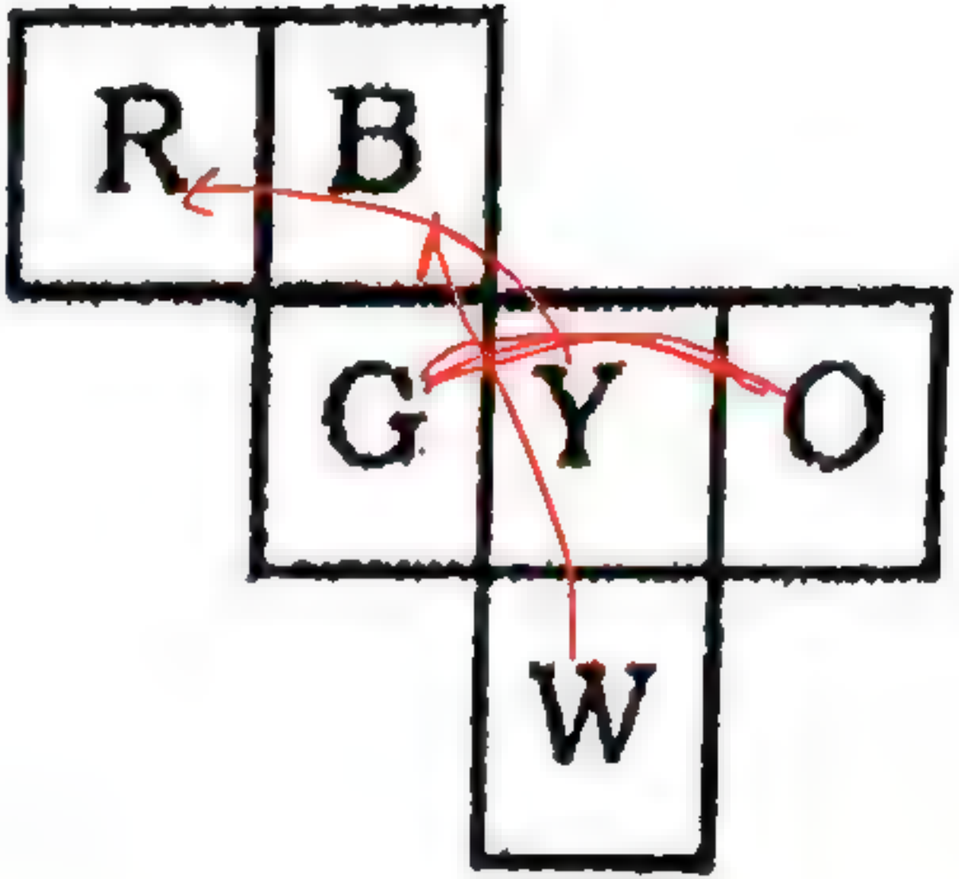

G — O
W — B
Y — R

IGacademy Download App in PlayStore | SUBSCRIBE IshwarGiri ಪಾಠಶಾಲೆ | 8660070677

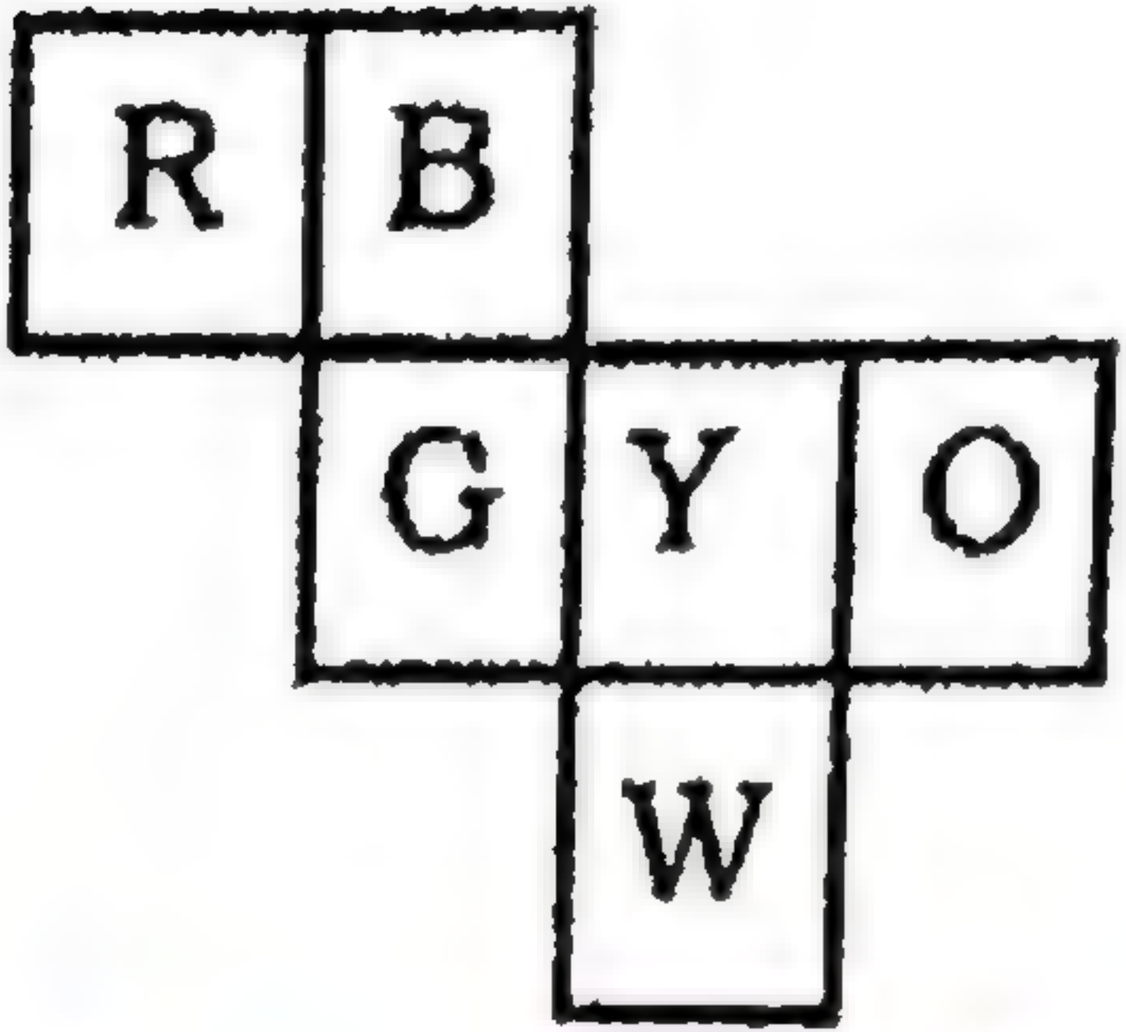

IGacademy Download App in PlayStore SUBSCRIBE IshwarGiri ಪಾಠಶಾಲೆ 8660070677

Q. In a given open dice which letter is opposite to Q ?

ಕೊಟ್ಟಿರುವ ತೆರೆದ ದಾಳದಲ್ಲಿ Q ಗೆ ವಿರುದ್ಧವಾದ ಅಕ್ಷರ ಯಾವುದು?

(a) L (b) M

(c) N (d) P



IGacademy Download App in PlayStore | SUBSCRIBE IshwarGiri ಪಾಠಶಾಲೆ | 8660070677



IGacademy Download App in PlayStore SUBSCRIBE IshwarGiri ಪಾಠಶಾಲೆ 8660070677

IGacademy Download App in PlayStore SUBSCRIBE IshwarGiri ಪಾಠಶಾಲೆ 8660070677

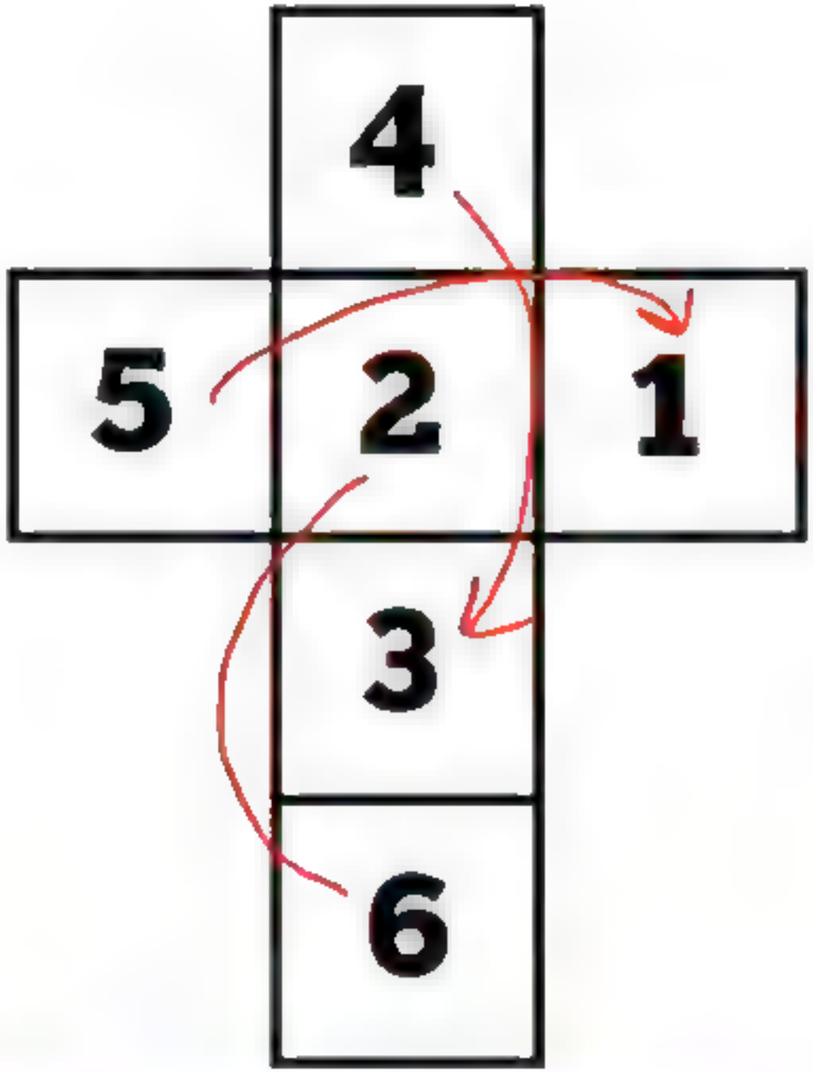

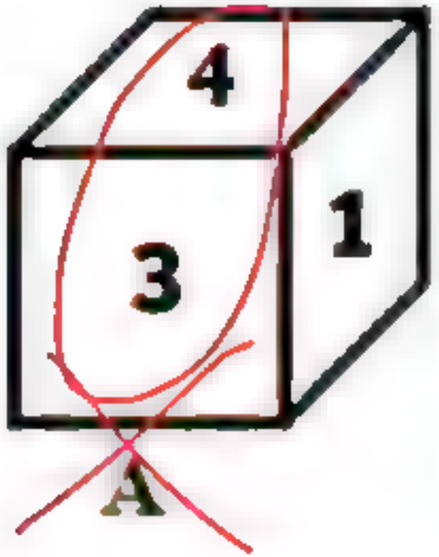

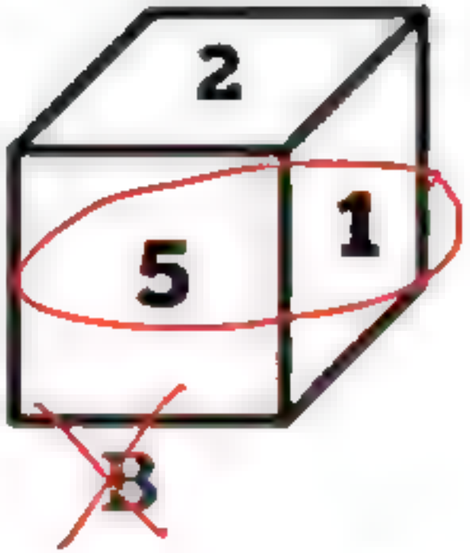

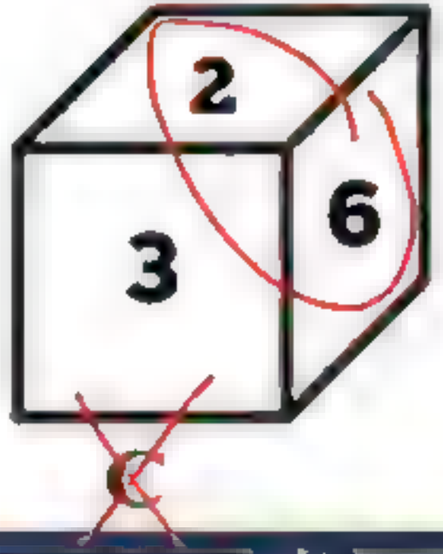

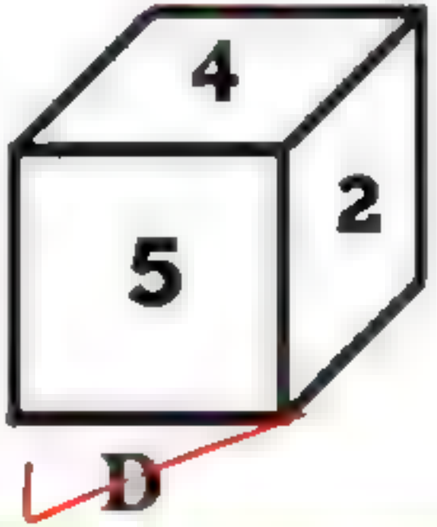

IGacademy Download App in PlayStore | SUBSCRIBE IshwarGirl ಪಾಠಶಾಲೆ | 8660070677



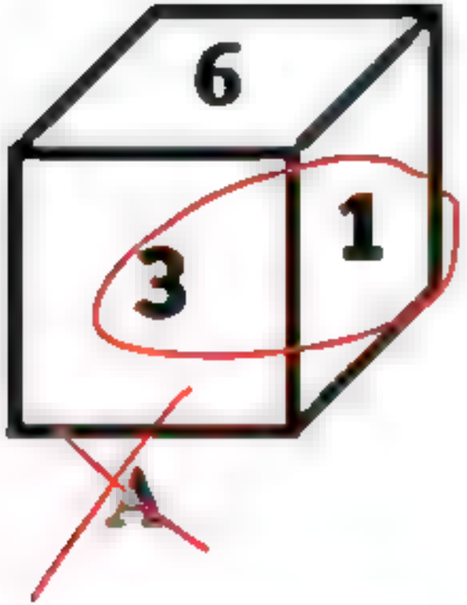

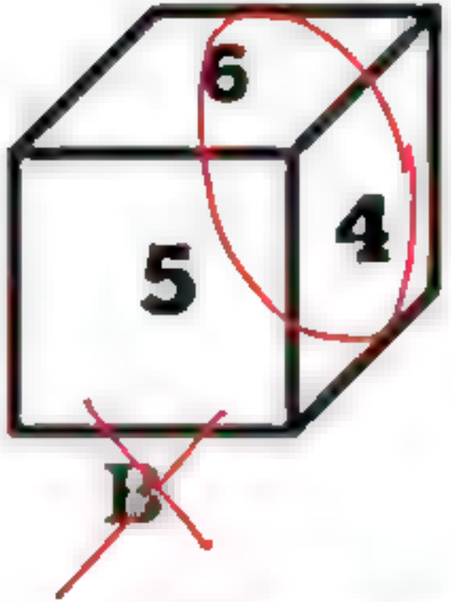

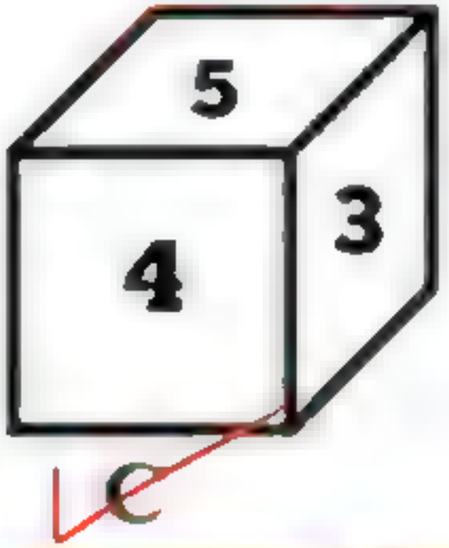

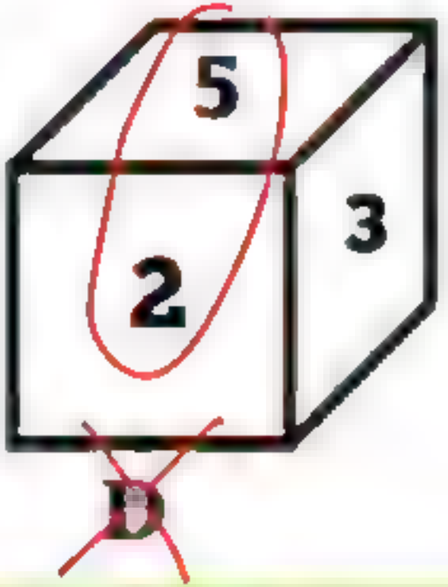

IGacademy Download App in PlayStore SUBSCRIBE IshwarGiri ಪಾಠಶಾಲೆ 8660070677

Q. Which of the dice is the correct folded image of the given open dice?
ಕೊಟ್ಟಿರುವ ತೆರೆದ ದಾಳದ ಸರಿಯಾದ ಮಡಿಚಿದ ಚಿತ್ರ ಯಾವುದು?

(a) a **(b) b** **(c) c** **(d) d**

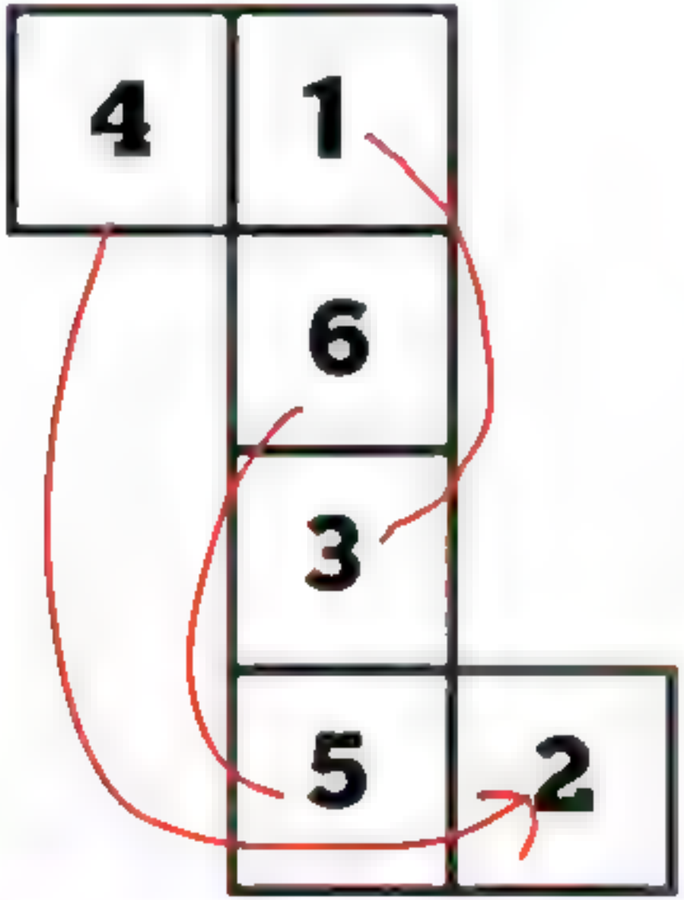

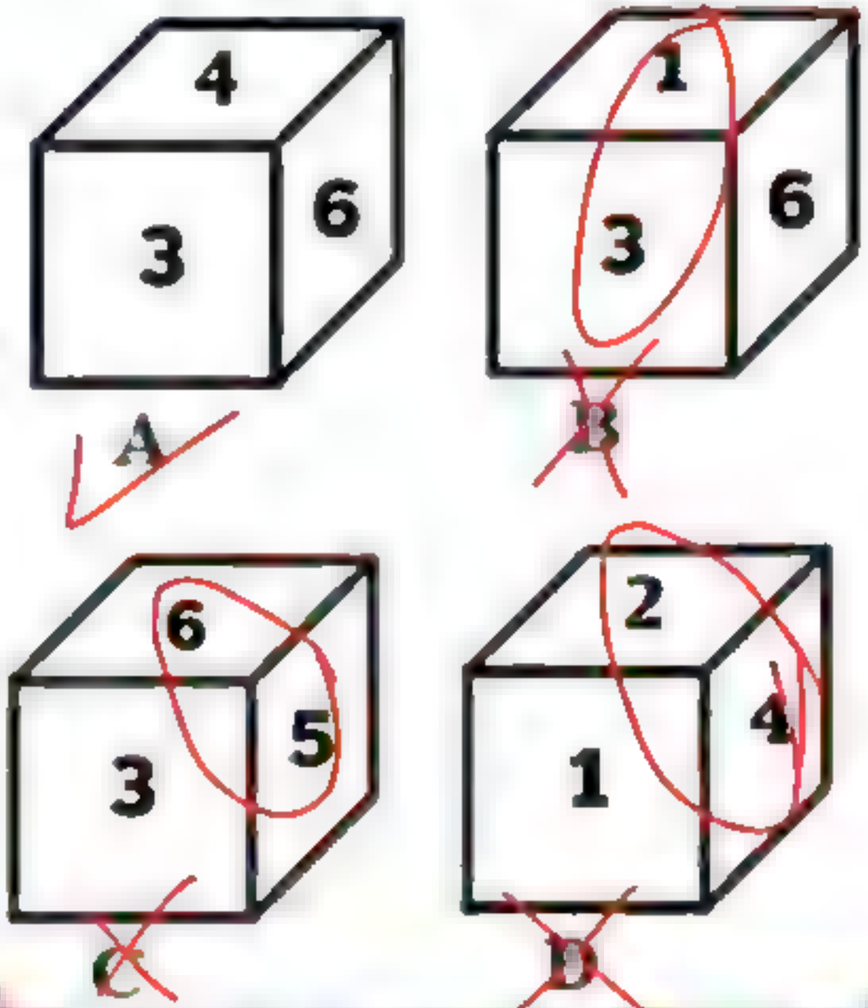

IGacademy Download App in PlayStore | SUBSCRIBE Ishwar Giri ಪಾಠಶಾಲೆ | 8660070677

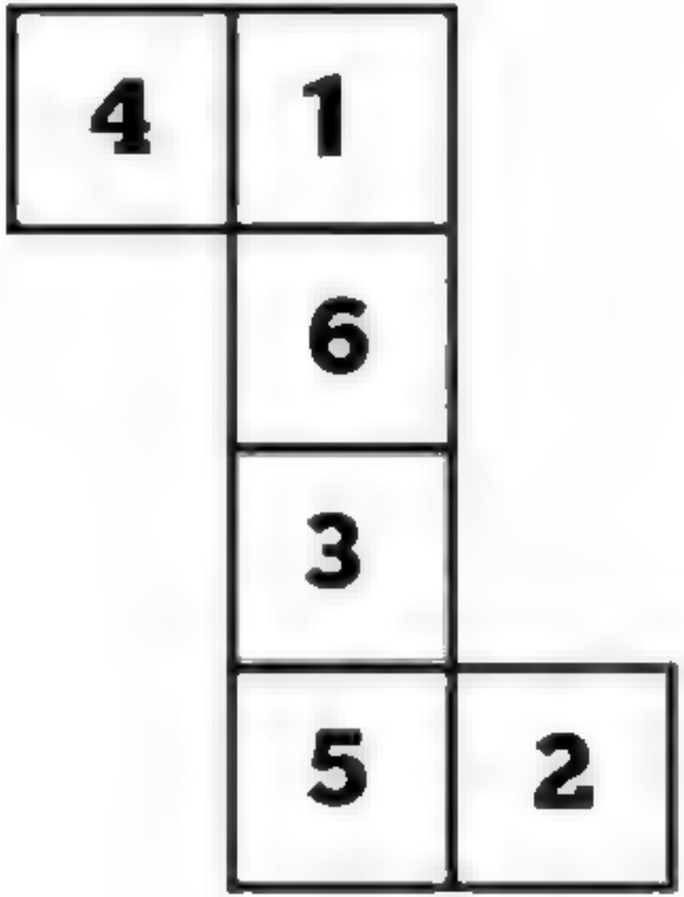

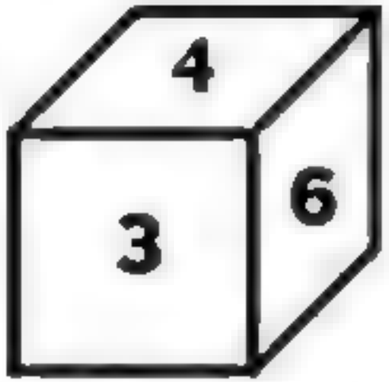

A

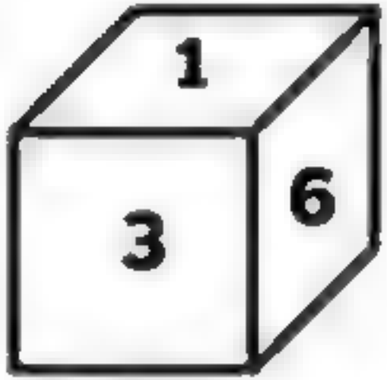

B

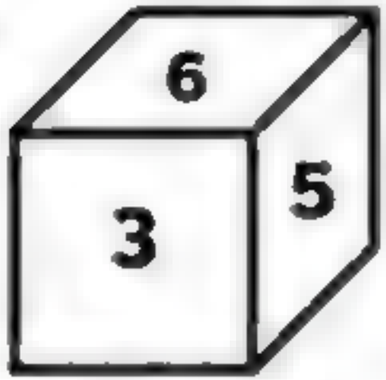

C

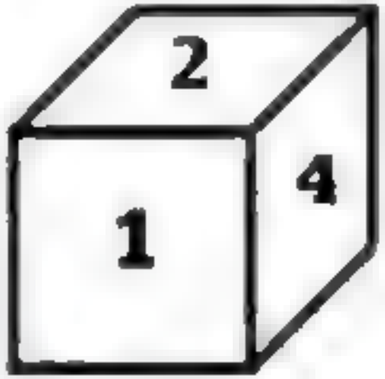

D

IGacademy Download App in PlayStore SUBSCRIBE IshwarGiri ಪಾಠಶಾಲೆ 8660070677

Q. Which of the dice is the correct folded image of the given open dice?
ಕೊಟ್ಟಿರುವ ತೆರೆದ ದಾಳದ ಸರಿಯಾದ ಮಡಿಚಿದ ಚಿತ್ರ ಯಾವುದು?

(a) a (b) b (c) c (d) d

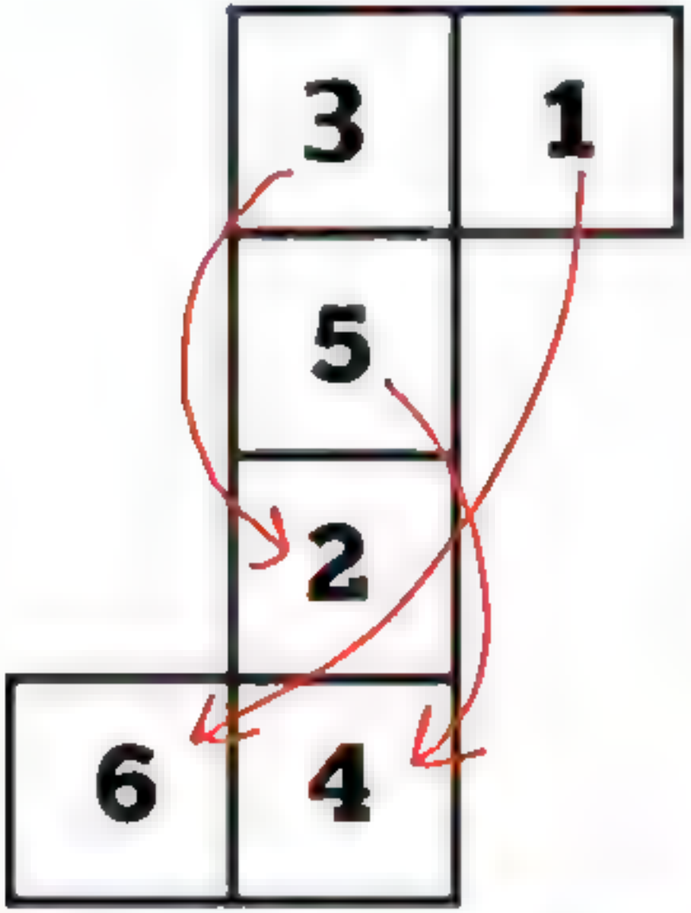

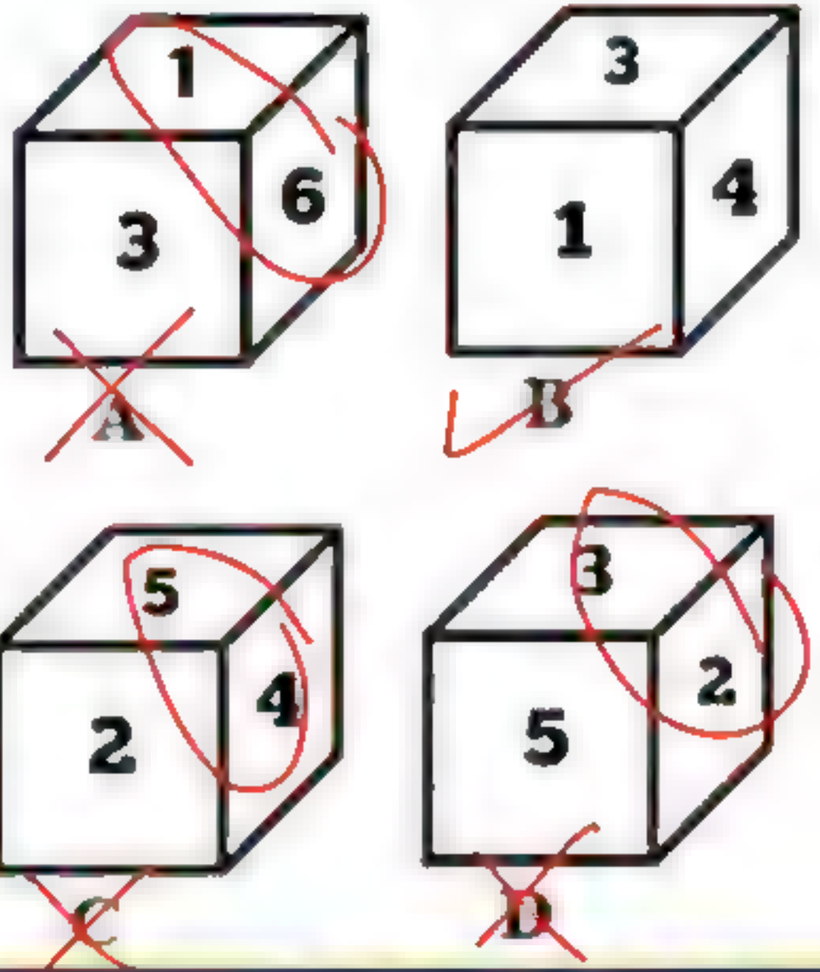

IGacademy Download App in PlayStore | SUBSCRIBE IshwarGiri ಪಾಠಶಾಲೆ | 8660070677

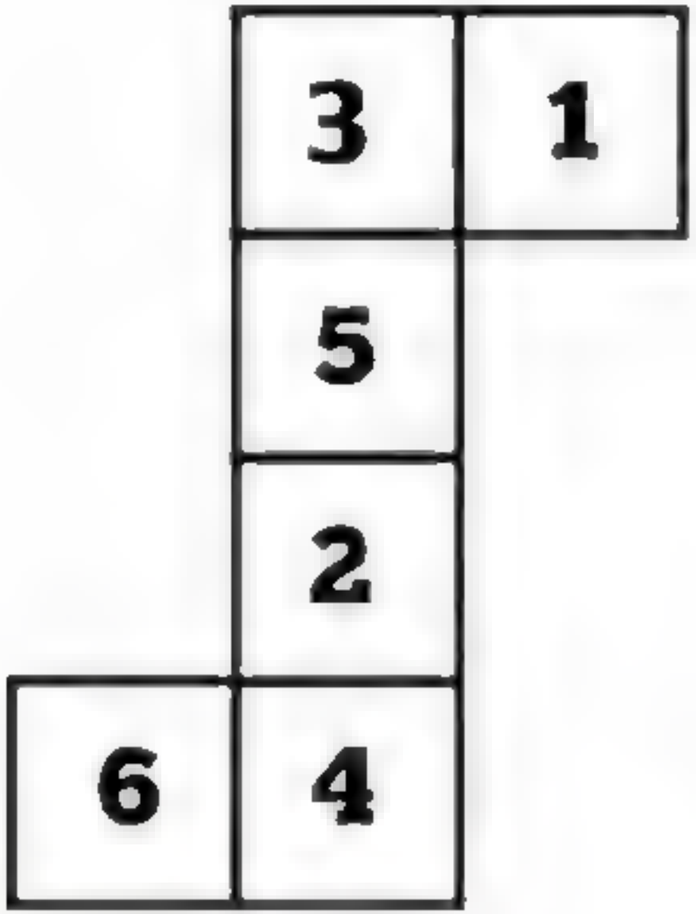

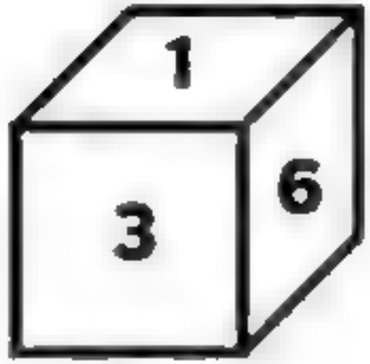

A

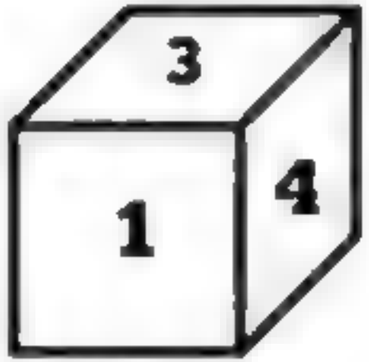

B

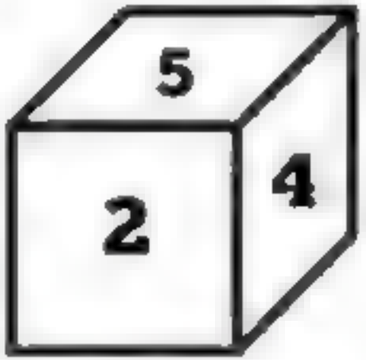

C

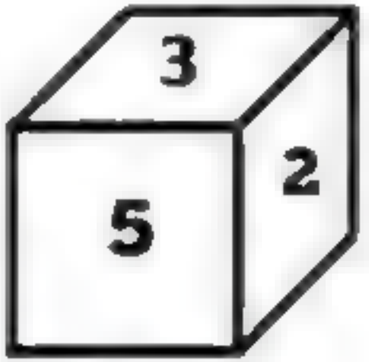

D

IGacademy Download App in PlayStore | SUBSCRIBE IshwarGirl ಪಾಠಶಾಲೆ | 8660070677

Q) The question figure is folded to form a box. Choose from the answer figures the box that is similer to the box formed.

ಪೆಟ್ಟಿಗೆ ಅನ್ನು ರೂಪಿಸಲು ಪ್ರಶ್ನೆ ಆಕೃತಿಯನ್ನು ಮಡಚಲಾಗುತ್ತದೆ. ರೂಪುಗೊಂಡ ಪೆಟ್ಟಿಗೆಗೆ, ಹೋಲುವ ಪೆಟ್ಟಿಗೆಯನ್ನು ಉತ್ತರ ಆಕೃತಿಗಳಿಂದ ಆಯ್ಕೆ ಮಾಡಿ.

(A) I **(B) II** **(C) III** **(D) IV**

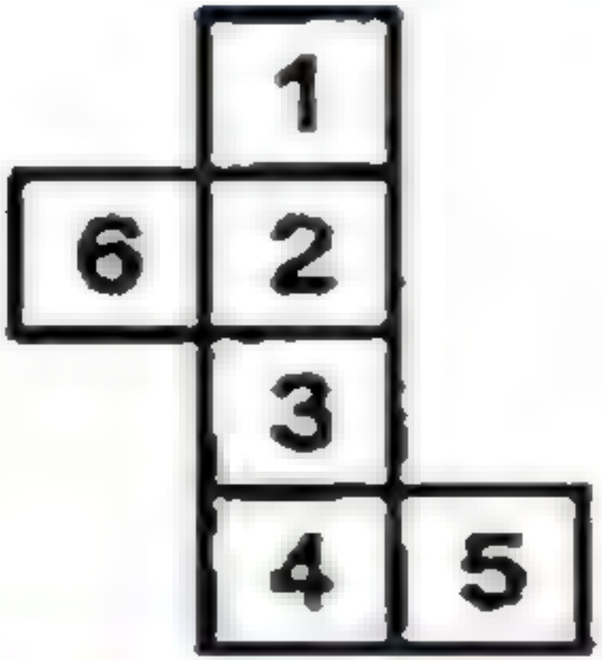

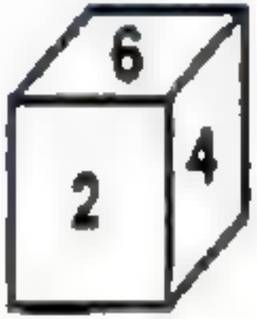

(I)

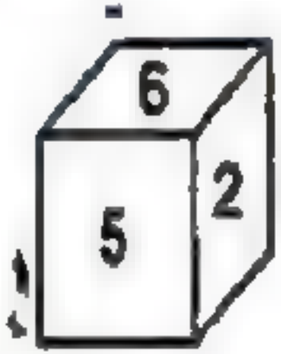

(II)

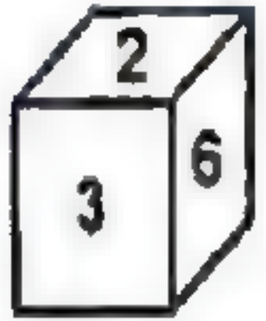

(III)

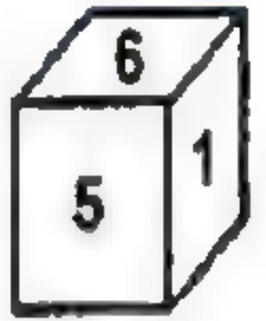

(IV)

IGacademy Download App in PlayStore | SUBSCRIBE IshwarGiri ಪಾಠಶಾಲೆ | 8660070677

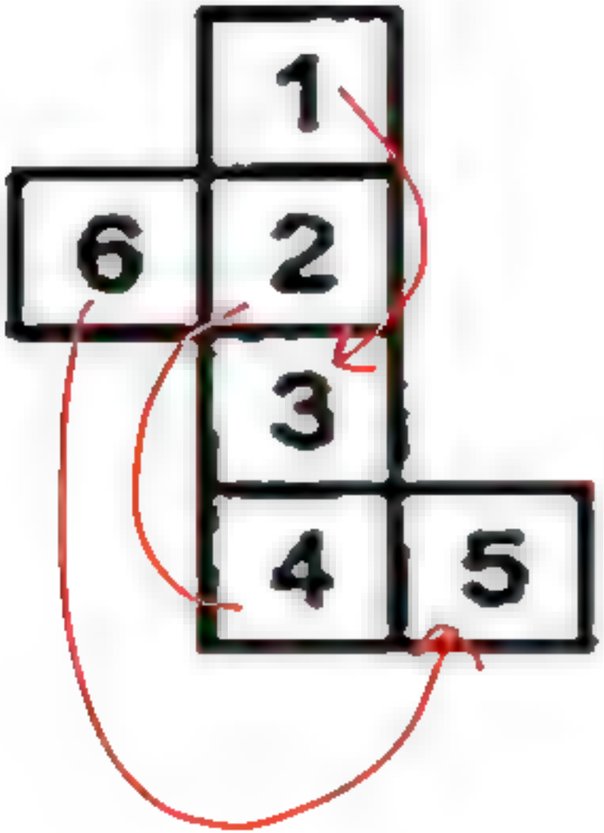

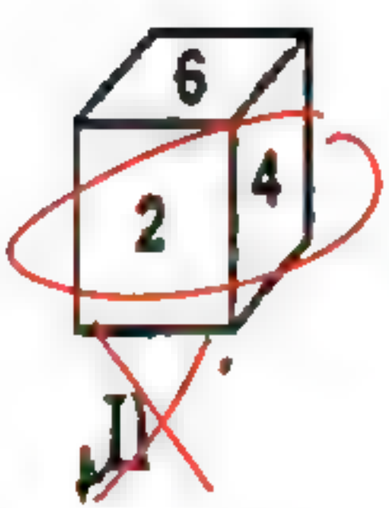

(I)

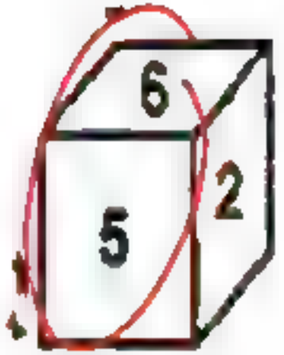

(II)

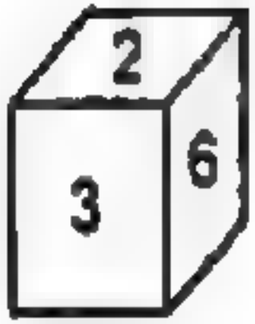

(III)

(IV)

IGacademy Download App in PlayStore | SUBSCRIBE IshwarGiri ಪಾಠಶಾಲೆ | 8660070677

Q. Which of the following dice is identical to the unfolded figure as shown below.

ಈ ಕೆಳಗಿನ ಯಾವ ದಾಳಗಳು ಕೆಳಗೆ ತೋರಿಸಿರುವ ತೆರೆದ ಆಕೃತಿ ಹೋಲುತ್ತವೆ.

a)i b) ii c)iii d)iv

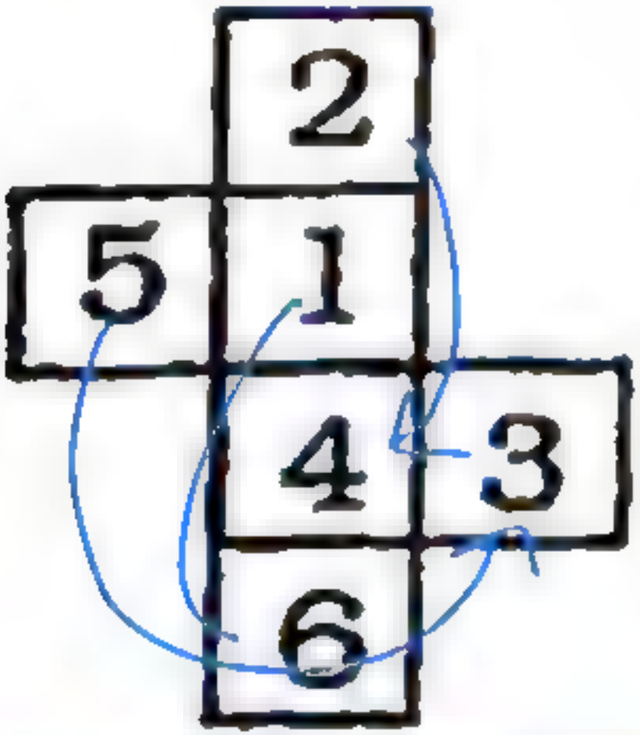

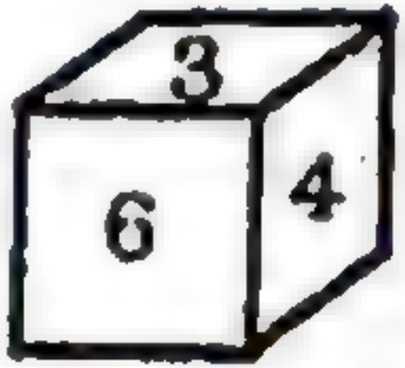

(i)

(ii)

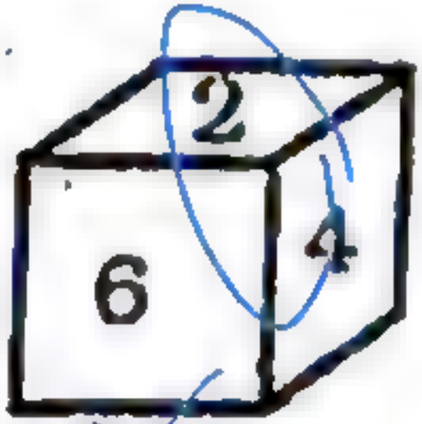

(iii)

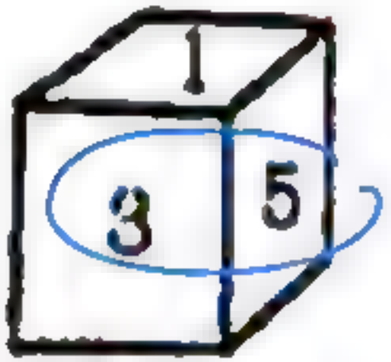

(iv)

IGacademy Download App in PlayStore | SUBSCRIBE IshwarGirl ಪಾಠಶಾಲೆ | 8660070677

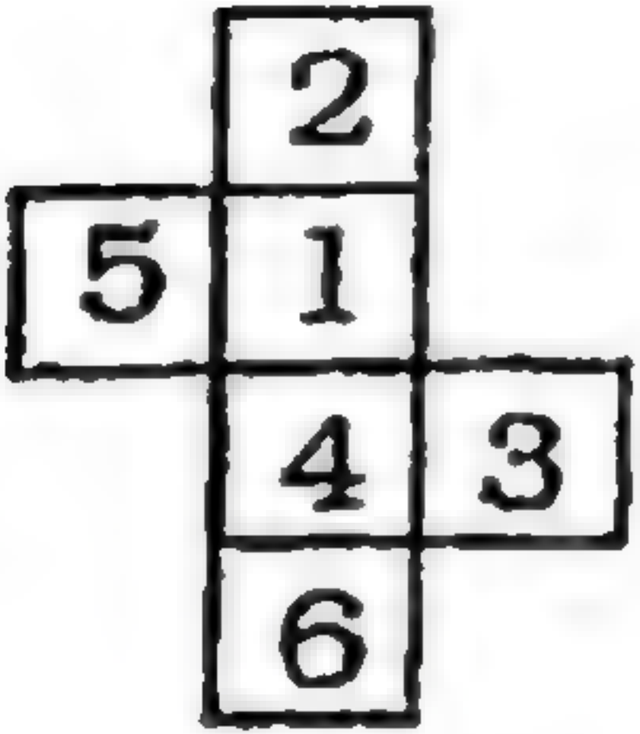

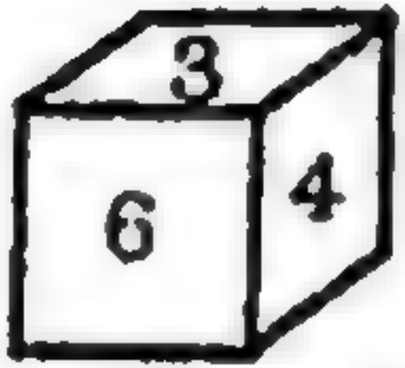

(i)

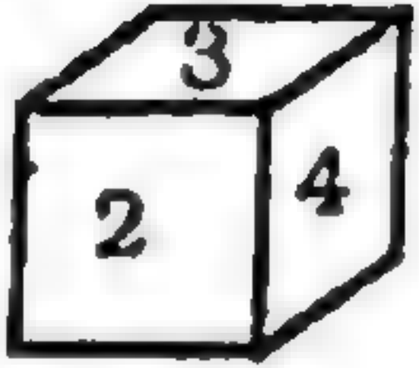

(ii)

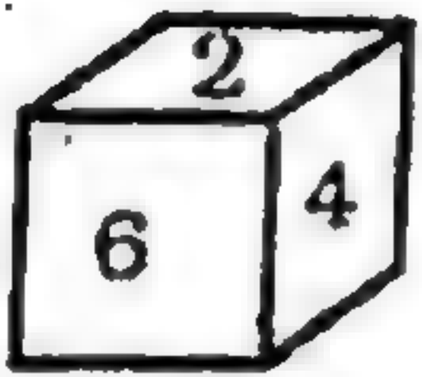

(iii)



(iv)

iGacademy Download App in PlayStore | SUBSCRIBE IshwarGirl ಪಾಠಶಾಲೆ | 8660070677

Q. Which of the dice is the correct folded image of the given open dice?
ಕೊಟ್ಟಿರುವ ತೆರೆದ ದಾಳದ ಸರಿಯಾದ ಮಡಿಚಿದ ಚಿತ್ರ ಯಾವುದು?

(a) a **(b) b** **(c) c** **(d) d**

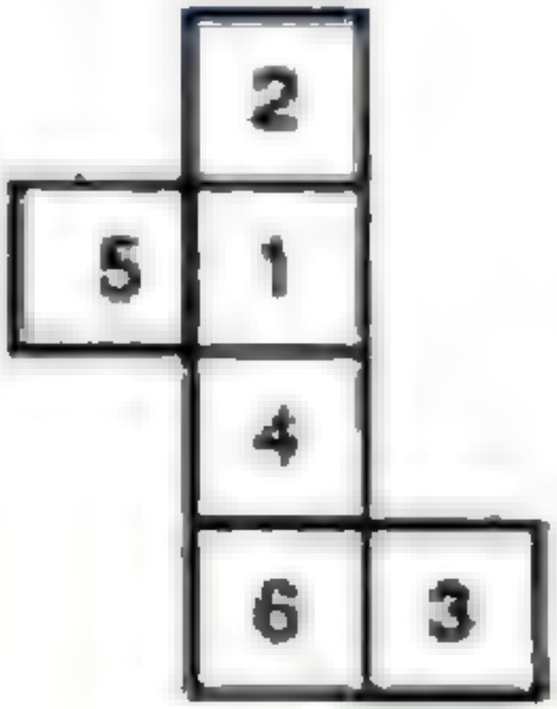

(X)



(a)



(b)



(c)

(d)

IGacademy Download App in PlayStore | SUBSCRIBE IshwarGirl ಪಾಠಶಾಲೆ | 8660070677



(X)



(a)



(b)

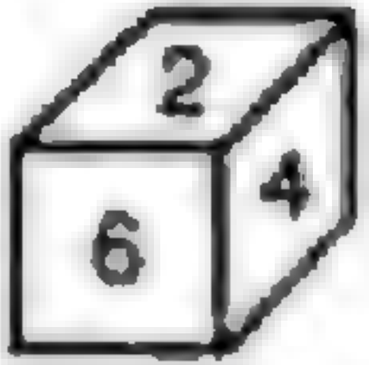

(c)

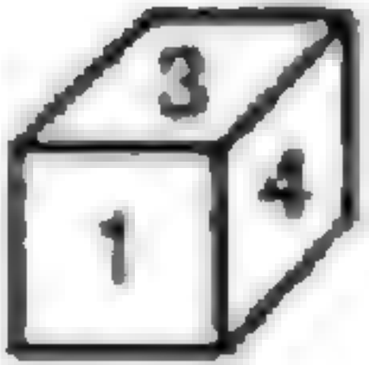

(d)

IGacademy Download App in PlayStore | SUBSCRIBE IshwarGirl ಪಾಠಶಾಲೆ | 8660070677

Q) The question figure is folded to form a box. Choose from the answer figures the box that is similer to the box formed.

ಪೆಟ್ಟಿಗೆ ಅನ್ನು ರೂಪಿಸಲು ಪ್ರಶ್ನೆ ಆಕೃತಿಯನ್ನು ಮಡಚಲಾಗುತ್ತದೆ. ರೂಪುಗೊಂಡ ಪೆಟ್ಟಿಗೆಗೆ, ಹೋಲುವ ಪೆಟ್ಟಿಗೆಯನ್ನು ಉತ್ತರ ಆಕೃತಿಗಳಿಂದ ಆಯ್ಕೆ ಮಾಡಿ.



(X)

(a)

(b)

(c)

(d)

IGacademy Download App in PlayStore | SUBSCRIBE IshwarGirl ಪಾಠಶಾಲೆ | 8660070677

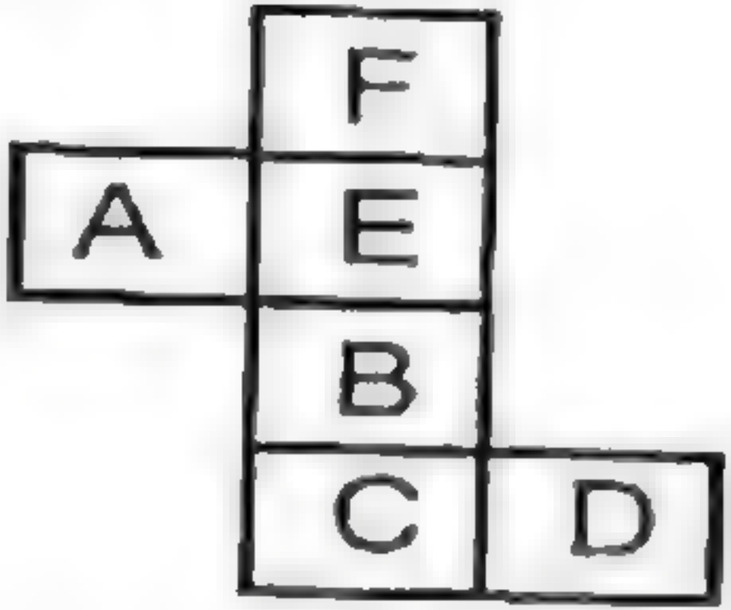

(X)

(a)

(b)

(c)

(d)

IGacademy Download App in PlayStore | SUBSCRIBE IshwarGirl ಪಾಠಶಾಲೆ | 8660070677

Q. Which of the dice is the correct folded image of the given open dice?
ಕೊಟ್ಟಿರುವ ತೆರೆದ ದಾಳದ ಸರಿಯಾದ ಮಡಿಚಿದ ಚಿತ್ರ ಯಾವುದು?

(a) a **(b) b** **(c) c** **(d) d**

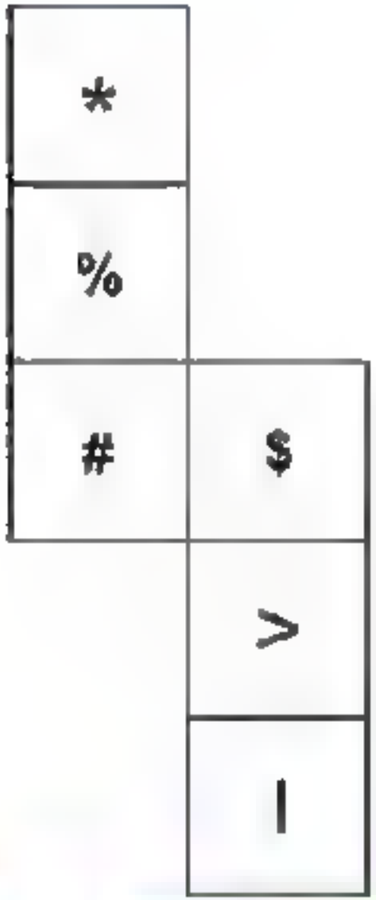

a)
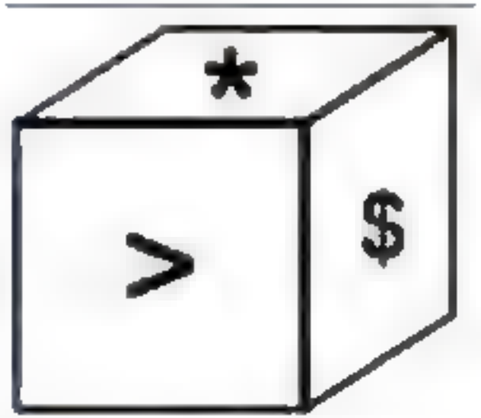

b)
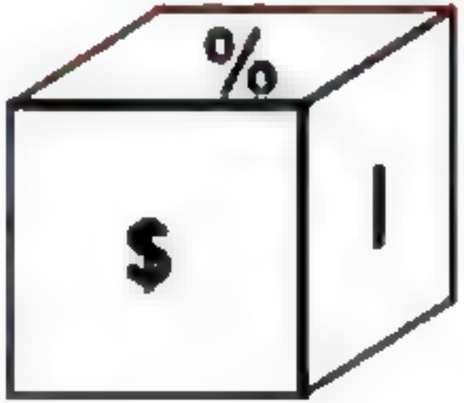

c)
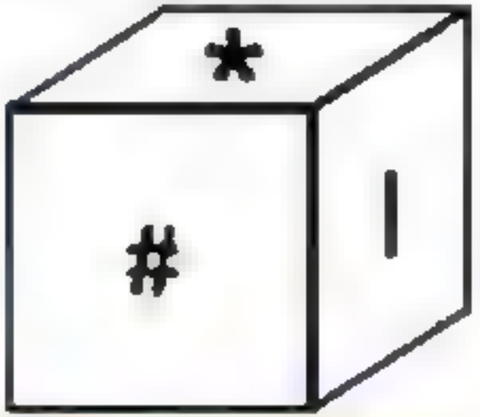

d)
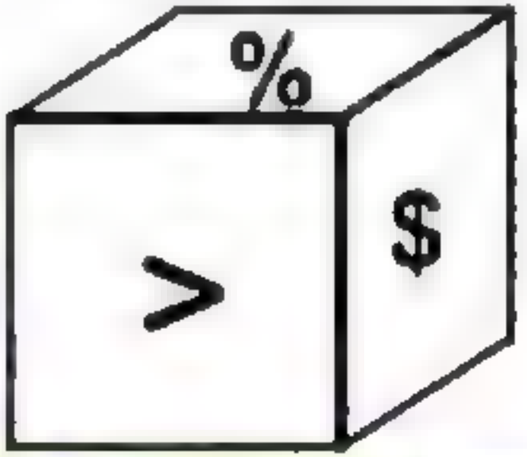

IGacademy Download App in PlayStore SUBSCRIBE IshwarGiri ಪಾಠಶಾಲೆ 8660070677

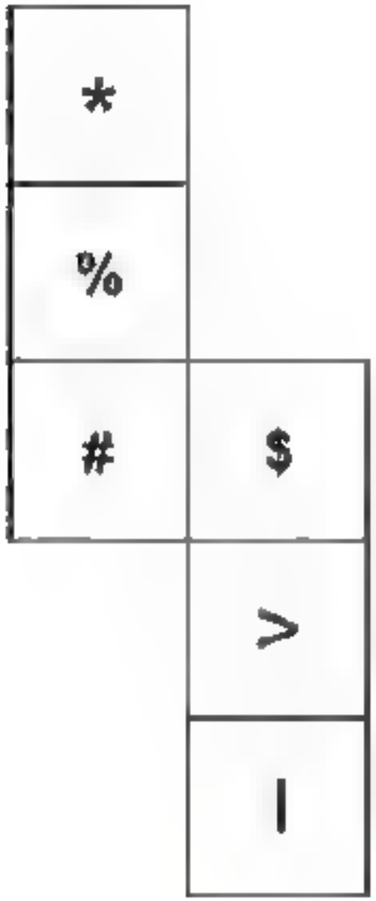

a)

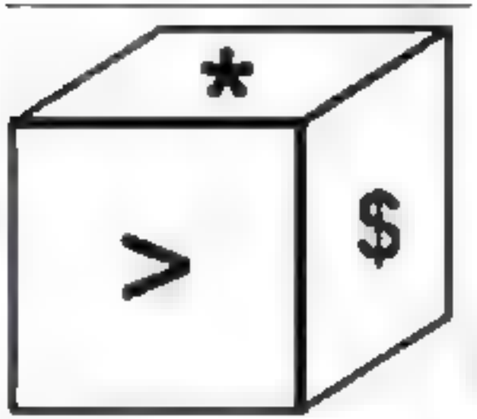

b)

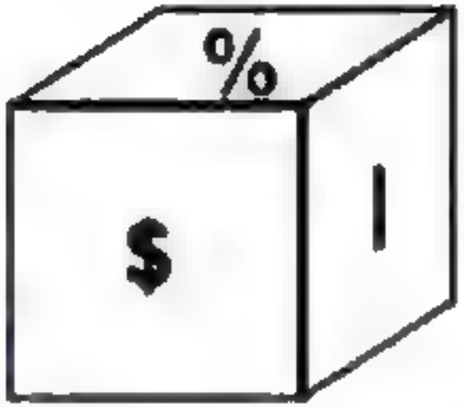

c)

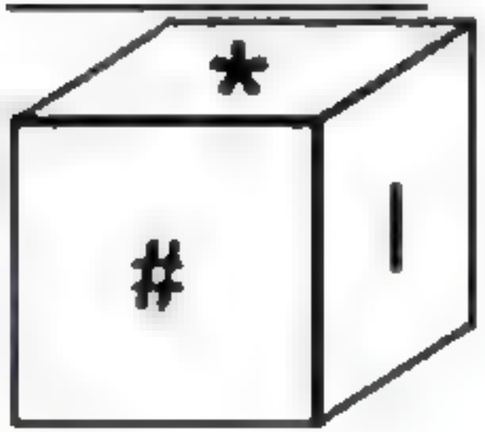

d)

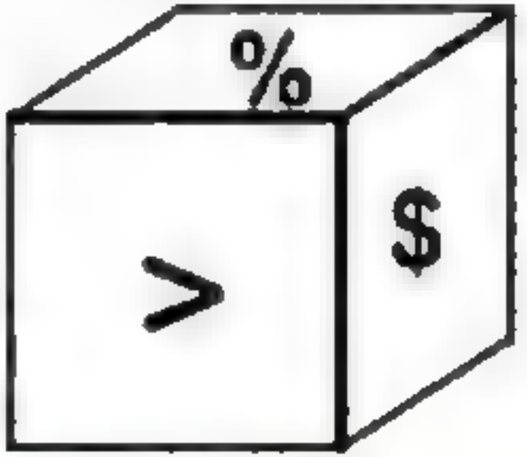

IGacademy Download App in PlayStore SUBSCRIBE IshwarGiri ಪಾಠಶಾಲೆ 8660070677

Q. Which of the following dice is identical to the unfolded figure as shown below.

ಈ ಕೆಳಗಿನ ಯಾವ ದಾಳವು ಕೆಳಗೆ ತೋರಿಸಿರುವಂತೆ ತೆರೆದ ಆಕೃತಿ ಹೋಲುತ್ತವೆ.

a) A b)B c)C d) ಯಾವುದೂ ಅಲ್ಲ

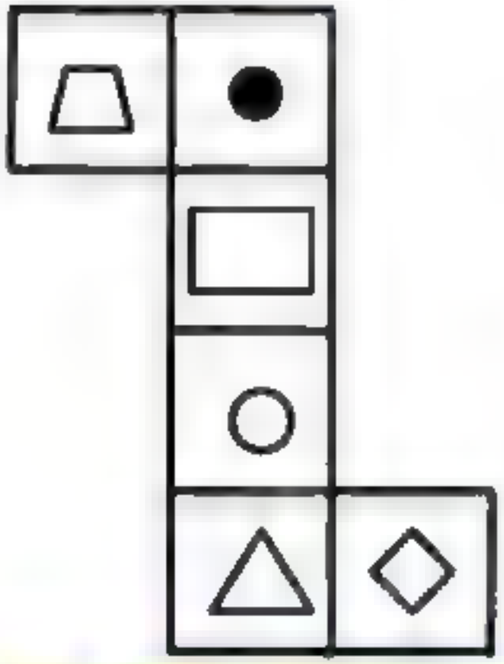

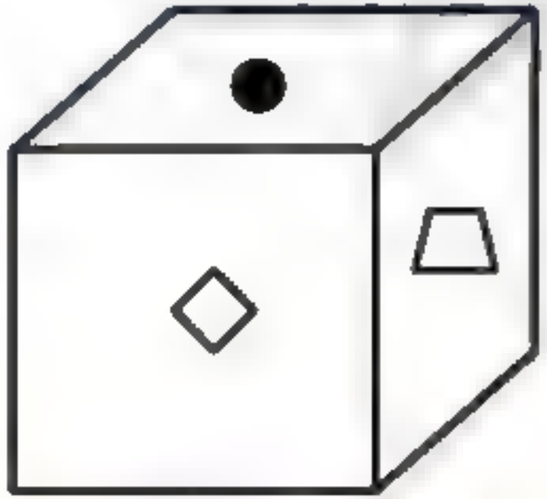

(a)

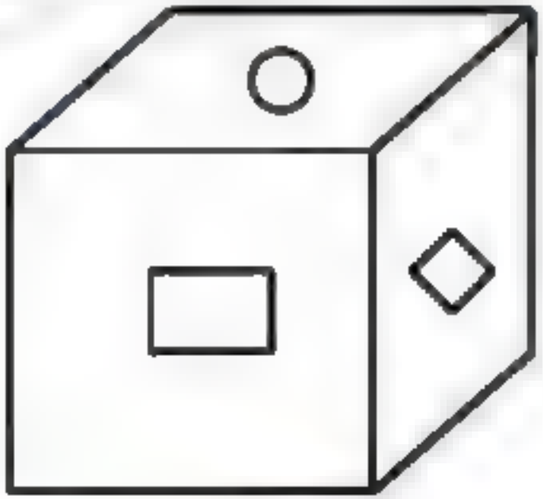

(b)

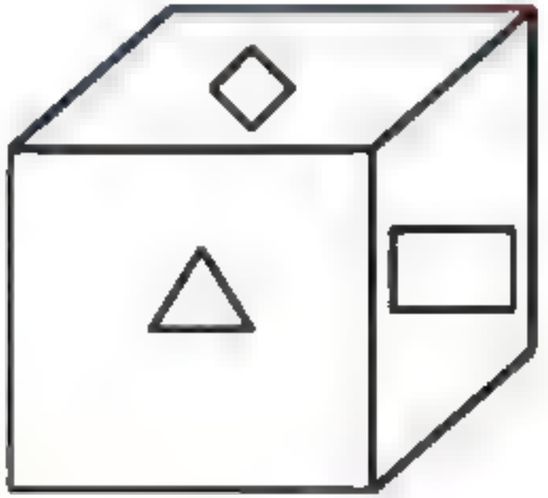

(c)

IGacademy Download App in PlayStore SUBSCRIBE IshwarGirl ಪಾಠಶಾಲೆ 8660070677

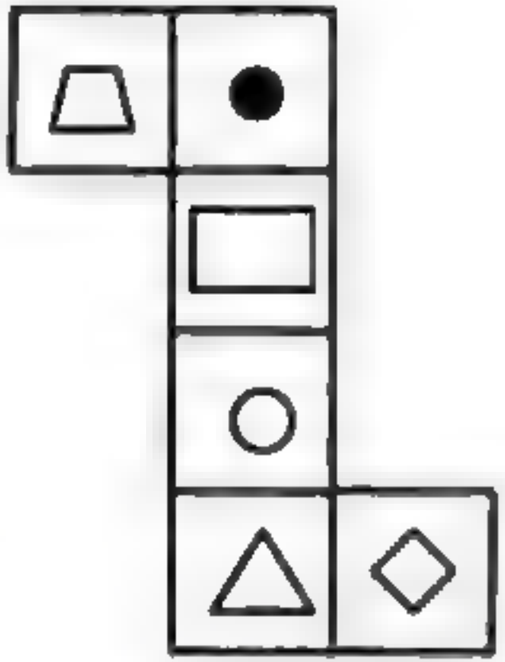

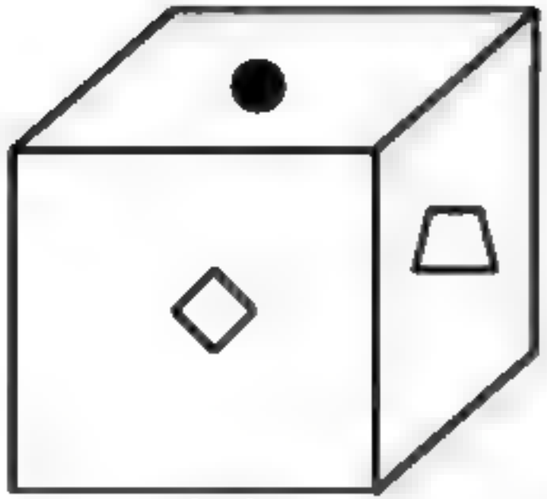

(a)

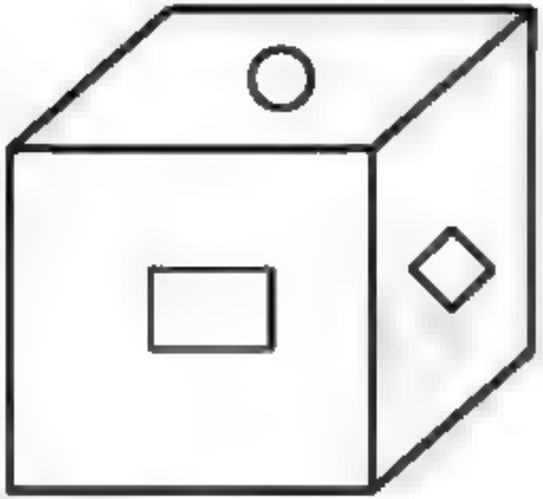

(b)

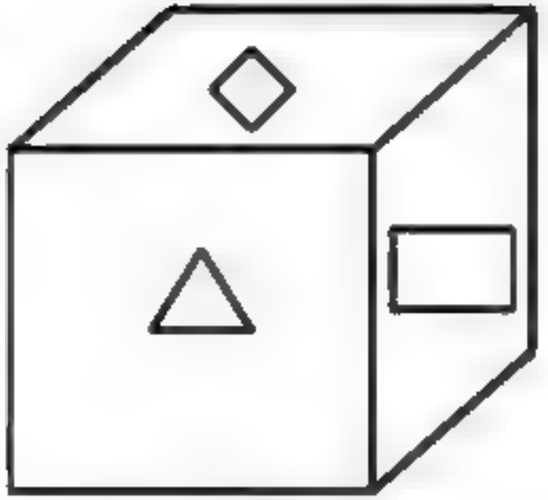

(c)

IGacademy Download App in PlayStore SUBSCRIBE IshwarGiri ಪಾಠಶಾಲೆ 8660070677

Q) In a given figure of open dice. Which dice we can make?
ತೆರೆದ ದಾಳಗಳ ನಿರ್ದಿಷ್ಟ ಚಿತ್ರದಲ್ಲಿ, ಯಾವುದು ನಾವು ಮಾಡಬಹುದಾದ ದಾಳ?

a) a **b)b** **c) c** **d) d**

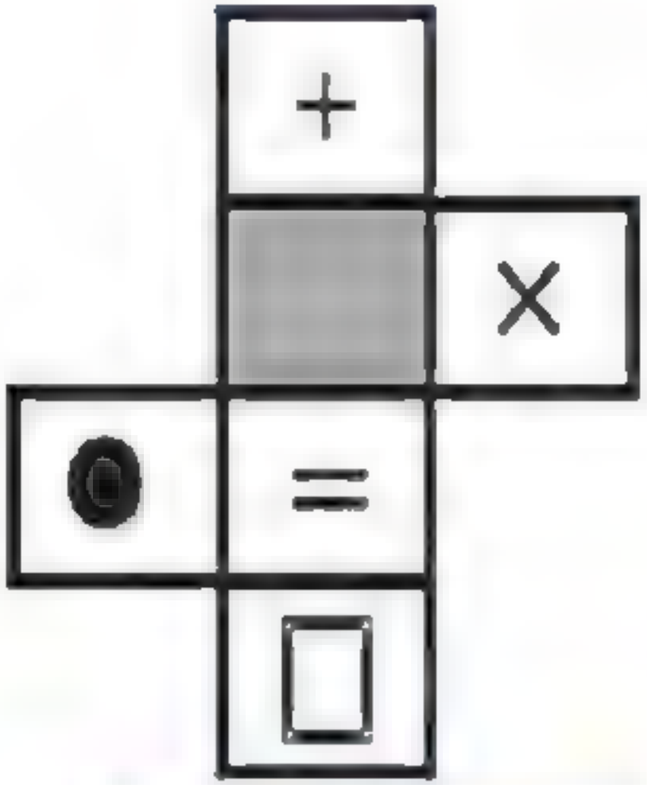

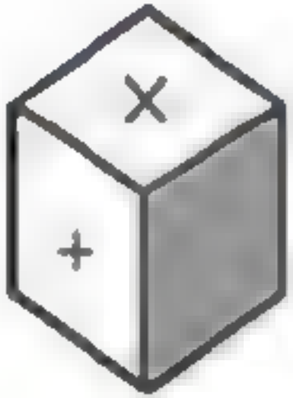

(a)

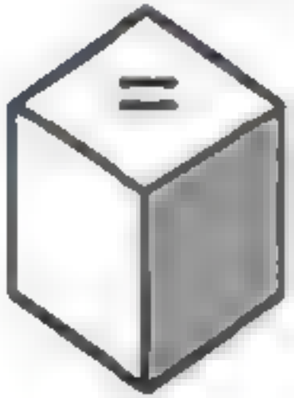

(b)

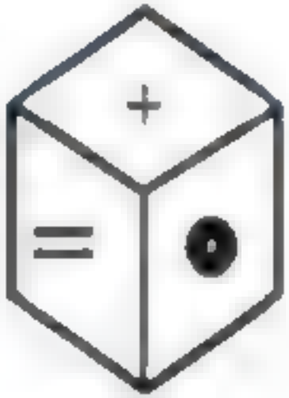

(c)

(d)

IGacademy Download App in PlayStore | SUBSCRIBE IshwarGiri ಪಾಠಶಾಲೆ | 8660070677

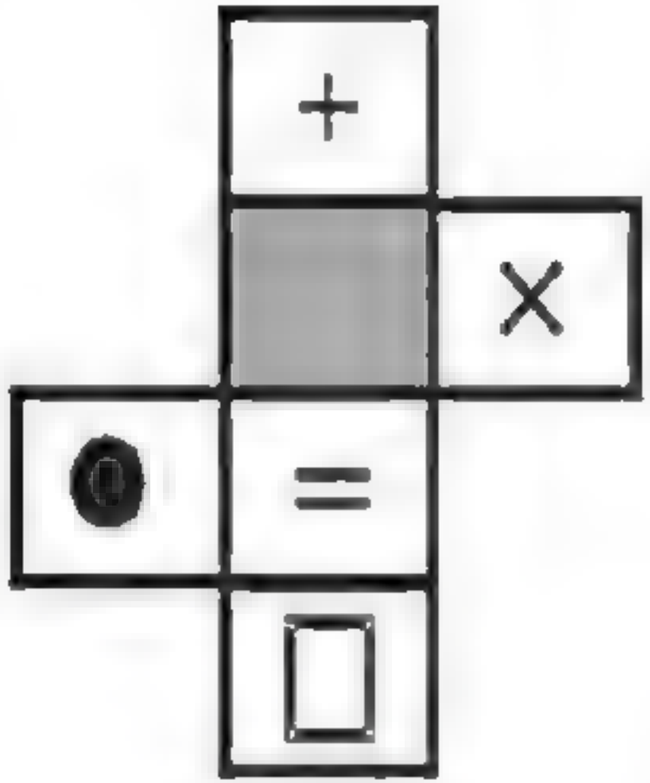

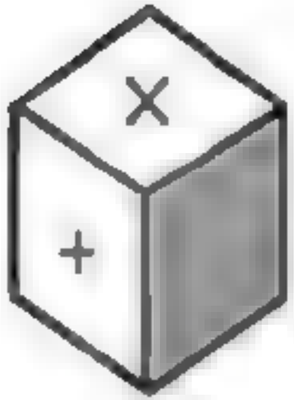

(a)

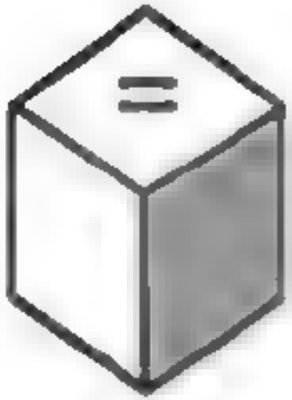

(b)

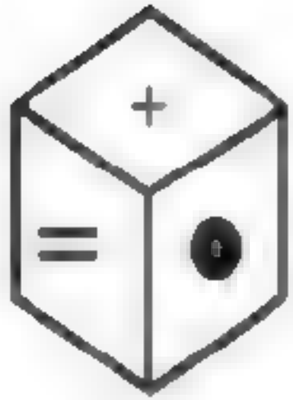

(c)

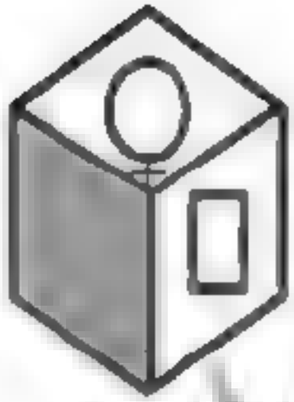

(d)

IGacademy Download App in PlayStore SUBSCRIBE IshwarGiri ಪಾಠಶಾಲೆ 8660070677

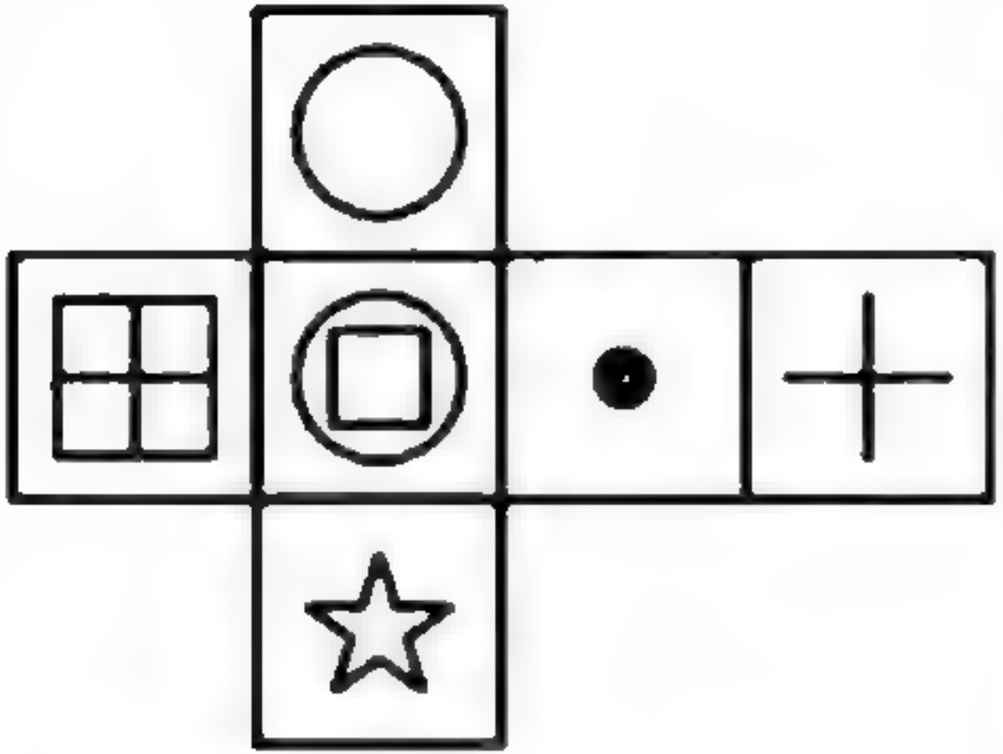

Q. Which of the following cube in the answer figure cannot be made based on the unfolded cube in the question figure?

ಪ್ರಶ್ನೆ ಚಿತ್ರದಲ್ಲಿ ತೆರೆದ ದಾಳವನ್ನು ಆಧರಿಸಿ ಉತ್ತರ ಚಿತ್ರದಲ್ಲಿ ಈ ಕೆಳಗಿನ ಯಾವ ದಾಳವನ್ನು ತಯಾರಿಸಲಾಗುವುದಿಲ್ಲ?

(a) C (b) D (c) A (d) B

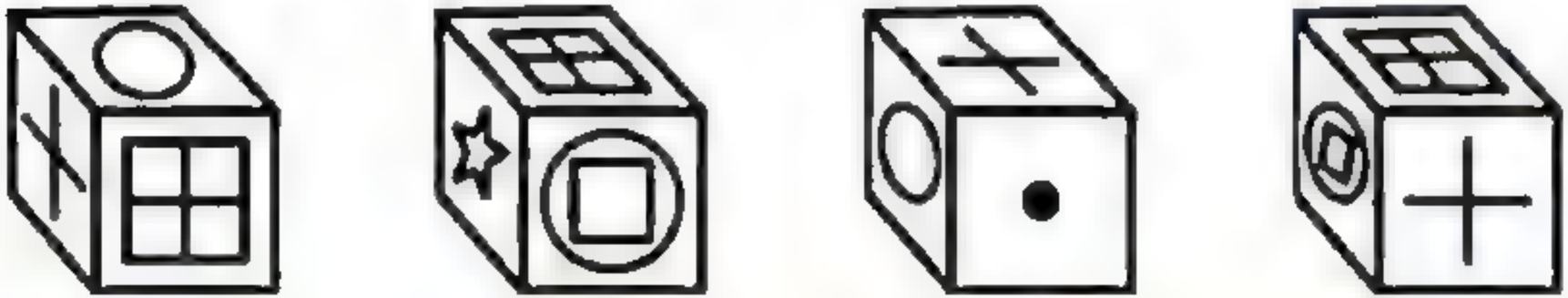

IGacademy Download App in PlayStore | SUBSCRIBE IshwarGiri ಪಾಠಶಾಲೆ | 8660070677

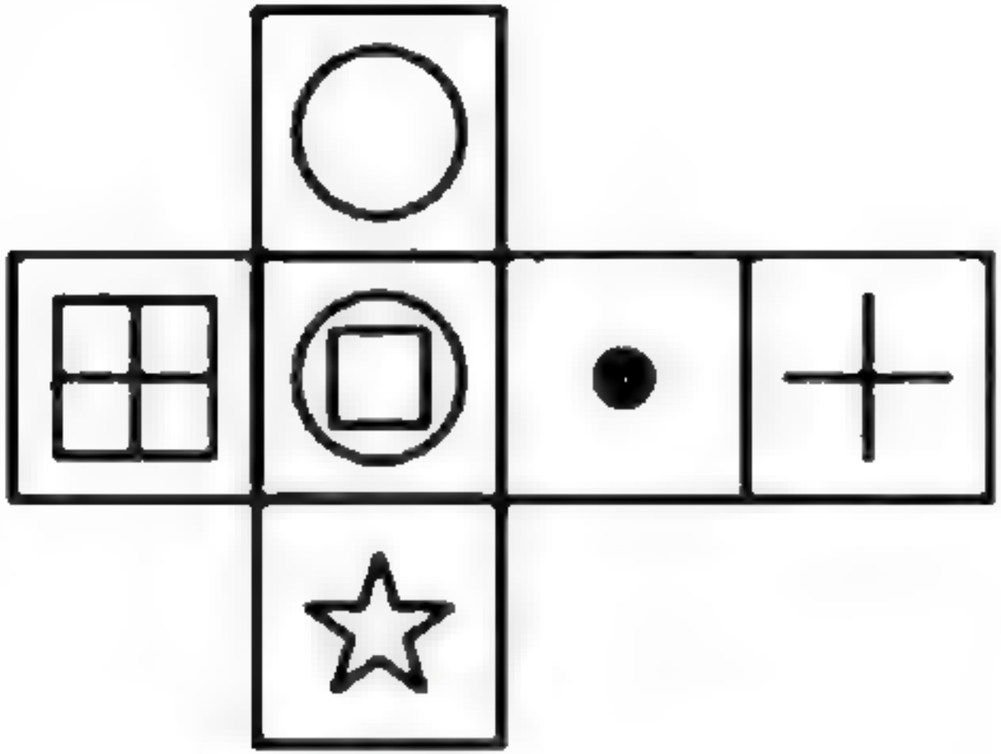

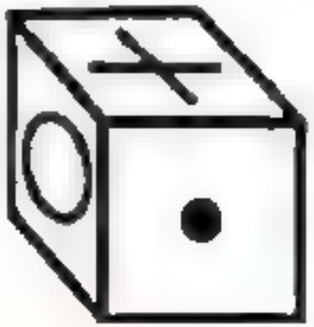

IGacademy Download App in PlayStore | SUBSCRIBE IshwarGiri ಪಾಠಶಾಲೆ | 8660070677

Q. Which of the following cube in the answer figure cannot be made based on the unfolded cube in the question figure?

ಪ್ರಶ್ನೆ ಚಿತ್ರದಲ್ಲಿ ತೆರೆದ ದಾಳವನ್ನು ಆಧರಿಸಿ ಉತ್ತರ ಚಿತ್ರದಲ್ಲಿ ಈ ಕೆಳಗಿನ ಯಾವ ದಾಳವನ್ನು ತಯಾರಿಸಲಾಗುವುದಿಲ್ಲ?

(a) C (b) D

(c) A (d) B

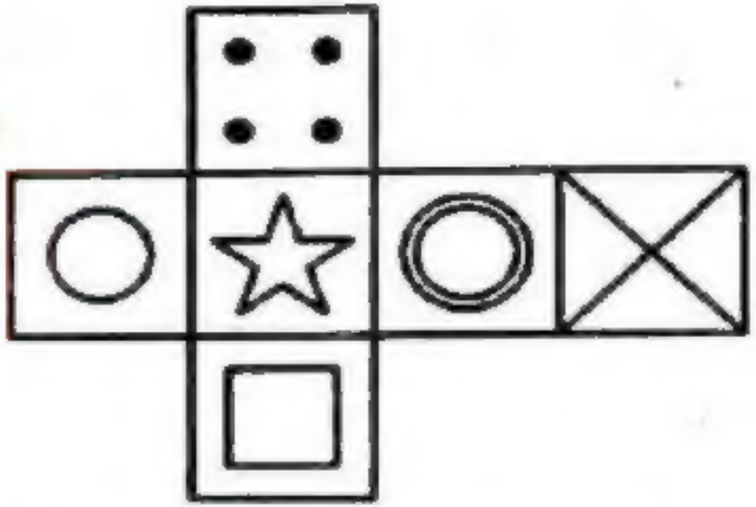

Answer figures



(A) (B) (C) (D)

IGacademy Download App in PlayStore | SUBSCRIBE IshwarGiri ಪಾಠಶಾಲೆ | 8660070677

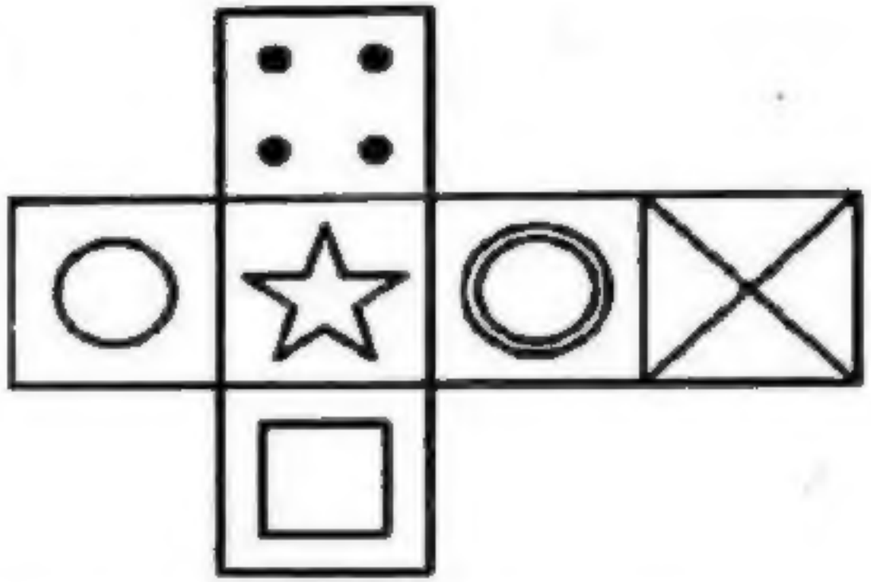

Answer figures



(A) (B) (C) (D)

IGacademy Download App in PlayStore | SUBSCRIBE IshwarGiri ಪಾಠಶಾಲೆ | 8660070677

Join Our Social Media Accounts

Ishwargirisir

ಕೆಳಗಿನ Photos ಮೇಲೆ ಕ್ಲಿಕ್ ಮಾಡಿ ನಮ್ಮ Social Media Accounts ಗಳನ್ನು Join ಆಗಬಹುದು

Click here to join our Telegram channel

IshwarGiri

Click here to join our Instagram Account

@Ishwargirisir

Click here to join our YouTube channel

IshwarGiri ಪಾಠಶಾಲೆ

Click here to join our Whatsapp Group

8660070677

IGacademy Download App in PlayStore | SUBSCRIBE IshwarGiri ಪಾಠಶಾಲೆ | 8660070677

thank
you